**A review of number lines, interval notation, and set notation**

This is a general review of these concepts. We will look at how to represent solutions for problems like:

$x > 5$ or $-3 \leq x < 4$ or $x > 2$ or $x < -3$

Use the example $x < 4$ to describe the 3 types of inequality notation. Write down any special symbols associated with it.

**<u>Number line:</u>**

The special signs/symbols are:

Graph $x < 4$ on a number line:

**<u>Interval Notation:</u>**

The special signs/symbols are:

Write $x < 4$ in interval notation:

**<u>Set Notation</u>**

The format of this is always:

Write $x < 4$ in set notation:



Copyright 2020, Jennifer Hill, DivideandConquerMath.com

**Examples** Write the following inequalities on a number line, in interval notation, and in set notation.

a. $x \geq 5$

b. $x < -2.5$

c. $-4 \leq x < 7$

d. $x > 4$ or $x < -5$



Copyright 2020, Jennifer Hill, DivideandConquerMath.com

**Examples** Write the following inequalities on a number line, in interval notation, and in set notation.

a. $x \leq -3$

b. $x > 12$

c. $0 < x \leq 8$

d. $x > 3$ or $x < 1$



Copyright 2020, Jennifer Hill, DivideandConquerMath.com

**Lesson: Exponents and the Order of Operations**

## Exponents

Label the parts of this exponent:

$$2^3$$

What does $2^3$ literally mean?

## Example 1

Evaluate the following exponents

a. $3^3$

b. $5^3$

c. $2^4$

We need to understand exponents so that we can fully understand the order of operations. The order of operations is one of the handiest concepts in arithmetic that is often confused.

## Order of Operations

Write down what the order of operations is:



Copyright 2020, Jennifer Hill, DivideandConquerMath.com

**Classic Example of the Order of Operations**

Evaluate: $10 \div 5 \times 6$

**Example 2**

Evaluate the following. This page and the next page are both blank so that you have plenty of space to work out your calculations by hand.

a. $3 + 2^3 - 6 \div 3 \times 7$

b. $2 + 3^2 + 4 \times 2 - 5 \times 2$

c. $3(1 + 2^2 - 3)^2$



Copyright 2020, Jennifer Hill, DivideandConquerMath.com

**Examples: The Order of Operations**

a. $10 - 3(1 + 2 \times 3) - 2^2 \times 4$

b. $3(1 + 2^2 - 3)^2 + 5(4 - 2 \times 3)$

c. $\frac{1}{2}(5 + 3) - 2^2(5 - 6)$



Copyright 2020, Jennifer Hill, DivideandConquerMath.com

**Lesson: Advanced Notes on Exponents**

## Multiplicative Property of Negative One

Explain what is the difference between $-5^2$ and $(-5)^2$ from the standpoint of the order of operations:

## Example 1

Evaluate the following.

a. $(-3)^2$

b. $(-3)^3$

c. $-3^2$

d. $-3^3$

e. $-7^2$

f. $(-2)^5$

## Example 2

What is the sign on the following problems? Do not worry about the final answer, you only need to circle if the final answer is positive or negative.

a. $(-4)^7$ Positive Negative

b. $(-58)^{12}$ Positive Negative

c. $-72^{57}$ Positive Negative

d. $(-13)^{72}$ Positive Negative

e. $-64^{14}$ Positive Negative

f. $(-23)^{91}$ Positive Negative



Copyright 2020, Jennifer Hill, DivideandConquerMath.com

There is one final rule we need to discuss.

**Zero Exponents**

For any real number a,

**Example 3**

Evaluate the following:

a. $5^0$

b. $x^0$

c. $35^0$

d. $-6^0$

e. $(-7)^0$

f. $3^0 + 7^0$

g. $-5^0 + 2^0$

h. $\left(-3 + \sqrt{52}\right)^0$



Copyright 2020, Jennifer Hill, DivideandConquerMath.com

**Lesson: Algebraic Expressions**

First we will define the terminology, which is already written out for you.

- **Constant:** any real number in an expression that is not attached to a variable
- **Variable:** a letter than can stand for any set of real numbers, and we can substitute values in for it if desired
- **Coefficient:** a number that is being multiplied by a variable
- **Term:** this is a single number, variable, or a number and a variable multiplied together, often separated by a plus + or minus – sign.
- **Factor:** a number or variable that is being multiplied with another number or variable
- **Algebraic Expression:** a mathematical string of constants and terms that can be added, subtracted, multiplied or divided together

This terminology will be used often, so it's important to understand what it means.

**Example 1**

Classify each part of the expressions

| Expression | Constants | Variables | Coefficients | Terms | Factors |
|---|---|---|---|---|---|
| a. $5x$ | | | | | |
| b. $2x + y$ | | | | | |
| c. $8$ | | | | | |
| d. $x$ | | | | | |
| e. $2x^2 - 4x + 7$ | | | | | |

Algebraic expressions are often used in everyday situations; we just don't realize it.

**Example 2**

You want to go to the movies, and on Tuesdays a theatre runs a deal so that all tickets cost $8. How much would it cost for each of the following situations?

a. A ticket for only you?

b. A ticket for you and 2 of your friends?

c. Tickets for 5 people, a giant tub of popcorn that costs $20.

d. Tickets for z people?



Copyright 2020, Jennifer Hill, DivideandConquerMath.com

In the last part of this example, we wrote an algebraic expression where z represented some quantity. Notice that if you input any of the previous number of tickets from examples a, b, and c into z, you would get the same answers.

To evaluate expression, you can simply plug in the desired values for a variable.

**Example 3**

Evaluate each expression for $x = -2$, $y = 4$, and $z = \frac{1}{3}$ as applicable:

a. $3x - 7y$

b. $6z - x^2 + 2y$

c. $x + z^2$



Copyright 2020, Jennifer Hill, DivideandConquerMath.com

**Lesson: The Commutative, Associative, and Distributive Properties**

Your math homework and English homework are due on the same day. Does it matter which one you do first?

This situation illustrates the idea of the Commutative Law**,** which we can now state below:

**Commutative Law**

Let $a$ and $b$ represent any two real numbers. Now we can define the following properties:

- The Commutative Law for Addition:

- The Commutative Law for Multiplication:

**<u>Example 1</u>**

Rewrite the following using the commutative law.

a. $3 + y$

b. $3c$

c. $\frac{2}{5}k$

d. $2 - z$



Copyright 2020, Jennifer Hill, DivideandConquerMath.com

You are buying chips, a drink, and a notebook. Does it matter what order the cashier rings up this items in?

These situations illustrate the idea of the **Associative Law**, which we can now state below:

Let $a$, $b$, and $c$ represent any three real numbers. Now we can define the following properties:

- The Associative Law for Addition:

- The Associative Law for Multiplication:

**<u>Example 2</u>**

Rewrite the following at least 2 different ways using the associative law.

a. $4xz$

b. $8 + 2 + 7 + 3$



Copyright 2020, Jennifer Hill, DivideandConquerMath.com

These rules are helpful when we are computing longer expressions.

**How to Simplify Calculations Using the Commutative and Associative Laws**

a. Suppose we want to calculate: $2 + 3 + 8 + 7$
   Using the commutative law, we more cleverly group these numbers together like this:
   $$2 + 8 + 3 + 7$$
   Usually we recognize 10s faster than some other quantities, so from here we can rearrange and group like this to find the final answer:

b. How can you rearrange $\left(\frac{1}{5} * \frac{1}{3}\right) \times (10 * 6)$ to make the calculations simpler to work with?

**The Distributive Law**

Let $a$, $b$, and $c$ represent any three real numbers. Then the following property holds:



Copyright 2020, Jennifer Hill, DivideandConquerMath.com

The distributive property effectively gives us permission to either add or multiply certain expressions in the order that simplifies the calculation.

**Example 3**

Use the distributive property as needed to simplify the following calculations.

a. $10\left(\frac{2}{5}-\frac{1}{2}\right)$

b. $\frac{2}{3}(6+9)$

c. $20\left(\frac{1}{4}+\frac{2}{5}\right)$

d. $\frac{2}{5}(14-4)$

The distributive law works in the opposite direction as well. If we start with $ab+ac$, according to the distributive law what would this equal?

Another name for this process is called **factoring.**

**Example 4**

Use the distributive law to factor the following:

a. $km+kn$

b. $5x+10y$



Copyright 2020, Jennifer Hill, DivideandConquerMath.com

There are a few other properties we need to mention:

**<u>The Additive Identity</u>**
For any number a, $0 + a = a + 0 = a$

**<u>The Multiplicative Identity</u>**
For any number a, $1 \times a = a \times 1 = a$

**<u>The Additive Inverse (aka the opposite of a number)</u>**
For any number a, the addition of its opposite will result in zero, ie: $a + (-a) = 0$.

**<u>The Multiplicative Inverse (aka the reciprocal)</u>**
For any number a, it's inverse can be written in the form $\frac{1}{a}$ and has the property: $a \times \frac{1}{a} = 1$

It is interesting to note that there exist number systems (not discussed in this class) where these properties do **not** exist!



Copyright 2020, Jennifer Hill, DivideandConquerMath.com

**Lesson: Like Terms and Combining Like Terms**

In algebra, we often want to simplify expressions if possible to make our lives easier. This is where the discussion of like terms comes into play.

**<u>Like Terms</u>**

Like terms are terms that share the exact same variables with the exact same exponents. Only like terms may be added.

Do like terms work in real life? Ie, can you come up with an example of like terms that could still be added in the real world?

Building off of your example, what wouldn't be like terms and could NOT be added in that scenario?

**<u>Example 1</u>**

In the following list below, classify which terms are like terms.

Discuss the two examples with the class to ensure they understand how to identify like terms. Students may color code, underline, or draw shapes around anything in the lists to indicate they are like terms.

a. $2x, 7y, 6x^2, 8y, x, -2x^2$

b. $3x^2y^2, 7x^2y, 2xy^2, 8x^2y, x^2y^2, -3x^2, 5xy^2$

The idea of like terms only comes up when we are talking about addition or subtraction. We do not worry about this when we want to multiply two things together. You may only add or subtract terms that are like terms.



Copyright 2020, Jennifer Hill, DivideandConquerMath.com

**Example 2**

Combine like terms. The next page is also left blank if you need more space.

a. $3x + 2y - 5x + 9y$

b. $4x^2 + 2x + 6y^2 + 2x^2 + 8x$

c. $\frac{1}{2}x + \frac{2}{3}y - \frac{3}{2}x - 2\frac{1}{3}y$

d. $3x^2y^3 + 7x^2y^2 - 2x^2y^3 + x^2y^2$

e. $\frac{1}{4}x + \frac{2}{5}y - \frac{1}{2} + \frac{1}{5}y$



Copyright 2020, Jennifer Hill, DivideandConquerMath.com

**Lesson: Translating English into Math**

As we move through this course, one major goal is to learn how to recognize and interpret certain situations as math problems. There are particular words in English that denote certain operations in mathematics, and we will classify those here.

| **Addition** | **Subtraction** | **Multiplication** | **Division** |
|---|---|---|---|
| | | | |

**Example 1**

Translate the following sentences into an algebraic expression. There is nothing to solve for you, you are merely setting up expressions.

a. 3 more than Lucy's height

b. Two less than a number

c. Three more than twice his salary.

d. Five less than three times a number.

e. Two-thirds of the cost.

f. Three more than twice his and her salary combined.



Copyright 2020, Jennifer Hill, DivideandConquerMath.com

**Rational Exponents**

**Video 1: How to work with rules like $x^{\frac{1}{n}}$ or $x^{\frac{m}{n}}$ or $x^{-\frac{m}{n}}$**

In this video, we will learn how to evaluate expressions that look like this:

$8^{\frac{1}{3}}$ or $25^{\frac{3}{2}}$

Define $x^{\frac{1}{n}}$ and show how to use this rule to evaluate $25^{\frac{1}{2}}$

**<u>Examples</u>** Evaluate the following:

a. $125^{\frac{1}{3}}$

b. $32^{\frac{1}{5}}$

c. $9^{\frac{1}{2}}$

d. $(-9)^{\frac{1}{2}}$

e. $-9^{\frac{1}{2}}$

f. $\left(\frac{27}{125}\right)^{\frac{1}{3}}$



Copyright 2020, Jennifer Hill, DivideandConquerMath.com

Define $x^{\frac{m}{n}}$ and show how to use this rule to evaluate $25^{\frac{3}{2}}$

**<u>Examples</u>** Evaluate the following:

a. $27^{\frac{2}{3}}$

b. $4^{\frac{3}{2}}$

c. $16^{\frac{5}{4}}$

d. $-8^{\frac{2}{3}}$

e. $(-8)^{\frac{2}{3}}$

f. $(-16)^{\frac{3}{4}}$

g. $-81^{\frac{3}{4}}$

h. $\left(\frac{125}{27}\right)^{\frac{2}{3}}$



Copyright 2020, Jennifer Hill, DivideandConquerMath.com

Define $x^{-\frac{m}{n}}$ and show how to use this rule to evaluate $25^{-\frac{3}{2}}$

**<u>Examples</u>** Evaluate the following:

a. $25^{-\frac{1}{2}}$

b. $27^{-\frac{1}{3}}$

c. $16^{-\frac{3}{4}}$

d. $4^{-\frac{5}{2}}$

e. $\left(\frac{25}{4}\right)^{-\frac{3}{2}}$

f. $(-25)^{-\frac{3}{2}}$

g. $(-27)^{-\frac{2}{3}}$

h. $-16^{-\frac{5}{4}}$



Copyright 2020, Jennifer Hill, DivideandConquerMath.com

**Lesson: Using Exponent Rules with Rational Exponents**

First, let's review the main exponent rules:

Next, let's do a quick review on operations with fractions. Complete the following operations:

a. $\frac{2}{3} \times \frac{5}{6}$

b. $\frac{2}{5} \times 10$

c. $\frac{2}{3} + \frac{2}{5}$



Copyright 2023, Jennifer Hill, DivideandConquerMath.com

Now we will combine all of these ideas into the following examples!

**<u>Examples</u>** Simplify the following. Your final answer should not include any negative exponents.

a. $x^{\frac{2}{3}} * x^{\frac{1}{5}}$

b. $\left(4x^{\frac{2}{3}}y^{6}\right)^{\frac{3}{2}}$

c. $\frac{x^{\frac{2}{3}}y^{-\frac{1}{5}}}{x^{\frac{1}{6}}y^{\frac{2}{5}}}$



Copyright 2023, Jennifer Hill, DivideandConquerMath.com

d. $\left(\frac{125x^4y^{-\frac{1}{3}}}{x^{-\frac{1}{2}}y^{\frac{2}{5}}}\right)^{-\frac{2}{3}}$

e. $\left(\frac{4x^6y^{-\frac{1}{3}}}{x^{-3}y^{\frac{1}{2}}}\right)^{-\frac{3}{2}}$



Copyright 2023, Jennifer Hill, DivideandConquerMath.com

**Lesson: Simplifying Radicals with Rational Exponents**

Convert the following radicals to rational exponents, simplify, and then rewrite in radical form.

a. $\sqrt{7^2}$

b. $\sqrt{9^2}$

c. $\sqrt[3]{x^{15}}$

d. $\sqrt[4]{x^2}$



Copyright 2023, Jennifer Hill, DivideandConquerMath.com

**Rational Exponents**
**Video 3: Convert a radical expression to exponential form**

**<u>Examples</u>** Convert the following expressions to exponential form, and then simplify if needed.

a. $\sqrt{7}$

b. $\sqrt[3]{8}$

c. $\sqrt{5^2}$

d. $\sqrt[3]{7^6}$

e. $\sqrt[4]{x^{16}}$

f. $\sqrt[6]{x^2}$



Copyright 2020, Jennifer Hill, DivideandConquerMath.com

**Lesson: Basic Exponent Rules – Product, Power, and Quotient Rules**

When working with rules of exponents, it is very important to be able to identify the base of each exponent. To begin, we will practice this.

**Example 1**

State the base for each exponent in the problems below.

| Expression | Exponent | Base for this Exponent |
|---|---|---|
| $5^3$ | | |
| $-5^4$ | | |
| $-5x^6$ | | |
| $3y^7$ | | |

**Product Rule**

First we want to remember what the actual definition of an exponent means.
We want to find: $2^3 * 2^2$. We will calculate this a few ways to understand the rules.

First we will work towards finding the exact answer. Evaluate each exponent below as you normally would with the **order of operations**, and then multiply the numbers together:

Now we will re-examine this result solely from the viewpoint of exponents. Write out each exponent as a multiplication problem, and notice the results you get from this exercise.

What do you notice about the exponents?

**Product Rule (formal mathematical definition)**

Let x be a real number, and let a and b be integers. Then:



Copyright 2020, Jennifer Hill, DivideandConquerMath.com

**Example 2**

Use the product rule to evaluate the following.

a. $x^2 * x^4$

c. $x^3 + x^7$

b. $3x^3 * -1x^4 * 2x$

d. $\frac{2}{3}x^4y^2z^5 * 6x^3y^2 * \frac{1}{2}y^3z^4$

**Power Rule**

Using the order of operations, first rewrite the expression inside the parentheses without exponents:

$(2^3)^2$ =

Now rewrite this entire result just utilizing what we know about the definition of exponents:

What is the relationship between the exponents in this case?

**The Power Rule (formal mathematical definition)**

Let x be a real number, and let a and b be integers. Then:



Copyright 2020, Jennifer Hill, DivideandConquerMath.com

**Example 3**

Use the power rule to evaluate the following:

a. $(x^3)^5$

b. $(x^2y^7z)^4$

c. $(3x^4y^5)^3$

d. $\left(\frac{2}{3}x^5y^2\right)^3$

Is there a difference between $(x+y)^n$ and $(xy)^n$? Explain.

**The Quotient Rule**

Using the order of operations, first rewrite the expression inside the parentheses without exponents:

$$\frac{2^5}{2^3}$$

First we will evaluate and find the final answer by using the order of operations below.

Notice the final answer of this question. How can we rewrite this number in its exponent form?

What relationship do you see between the exponents in the original question and the final answer?

**The Quotient Rule (formal mathematical definition)**

Let x be a real number, and let a and b be integers. Then:



Copyright 2020, Jennifer Hill, DivideandConquerMath.com

**Example 4**

Use the quotient rule to simplify the following:

a. $\frac{x^7}{x^3}$

b. $\frac{x^5y^8z^{10}}{xyz}$

c. $\frac{15x^4y^3z^{10}}{2x^2y^2z^5}$

d. $\frac{12x^7y^3}{8x^3z^4}$



Copyright 2020, Jennifer Hill, DivideandConquerMath.com

**Examples: Exponent Rules, Basic Examples**

Simplify the following using only the product, power, and quotient rules. Your final answer should not contain negative exponents.

a. $x^2y^7 * 5x^3y^5z$

b. $(4x^7y^3)^2$

c. $\frac{15x^7y^3}{10x^2y}$

d. $\frac{2}{5}x^2y^5 * \frac{1}{3}x^7yz^3$

e. $\left(\frac{5}{3}x^3y^2z^3\right)^3$

f. $(-3x^5)^2$

g. $(-3x^5)^3$

h. $(2x^4y^2z^6)^2 * 3x^2z^3$

i. $\frac{(x^3y^7)^2}{x^4y}$

j. $\frac{(x^4y^2)^3}{(x^2y)^2}$



Copyright 2020, Jennifer Hill, DivideandConquerMath.com

**Examples: Exponent Rules, With Numbers Only**

Simplify the following using only the product, power, and quotient rules. Your final answer should be a number.

a. $3^2 * 3$

b. $(-4)^2 * 2$

c. $\frac{2^7}{2^4}$

d. $\left(\frac{2}{3}\right)^3 * 3^2$

e. $\frac{6^2}{2^3}$

f. $\left(\frac{1}{2}\right)^4 * 2^2$



Copyright 2020, Jennifer Hill, DivideandConquerMath.com

**Examples: Exponent Rules, Trickier and Harder Examples**

Simplify the following using only the product, power, and quotient rules. Your final answer should not include negative exponents.

a. $(3x^2y^4)^2 * (x^4y^5)^3$

b. $\frac{(2x^5y^2)^3}{(x^2yz^5)^2}$

c. $\left(\frac{2}{3}x^5y^7z^3\right)^2 * 9x^3y^3$

d. $\left(\frac{3}{5}x^5y^2z^7\right)^2 * \frac{xy^3}{z^5}$

e. $\frac{(3x^5y^2z^4)^3}{(6x^2yz^3)^2}$

f. $\frac{(4x^3y^2z^5)^2}{(2xz^2)^4}$



Copyright 2020, Jennifer Hill, DivideandConquerMath.com

**Lesson: Negative Exponents**

Simplify: $\frac{25}{125}$

If we wrote these numbers as exponents, this calculation would look like this:

$$\frac{5^2}{5^3} = \frac{1}{5}$$

Consider what would happen if we used the quotient rule on this problem:

$$\frac{5^2}{5^3} = 5^{2-3} - 5^{-1} = \frac{1}{5}$$

This problem shows us that exponents can also be negative.

**<u>Three Rules for Negative Exponents</u>**

Let x and y be a real numbers, and let n be an integer. Then:

$$x^{-n} = \frac{1}{x^n}$$

$$\frac{1}{x^{-n}} = x^n$$

$$\left(\frac{x}{y}\right)^{-n} = \left(\frac{y}{x}\right)^n = \frac{y^n}{x^n}$$

In general your final answer cannot have a negative exponent, so it is essential that you understand what to do with it.



Copyright 2020, Jennifer Hill, DivideandConquerMath.com

**Example 1**

Rewrite the following expressions without negative exponents.

a. $4^{-2}$

b. $\frac{1}{3^{-3}}$

c. $\left(\frac{2}{5}\right)^{-2}$

d. $\left(\frac{1}{3}\right)^{-2}$

One of the biggest challenges with negative exponents is identifying how to apply them to the proper base. As a quick review, remember how we identified the bases in the last section:

**Example 2**

Identify the base of the following exponents:

| Expression | First Base | First Exponent | Second Base | Second Exponent |
|---|---|---|---|---|
| $3^5$ | | | | |
| $-2x^5$ | | | | |
| $5x^3y^7$ | | | | |

This is extremely important to remember when working with negative exponents. In general, our final answer can't have negative exponents so you need to be used to reformatting your answers properly if negative exponents come up.

**Example 3**

Simplify the following expressions, and write your final answer without negative exponents.

a. $\frac{a^3b^{-2}}{c^{-4}d^6}$

b. $\frac{3a^{-3}b^4c^{-5}}{d^2e^{-2}f^5}$

c. $\frac{a^5b^3c^4}{4d^{-2}e^{-4}f^{-2}}$

d. $\frac{a^{-3}b^{-2}c^{-6}}{d^4e^7f}$



Copyright 2020, Jennifer Hill, DivideandConquerMath.com

With this in mind, we should now be able to work on combining all of the rules of exponents we've learned.

**Example 4**

Simplify the following. Your final answer cannot contain negative exponents.

a. $(3x^{-2}y^{4})^{3}$

b. $\left(\frac{2x^{-4}y^{6}}{x^{5}y^{-3}}\right)^{4}$

c. $(-2x^{3}y^{-2}z)^{-3}$

d. $\left(\frac{2x^{3}y^{-4}}{3x^{-2}y^{-5}}\right)^{-3}$



Copyright 2020, Jennifer Hill, DivideandConquerMath.com

**Examples: Negative Exponents, Basic Examples**

Your final answer should not contain negative exponents.

a. $\left(\frac{4}{5}\right)^{-2}$

b. $3x^{-6}y^{4}z^{-2}$

c. $\frac{4x^{-4}y^{7}}{z^{-5}}$

d. $\frac{6x^{3}y^{-5}}{x^{7}y^{2}}$

e. $\frac{14x^{-3}y^{5}z^{3}}{21x^{-2}y^{-3}z^{9}}$

f. $(3x^{-4}y^{-2}z^{4})^{2}$

g. $\left(\frac{5x^{2}y^{-4}}{z^{2}}\right)^{5}$

h. $(x^{-3}y^{2}z^{-4})^{-3}$



Copyright 2020, Jennifer Hill, DivideandConquerMath.com

**Examples: Negative Exponents, Tricky Examples**

Your final answer should not contain negative exponents.

a. $(3x^{-4}y^{5}z^{-2})^{-3}$

b. $(-5x^{2}y^{-3}z^{4})^{-2}$

c. $\left(\frac{4x^{-5}y^{2}}{x^{-3}y^{-5}}\right)^{-2}$

d. $\left(\frac{3x^{3}y^{-3}z^{4}}{2x^{-2}y^{4}z^{-2}}\right)^{-3}$

e. $\frac{(2x^{-4}y^{5})^{4}}{x^{-3}y^{7}}$

f. $\frac{(3x^{-3}y^{2}z^{-3})^{-3}}{(2x^{4}y^{-5}z^{3})^{-4}}$



Copyright 2020, Jennifer Hill, DivideandConquerMath.com

**Examples: Negative Exponents versus Negative Numbers**

**<u>Examples</u>** Simplify:

a. $6^{-2}$

b. $-6^2$

c. $(-6)^2$

d. $(-6)^{-2}$

**<u>Examples</u>** Simplify:

a. $5x^{-2}$

b. $(5x)^{-2}$

c. $-5x^2$

d. $(-5x)^{-2}$



Copyright 2021, Jennifer Hill, DivideandConquerMath.com

**Examples** Simplify

a. $-7^2$

b. $(-7)^{-2}$

c. $7^{-2}$

d. $-7^{-2}$

**Examples** Simplify

a. $3x^{-2}$

b. $(-3x)^{-2}$

c. $(-3x)^{-3}$



Copyright 2021, Jennifer Hill, DivideandConquerMath.com

**Lesson: Scientific Notation**

**Scientific Notation**

A number in scientific notation is of the form: $A \times 10^n$ where $1 \leq |A| < 10$ and n is an integer

Before we can write numbers in this form, it is best if we can identify examples that are or are not in this format.

**Example 1**

Identify if the following examples are in scientific notation. If not, circle and explain why.

a. $5.34 \times 10^7$ Yes, it's in scientific notation No, it's not in scientific notation

b. $-2.7832 \times 10^{\frac{1}{2}}$ Yes, it's in scientific notation No, it's not in scientific notation

c. $-4.5382 \times 10^{-8}$ Yes, it's in scientific notation No, it's not in scientific notation

d. $0.8 \times 10^{23}$ Yes, it's in scientific notation No, it's not in scientific notation

We will now examine how to rewrite the following example in scientific notation.

**Example 1**

Rewrite the following in scientific notation.

**Example 2**

Rewrite the following examples in their expanded form.



Copyright 2020, Jennifer Hill, DivideandConquerMath.com

**Example 3**

Use the rules of exponents to multiply the following results together.

a. $(2 \times 10^{6}) \times (3 \times 10^{8})$

b. $(2 \times 10^{17}) \times (2.1 \times 10^{23})$

c. $(8 \times 10^{7}) \times (2 \times 10^{-3})$

**Example 4**

Use the rules of exponents to divide the following results.

a. $\frac{8 \times 10^{12}}{4 \times 10^{3}}$

b. $\frac{6 \times 10^{7}}{2 \times 10^{19}}$

c. $\frac{3 \times 10^{-12}}{6 \times 10^{-5}}$



Copyright 2020, Jennifer Hill, DivideandConquerMath.com

**Example 5**

Add the following:

a. $(5 \times 10^{78}) + (2 \times 10^{78})$

b. $(8 \times 10^{6}) + (2 \times 10^{6})$

c. $(3 \times 10^{4}) + (2 \times 10^{3})$



Copyright 2020, Jennifer Hill, DivideandConquerMath.com

**The Basics of Roots**
**Video 1: Square Roots**

What are the square roots of 9? Write down what it means to be a square root.

**<u>Examples</u>** Find the square roots of the following numbers.

a.

b.

What does the symbol $\sqrt{\phantom{x}}$ refer to?

How can we refer to the negative square root?

Draw a square root and label its parts:



Copyright 2020, Jennifer Hill, DivideandConquerMath.com

**Examples** Evaluate the following:

a. $\sqrt{25}$

b. $\sqrt{81}$

c. $\sqrt{36}$

d. $\sqrt{\frac{1}{36}}$

e. $\sqrt{\frac{16}{49}}$

f. $\sqrt{\frac{9}{25}}$

g. $\sqrt{-36}$

h. $-\sqrt{64}$

Finally, how would you estimate a root like $\sqrt{5}$?

**Example** Estimate $\sqrt{14}$



Copyright 2020, Jennifer Hill, DivideandConquerMath.com

**The Basics of Roots**
**Video 2: Higher Roots**

How would you evaluate the following? Explain the rationale for how to evaluate these:

$\sqrt[3]{8}$

$\sqrt[4]{81}$

$\sqrt[5]{32}$

The most general symbol for a root is $\sqrt[n]{a}$. Explain what this symbol means and once again, label it.



Copyright 2020, Jennifer Hill, DivideandConquerMath.com

Now we can create a list of the most likely roots that we will encounter. You will very likely want to create another list of this on a page you can easily access.

| **Squares** | **Cubes** | **Other** |
| --- | --- | --- |



Copyright 2020, Jennifer Hill, DivideandConquerMath.com

**Examples** Evaluate the following. Be careful when you evaluate.

a. $\sqrt[3]{125}$

b. $\sqrt[3]{-125}$

c. $\sqrt[4]{16}$

d. $\sqrt[4]{-16}$

d. $-\sqrt[3]{8}$

e. $-\sqrt[3]{-8}$

f. $\sqrt[5]{-32}$

g. $\sqrt[6]{-64}$

Now let's generalize. For all roots of the form $\sqrt[n]{a}$, what can we say if….

1. The index (n) is an **odd** number?

2. The index (n) is an **even** number and a is a **negative** number?

3. The index (n) is an **even** number and a is a **positive** number?



Copyright 2020, Jennifer Hill, DivideandConquerMath.com

**The Basics of Roots**
**Video 3: The "Ultimate" Test and A Few Other Notes**

To begin, we will first see how well we can put everything we've learned so far about roots together.

**<u>Examples</u>** Evaluate the following, if possible.

a. $\sqrt[3]{-8}$

b. $\sqrt{-16}$

c. $-\sqrt[4]{16}$

d. $\sqrt[3]{-125}$

e. $-\sqrt{100}$

f. $\sqrt[4]{-81}$

g. $-\sqrt{25}$

h. $-\sqrt[3]{-8}$

i. $-\sqrt[4]{-16}$

j. $-\sqrt[5]{-32}$

And now that you have completed this … it's time for my "ultimate" test … drum roll please:



Copyright 2020, Jennifer Hill, DivideandConquerMath.com

**The "Ultimate" Test for Roots**

Evaluate. Note: at this moment in time, we do not know anything about imaginary numbers.

a. $\sqrt{1}$

b. $\sqrt[3]{1}$

c. $\sqrt[5]{1}$

d. $\sqrt[4]{-1}$

e. $\sqrt[3]{-1}$

f. $-\sqrt{1}$

g. $-\sqrt[4]{-1}$

h. $-\sqrt[3]{1}$

i. $-\sqrt{-1}$

j. $-\sqrt[7]{-1}$

k. $-\sqrt[3]{-1}$

l. $\sqrt[8]{-1}$

m. $-\sqrt[10]{-1}$

n. $\sqrt{-1}$

**Are you having fun yet???**



Copyright 2020, Jennifer Hill, DivideandConquerMath.com

We have one last thing to discuss: the general rule for evaluating $\sqrt[n]{a^n}$

If n is even ….

If n is odd ….

**<u>Examples</u>** Evaluate the following:

a. $\sqrt[3]{y^3}$

b. $\sqrt[4]{(x-4)^4}$

c. $\sqrt[7]{(2y-4)^7}$

d. $\sqrt[6]{(3x+2)^6}$



Copyright 2020, Jennifer Hill, DivideandConquerMath.com

**Simplifying Radicals**
**The Basics**

We will look at how to simplify radicals like this:

$$\sqrt{50} = 5\sqrt{2} \quad \text{or} \quad \sqrt[3]{250} = 5\sqrt[3]{3}$$

You might want to have the list of squares / cubes / quartics ready for this exercise. If you don't, pause the video and write them all down on a separate sheet of paper so that you can have it handy for this entire lesson.

First we look at **the multiplication property of radicals:**

**<u>Examples</u>** Multiply the following:

a. $\sqrt[3]{2} * \sqrt[3]{3}$

b. $\sqrt{7} * \sqrt{5}$

c. $\sqrt[3]{3} * \sqrt[3]{9}$

d. $\sqrt[3]{6} * \sqrt[3]{9}$

How are examples c and d related?



Copyright 2020, Jennifer Hill, DivideandConquerMath.com

Being able to multiply radicals together is powerful, because it also allows us to break apart radicals and simplify them. Using the example $\sqrt{12}$, write down how to simplify:

**<u>Examples</u>** Simplify the following:

a. $\sqrt{50}$

b. $\sqrt{20}$

c. $\sqrt[3]{54}$

d. $\sqrt[4]{32}$

e. $\sqrt[3]{24}$



Copyright 2020, Jennifer Hill, DivideandConquerMath.com

At this point, we should probably define when a radical is actually simplified.

**A simplified radical will ……**

**<u>Examples</u>** Explain why the following radicals are not simplified:

a. $\sqrt{24}$

b. $\frac{5}{\sqrt{7}}$

c. $\sqrt[4]{\frac{3}{5}}$

d. $\sqrt[3]{8x^8y^2}$



Copyright 2020, Jennifer Hill, DivideandConquerMath.com

**Examples** Simplify the following:

a. $\sqrt{24}$

b. $\sqrt[3]{32}$

c. $\sqrt[4]{64}$

d. $\sqrt[5]{64}$

e. $\sqrt{250}$

f. $\sqrt[3]{250}$



Copyright 2020, Jennifer Hill, DivideandConquerMath.com

**Lesson: Simplifying Radicals with Variables**

We are going to rely on a skill we've already learned to help with simplifying radicals.

**<u>Examples</u>** Show you can simplify the following utilizing rational exponents.

a. $\sqrt{x^6}$

b. $\sqrt[3]{x^{15}}$

c. $\sqrt{x^6y^8}$

d. $\sqrt[4]{x^{12}y^{20}}$

How can we simplify $\sqrt{x^5}$? Watch the 2 explanations in the video and summarize the explanation that makes more sense to you.



Copyright 2023, Jennifer Hill, DivideandConquerMath.com

**Example** Simplify the following.

a. $\sqrt[3]{x^{13}}$

b. $\sqrt[4]{x^{22}}$

c. $\sqrt{12x^6y^7}$

d. $\sqrt[3]{250x^8y^{16}}$

e. $\sqrt[4]{\frac{32x^7}{y^8}}$



Copyright 2023, Jennifer Hill, DivideandConquerMath.com

**Lesson: Multiplying Radicals**

Write a one-sentence explanation of how to multiply $\sqrt[3]{3} * \sqrt[3]{4}$

**<u>Examples</u>** Multiply the following. Simplify if possible.

a. $\sqrt[3]{6} * \sqrt[3]{4}$

b. $\sqrt[4]{4x^3} * \sqrt[4]{12x^2}$

c. $\sqrt{5x} * \sqrt{10xy}$



Copyright 2023, Jennifer Hill, DivideandConquerMath.com

**Simplifying Radicals**
**Multiplying and Dividing Radicals with Different Indices**

We will look at how to perform operations like:

$$\sqrt{x} * \sqrt[3]{x} \qquad \text{or} \qquad \frac{\sqrt[4]{x}}{\sqrt[3]{x}}$$

Before we begin, you should be comfortable with doing problems like this:

$8^{\frac{1}{3}}$

$25^{\frac{3}{2}}$

Write down the approach for performing this operation: $\sqrt{x} * \sqrt[3]{x}$

**<u>Examples</u>** Perform the following operations:

a. $\sqrt[3]{x} * \sqrt[4]{x}$

b. $\frac{\sqrt[5]{x^2}}{\sqrt[3]{x}}$



Copyright 2020, Jennifer Hill, DivideandConquerMath.com

**<u>Examples</u>** Perform the following operations:

a. $\sqrt[4]{x^3} * \sqrt[5]{x^3}$

b. $\frac{\sqrt{x}}{\sqrt[3]{x^2}}$

c. $\sqrt[3]{x^2} * \sqrt{x}$



Copyright 2020, Jennifer Hill, DivideandConquerMath.com

**Adding and Subtracting Radicals**

In this video we will look at how to perform operations like:

$$\sqrt{3} + \sqrt[3]{5} - 5\sqrt{3} + 7\sqrt[3]{3} \qquad \text{or} \qquad \sqrt{24x^4y^3} - 3x^2y\sqrt{6y}$$

Before you begin, you should already be able to simplify radicals like this:

a. $\sqrt{24x^6y^9}$

b. $\sqrt[4]{16x^7y^{11}}$

What are like terms?

Add the like terms in this problem: $3x + 7y - 9x + 7y^2 - 2x - 2y$

What are like radicals?

Add the like radicals in this problem: $5\sqrt{3} - 2\sqrt[3]{3} + 8\sqrt[3]{3} - 2\sqrt{5} + 8\sqrt{3}$



Copyright 2020, Jennifer Hill, DivideandConquerMath.com

**Examples** Perform the following operations:

a. $4\sqrt{7} - 5\sqrt[3]{3} + 2\sqrt{3} - 3\sqrt[3]{7} - 9\sqrt{3} + \sqrt[3]{3}$

b. $2x\sqrt{7} - 3\sqrt{7} + 8x\sqrt{7} - 2\sqrt{7}$

c. $3x\sqrt[3]{5} + 2x\sqrt[3]{4} - 3\sqrt[3]{4} + 5x\sqrt[3]{4} - 7x\sqrt[3]{5} + 5\sqrt[3]{4}$

It is possible that you might have to simplify a radical before you can add it. Note how this works with the example:

$$\sqrt{24} + 2\sqrt{54}$$

**Examples** Perform the following operations:

a. $5\sqrt{8} - \sqrt{18}$

b. $4\sqrt[3]{54} - 7\sqrt[3]{16}$



Copyright 2020, Jennifer Hill, DivideandConquerMath.com

**Examples** Perform the following operations:

a. $\sqrt{8x^2y^4} - 9xy^2\sqrt{2}$

b. $4x\sqrt[3]{16x^6y^7} + 9x^3y\sqrt[3]{250y^4}$

c. $5x^2y^3\sqrt[4]{32x^7z^{10}} - 2x^3z^2\sqrt[4]{2x^3y^{12}z^2}$

d. $3x\sqrt[3]{24x^5y^7} + 3xy\sqrt[3]{3x^2y} + y^2\sqrt[3]{375x^8y}$



Copyright 2020, Jennifer Hill, DivideandConquerMath.com

**Lesson: Multiplying Radicals Expressions**

First, let's review how to multiply radicals in general. Show how to multiply:

a. $\sqrt[3]{4x^2y} * \sqrt[3]{6x^2y}$

b. $\sqrt{6xy} * \sqrt{10y}$

Now we will apply that logic to larger rational expressions.

Write a one-sentence explanation of how to multiply: $\sqrt{2}\left(\sqrt{3} + \sqrt{10}\right)$, then multiply.

**<u>Example</u>** Multiply $2\sqrt[3]{3}\left(\sqrt[3]{9} + 5\sqrt[3]{6}\right)$



Copyright 2023, Jennifer Hill, DivideandConquerMath.com

**Example** Multiply $3x\sqrt{5}\left(\sqrt{10x} - 5x\sqrt{2}\right)$

Write out an explanation of how to multiply: $\left(\sqrt{3} - \sqrt{2}\right)\left(\sqrt{6} + \sqrt{3}\right)$

**Example** Multiply: $\left(3\sqrt{5} - \sqrt{2}\right)\left(\sqrt{10} + 4\sqrt{2}\right)$



Copyright 2023, Jennifer Hill, DivideandConquerMath.com

**<u>Example</u>** Multiply: $\left(3\sqrt[3]{4}-\sqrt[3]{6}\right)\left(5\sqrt[3]{2}+\sqrt[3]{6}\right)$

How do you multiply $\left(\sqrt{2}+\sqrt{3}\right)^2$

**<u>Examples</u>** Multiply: $\left(\sqrt[3]{9}+\sqrt[3]{6}\right)^2$



Copyright 2023, Jennifer Hill, DivideandConquerMath.com

**Lesson: Rationalizing a Denominator with One Square Root**

What does it mean to rationalize the denominator?

How would you rationalize $\frac{2}{\sqrt{3}}$ ? Explain *why* we can do this.

Can every fraction with a radical in the denominator be rationalized like this? Circle: Yes No

What types of problems can be rationalized this way?



Copyright 2023, Jennifer Hill, DivideandConquerMath.com

**Examples** Rationalize the following.

a. $\frac{20}{\sqrt{8}}$

b. $\sqrt{\frac{40}{60}}$

c. $\sqrt{\frac{81x^7}{2y}}$

d. $\frac{\sqrt{22}}{\sqrt{x^9}}$



Copyright 2023, Jennifer Hill, DivideandConquerMath.com

**Dividing Radicals/Rationalizing the Denominator**
**Part 2: Higher Roots**

In this video we will look at how to simplify expressions like:

$$\frac{5}{\sqrt[3]{3}} \quad \text{or} \quad \frac{\sqrt[4]{2}}{\sqrt[4]{9}}$$

Before you begin, you should already be able to simplify problems like this:

a. $\frac{5}{\sqrt{3}}$

b. $\frac{\sqrt{6}}{\sqrt{18}}$

First, let's observe why higher roots are a different situation. Write down what happens if we use the same methods as above to rationalize the following: $\frac{5}{\sqrt[3]{3}}$

We have to pivot our thinking to "count powers". Note how this works with this examples: $\sqrt[3]{3} * ___ = 3$



Copyright 2020, Jennifer Hill, DivideandConquerMath.com

**Examples** Determine what to fill in the blank to create a true statement:

a. $\sqrt[3]{25} * ? = 5$

b. $\sqrt[4]{2} * ? = 2$

c. $\sqrt[4]{27} * ? = 3$

d. $\sqrt[5]{4} * ? = 2$

e. $\sqrt[3]{7} * ? = 7$

f. $\sqrt[4]{25} * ? = 5$

g. $\sqrt[5]{3} * ? = 3$

h. $\sqrt[3]{36} * ? = 6$

Now you should have a sense of what number you want this to equal. This is a very strange exercise, but using the pattern above, determine what to multiply by to get to the desired root:

a. $\sqrt[3]{4} * ? =$

b. $\sqrt[4]{5} * ? =$

c. $\sqrt[5]{9} * ? =$

d. $\sqrt[4]{36} * ? =$



Copyright 2020, Jennifer Hill, DivideandConquerMath.com

Now we should have a decent sense of how to rationalize and what the answer should equal. Explain how to rationalize the following:

a. $\frac{5}{\sqrt[3]{2}}$

b. $\frac{7}{\sqrt[4]{5}}$

**<u>Examples</u>** Rationalize the following denominators:

a. $\frac{6}{\sqrt[3]{5}}$

b. $\frac{2}{\sqrt[4]{9}}$

c. $\frac{2}{\sqrt[5]{125}}$

d. $\frac{7}{\sqrt[4]{8}}$



Copyright 2020, Jennifer Hill, DivideandConquerMath.com

**Examples** Rationalize the following denominators:

a. $\frac{\sqrt[3]{5}}{\sqrt[3]{4}}$

b. $\frac{2\sqrt[3]{3}}{\sqrt[3]{4}}$

c. $\frac{5\sqrt[4]{2}}{\sqrt[4]{27}}$

d. $\frac{6\sqrt[3]{5}}{\sqrt[3]{3}}$

e. $\frac{3}{\sqrt[5]{x^3}}$

f. $\frac{\sqrt[5]{25}}{\sqrt[5]{16}}$



Copyright 2020, Jennifer Hill, DivideandConquerMath.com

**Lesson: Rationalizing a Denominator with Two Square Roots**

How do you find the conjugate of $4 + \sqrt{2}$? Write one sentence to explain what you need to do.

**<u>Examples</u>** What is the conjugate of the following?

a. $3 - \sqrt{5}$

b. $-4 - \sqrt{2}$

Show how to rationalize: $\frac{5}{\sqrt{2}-\sqrt{3}}$



Copyright 2023, Jennifer Hill, DivideandConquerMath.com

**Examples** Rationalize the following.

a. $\frac{\sqrt{2}}{\sqrt{3}-\sqrt{6}}$

b. $\frac{\sqrt{2}-\sqrt{3}}{\sqrt{3}+\sqrt{5}}$

c. $\frac{\sqrt{x}-\sqrt{y}}{\sqrt{x}+\sqrt{y}}$



Copyright 2023, Jennifer Hill, DivideandConquerMath.com

**Lesson: Factoring by GCF and Trinomials (the more memorable types of factoring)**

How do you factor $3x + 3y$?

What type of factoring is this called?

**<u>Examples</u>** Show how to use the GCF to factor the following:

a. $4x + 12x^2 - 8x^3$

b. $5x^2y + 10x^7y^3 - 15x^5y^2$



Copyright 2023, Jennifer Hill, DivideandConquerMath.com

**Examples** Show how to use the GCF to factor the following:

a. $4x^2 + 12xy - 3y^2$

b. $15x^3y^4 - 25x^6y^2 + 20x^7y^8$

What is a trinomial?

Show how to multiply: $(x + 2)(x + 7)$



Copyright 2023, Jennifer Hill, DivideandConquerMath.com

Show how to factor $x^2 + 3x + 2$ using the *trial and error* method. Write down some reasoning explaining how this method works.

**<u>Example</u>** Factor the following using trial and error.

a. $x^2 + 5x + 6$

b. $x^2 - 7x + 12$

c. $x^2 - 25$



Copyright 2023, Jennifer Hill, DivideandConquerMath.com

Show how we can factor $2x^2 + 5x + 3$ using *trial and error.*

**<u>Examples</u>** Factor the following.

a. $5x^2 + 7x + 2$

b. $3x^2 + 13x - 10$



Copyright 2023, Jennifer Hill, DivideandConquerMath.com

**Lesson: Factoring by Grouping and the Sum and Difference of Cubes**

Show how to use grouping to factor: $ax + ay + bx + by$

What are some key hints that you probably need to use the grouping technique?

Write out the steps of how to use grouping for this problem:

**<u>Example</u>** Show how to finish the factoring for the following:

a. $5(x - 2y) + z^2(x - 2y)$

b. $6x^2(3y - z) - (3y - z)$



Copyright 2023, Jennifer Hill, DivideandConquerMath.com

**Examples** Use grouping to factor the following:

a. $4x^3 - 12xy + x^2y - 3y^2$

b. $xy + 4x - y - 4$

For the next example we will use $12x^2 - 15y + 18x - 10xy$

What is the issue when we try to use grouping?

How can we resolve this issue and still use grouping?



Copyright 2023, Jennifer Hill, DivideandConquerMath.com

Write the sum and difference of cubes formulas below:

**<u>Examples</u>** Factor the following:

a. $x^3 + 8$

b. $y^3 - 1$

c. $8x^3 + 27y^3$



Copyright 2023, Jennifer Hill, DivideandConquerMath.com

**Lesson: A Few More Tricks for Factoring**

List all the types of factoring that you might have to use:

It is always possible that you will have to combine these methods. There are also a few other tricks you can try, which we will discuss in this lesson.

Using **<u>Grouping</u>** with Trinomials

Write out *instructions* on how to use grouping for $4x^2 + 16x + 15$



Copyright 2023, Jennifer Hill, DivideandConquerMath.com

Below are a few challenging examples of factoring. Write out any notes of how to work these out that might be helpful to you. Remember, you are expected to use these notes as a resource to help you finish your homework – take the time to write down reminders that will be meaningful and helpful to you!

a. $-x^2 - 15x - 36$

What trick can you use here? Show how to use it.

b. $4y^3 - 28y^2 + 48y$

What trick can you use here? Show how to use it.

c. $-6x^2 + 10x - 3$



Copyright 2023, Jennifer Hill, DivideandConquerMath.com

d. $x^2 + 7xy + 12y^2$

How should you deal with having the multiple variables?

Finally, let's work with a few trickier examples of the difference of squares. Follow the pattern:

a. $x^2 - 16$

b. $x^2 - 25$

c. $x^2 - \frac{16}{25}$



Copyright 2023, Jennifer Hill, DivideandConquerMath.com

d. $16 - x^2$

e. $25x^2 - 16y^2$

f. $\frac{16}{25}x^2 - \frac{4}{9}y^2$



Copyright 2023, Jennifer Hill, DivideandConquerMath.com

**Lesson: A Review of Exponent Rules for Algebra Students**

Power Rule: $x^m * x^n =$

Product Rule: $(x^m)^n =$

Quotient Rule: $\frac{x^m}{x^n} =$

Negative Exponents

$x^{-n} =$

$\frac{1}{x^{-n}} =$

$\left(\frac{x}{y}\right)^{-n} =$

Simplify the following using exponent rules. Your final answer should not contain negative exponents.

a. $3x^7y^{-4} * 5x^{-2}y^9$

b. $\left(\frac{2x^4y^5}{3z^5}\right)^3$

c. $\frac{10x^4y^7}{2x^2y^3z^{-5}}$

d. $\frac{4x^3y^{-2}}{6x^{-4}y^{-5}}$

e. $\frac{8x^{-3}y^4z^{-3}}{10x^5y^{-2}z^{-7}}$

f. $\left(\frac{3x^{-3}y^{-2}}{6x^2y^4}\right)^{-2}$

g. $\left(\frac{2x^{-7}z^3}{3x^{-2}y^{-3}z^5}\right)^{-3}$

h. $\left(\frac{5x^{-2}y^{-3}z^3}{x^3y^4z^{-7}}\right)^{-2}$



Copyright 2020, Jennifer Hill, DivideandConquerMath.com

**Lesson: An Intro to Polynomials**

We can extend our knowledge of exponents to another algebraic topic – polynomials

Before we define what a polynomial is, it is usually easier to see a few examples of what is or is not a polynomial.

The following ARE polynomials:

- $x^2 - 3x + 8$
- $x^7 - 5x^4 + 2x^3 + x$
- $9$
- $7x + \pi$
- $x^3 + \frac{2}{3}$

The following ARE NOT polynomials:

- $\sqrt{x} - 4$
- $4x^{-4} - 7x^{-3}$
- $\frac{4}{x} - \frac{2}{x+3}$

Now we can more formally define a polynomial.

## Polynomial

An expression with real numbers, variables, and whole number exponents.

## Descending Order

Ordering a polynomial from the largest exponent to the smallest exponent, and any freestanding number without a variable is last

## Example 1

Put the polynomials in descending order.

a. $x^3 + 4x^5 - 2x^7 + 3x^2 + 5x^8$

b. $x^2 - x^3 + x^4 - x^5 - x^6 + 3$



Copyright 2020, Jennifer Hill, DivideandConquerMath.com

**Term**
Any part in a polynomial that is separated by a "+" or "-" sign is considered to be its own term

**Variables**
The letters in a polynomial that represent numbers

**Coefficients**
The numbers attached to the variables

**Constant Term**
The freestanding number within a polynomial that is not attached to any variables

**Example 1**
Examine the polynomials, then determine the variables, coefficients, and constant terms

| Polynomial | Terms | Variable(s) | Coefficient(s) | Constant |
|---|---|---|---|---|
| $2x + 3$ | | | | |
| $3x^2 - x + 5$ | | | | |
| $5$ | | | | |
| $2x^2y + 3y - x$ | | | | |



Copyright 2020, Jennifer Hill, DivideandConquerMath.com

## Degree of a Term

The degree of a term is the sum of the exponents of that term.

## Example 2

Identify the degree of each term

| Term | Degree | Term | Degree |
|---|---|---|---|
| $x^4$ | | $x^4y^3$ | |
| $3y^6$ | | $x^7y^9$ | |
| $x$ | | $x^4y^2z^5$ | |
| $6$ | | $xy^4$ | |

## Degree of a Polynomial

The degree of a polynomial is the same as the degree of the term of highest degree within that polynomial

## Leading Coefficient

The leading coefficient is the coefficient attached to the term of highest degree in a polynomial

## Trinomial

A polynomial with 3 terms

## Binomial

A polynomial with 2 terms

## Monomial

A polynomial with 1 term

## Example 3

Identify the degree of each polynomial and the type of polynomial it is.

| Polynomial | Degree of Each Term, Respectively | Deg of Polynom | Leading Coefficient | Type of Polynomial |
|---|---|---|---|---|
| $x^5 + 4x^3 - 2x$ | | | | |
| $-5x^2 + 18x$ | | | | |
| $6x + 2x^4 - 3x^2$ | | | | |
| $x^5 + 2x^7 - 4$ | | | | |
| $8$ | | | | |



Copyright 2020, Jennifer Hill, DivideandConquerMath.com

**Evaluating Polynomials**

Evaluating polynomials is not unlike evaluating other expressions we've seen in this course.

**Example 4**

Evaluate the polynomials for $x = -2$.

a. $x^2 + 3x + 1$

b. $x^3 - x^2 - 3x + 4$

c. $\frac{1}{4}x^3 - \frac{1}{2}x^2 + 5x$



Copyright 2020, Jennifer Hill, DivideandConquerMath.com

**Lesson: How to Add and Subtract Polynomials**

To add or subtract polynomials, combine like terms.

**<u>Examples</u>**

Perform the following operations.

a. $(2x + 4) + (5x^2 - 3x + 1)$

b. $(5x^2 - 3x + 1) - (x^3 - 2x^2 - x + 1)$

c. $(3x^3 + 2x^2 - 5x) + (4x^3 + 5x^2 + 2x)$

d. $(2x^2 + 5x - 4) - (x^3 - 2x^2 + 3x - 5)$



Copyright 2020, Jennifer Hill, DivideandConquerMath.com

**Lesson: How to Multiply Polynomials**

To begin, let's first focus on the process of distributing a monomial with a polynomial.

**<u>Examples</u>** Multiply the following:

a. $3x(4x^2 + 5x - 7)$

b. $x^2y^4(3x^2 + 2xy - 8y^4)$

c. $\frac{1}{2}x^3y^4(4xy^3 - 2x^3y + 8xy)$

Now write down the process for how to multiply $(x + 2)(x^2 + 3x)$



Copyright 2020, Jennifer Hill, DivideandConquerMath.com

**Examples** Multiply the following:

a. $(x+3)(x+2)$

b. $(3x+1)(x-6)$

c. $(x^2+4)(x-2y)$

d. $(x+4)(x-4)$

e. $(x+3)(x^2+4x+5)$

f. $(2x^2+3x+1)(3x^2-4x+2)$



Copyright 2020, Jennifer Hill, DivideandConquerMath.com

How do you multiply $(x+5)^2$?

**<u>Examples</u>** Multiply the following:

a. $(x+2)^2$

b. $(2x^2+1)^2$

c. $(3x^2+x+5)$

How do you multiply 3 polynomials together, such as $(x+2)(x+1)(x-3)$?



Copyright 2020, Jennifer Hill, DivideandConquerMath.com

**Examples** Multiply the following together:

a. $(x-3)(x+4)(x-1)$

b. $(2x+1)(x-2)(x-1)$



Copyright 2020, Jennifer Hill, DivideandConquerMath.com

**Lesson: The Basics of Dividing Polynomials**

In this section, we will discuss how to divide polynomials that are in these forms:

$\frac{x^2+3x}{x}$ or $(4x^7y^3 + 8x^4y^2 - 12x^5y^5) \div 2x^2y$

To divide in these cases, you can just use rules of exponents. Sometimes you will want to separate the problem into separate fractions.

**<u>Examples</u>**

a. $\frac{x^2+3x}{x}$

b. $\frac{5x^4-10x^3+15x^2}{5x}$

c. $(27x^4y^2 + 18x^3y) \div 9x^2y$

d. $(4x^7y^3 + 8x^4y^2 - 12x^5y^5) \div 2x^2y$



Copyright 2020, Jennifer Hill, DivideandConquerMath.com

**Lesson: Long Division for Polynomials**

In this section, we will discuss how to divide polynomials that are in these forms:

$(x^2 + 5x + 6) \div (x + 3)$ or $(2x^2 + 5x + 3) \div (2x + 3)$

In these types of problems, we need to use long division. In another video, we talked about how to divide polynomial problems like these:

$\frac{4x^3+2x^2}{2x}$

But we did not need long division. What is different about these types of problems that require long division?

Show how to use long division to divide $(x^2 + 5x + 6) \div (x + 3)$



Copyright 2020, Jennifer Hill, DivideandConquerMath.com

**Examples** Divide the following.

a. $(x^2 + 7x + 10) \div (x + 5)$

b. $(2x^2 + 5x + 3) \div (2x + 3)$

c. $\frac{x^2-11x+30}{x-5}$



Copyright 2020, Jennifer Hill, DivideandConquerMath.com

Now we will look at what to do when there is a remainder.

Divide the following: $(x^2 + 3x + 1) \div (x + 2)$

Now show how to divide when there are "missing" terms, such as with $(x^4 - 81) \div (x^2 - 9)$



Copyright 2020, Jennifer Hill, DivideandConquerMath.com

**Examples** Divide.

a. $(5x^2 - 10x^3 + 8 - 9x) \div (x + 2)$

b. $(x^3 + 1) \div (x + 1)$

c. $(5x^3 - 4x^2 + 1) \div (x + 2)$



Copyright 2020, Jennifer Hill, DivideandConquerMath.com

**A Quick(ish) Review of Factoring**

We will quickly go over the 4 types of factoring in this video.

- Greatest Common Factor (GCF)
- Grouping
- Trinomials
- Sum/Difference of Cubes

**Greatest Common Factor**

Show how the GCF works with the example: $3x + 3y$

**<u>Examples</u>** Factor the following.

a. $15x^2y + 10xy^3$

b. $27xy^4 - 18x^2z + 81x^4y^3$

c. $7xy - 3z^4$



Copyright 2021, Jennifer Hill, DivideandConquerMath.com

**Grouping**

Show how to use grouping with: $ax + ay + bx + by$

a. $3x + 6y - xy - 2y^2$

b. $x^4 - x^2 - 3x^3 - 3x$



Copyright 2021, Jennifer Hill, DivideandConquerMath.com

**Trinomials**

What are some of the standard forms of trinomials presented in the video?

**<u>Examples</u>** Factor using trial and error.

a. $x^2 + 3x + 2$

b. $x^2 + 7x + 10$

c. $-x^2 + 2x + 15$

d. $x^2 - 4$

e. $x^2 + 5xy + 6y^2$

f. $2x^2 + 5x + 3$



Copyright 2021, Jennifer Hill, DivideandConquerMath.com

**Sum and Difference of Cubes**

Write down the formulas for the sum and difference of cubes.

**<u>Examples</u>** Factor.

a. $x^3 + 27$

b. $8x^3 - y^3$



Copyright 2021, Jennifer Hill, DivideandConquerMath.com

**Lesson: The Greatest Common Factor**

## The Greatest Common Factor (GCF)

The Greatest Common Factor is the biggest common factor between a set of terms.

## Examples

Find the greatest common factor in the following polynomials, then factor the polynomial.

a. Polynomial: $3x + 3y$

   GCF:

   Factor out the GCF:

b. Polynomial: $3xy + 6xz$

   GCF:

   Factor out the GCF:

c. Polynomial: $10x^2 - 25xy + 15xz$

   GCF:

   Factor out the GCF:

d. Polynomial: $3x^7y + 8x^3z^5 - 5y^4z^3$

   GCF:

   Factor out the GCF:

## Examples



Copyright 2020, Jennifer Hill, DivideandConquerMath.com

Factor the following polynomials.

a. $12xy^2 + 10x^2y^4 - 14xy^5$

b. $5xy - 10yz + 12xz$

c. $3x + 6x^2 - 12x^3$

d. $5x^4y^2z^5 + 10x^2y^4z^6 - 25x^5yz^3$



Copyright 2020, Jennifer Hill, DivideandConquerMath.com

**Lesson: Factoring by Grouping**

Grouping can best be understood with the following example.

Factor $ax + ay + bx + by$ by grouping:

## Examples

Finish the following examples where the grouping had been started.

a. $3(x - y) + 2z(x - y)$

b. $2a(3b + 2c) - 5(2c + 3b)$

c. $4x(y - z) - 3(z + y)$

d. $4z(4x - 7) - (4x - 7)$



Copyright 2020, Jennifer Hill, DivideandConquerMath.com

**Examples**

Factor the following.

a. $5x + 10y + xz + 2yz$

b. $10x^2 + 15x^3y - 2 - 3xy$

c. $3xy + 4y - 27x - 36$

d. $3xy + 6x + 21y + 42$

e. $3x^2 - 48y + 8x - 18xy$



Copyright 2020, Jennifer Hill, DivideandConquerMath.com

**Lesson: The Basics of Factoring Trinomials of the Form $x^2 + bx + c$**

Factoring trinomials will require us to multiply polynomials, so first we will review this skill.

## Examples

Multiply.

a. $(x + 3)(x - 5)$

b. $(2x - y)(5x + 2y)$

## Definition of a Trinomial

A trinomial is a polynomial with three terms.

## How to Factor a Trinomial Using Trial and Error

Show how to factor $x^2 + 3x + 2$

Show how to factor $x^2 + 7x + 12$



Copyright 2020, Jennifer Hill, DivideandConquerMath.com

**Examples**

Factor the following.

a. $x^2 + 6x + 5$

b. $x^2 + 12x + 11$

c. $x^2 - 8x + 15$

d. $x^2 - 13x + 30$

e. $x^2 + 10x - 24$

f. $x^2 - 5x - 14$

g. $2x^2 + 16x + 30$

h. $5x^4 + 55x^3 - 45x^2$



Copyright 2020, Jennifer Hill, DivideandConquerMath.com

**Lesson: The Basics of Factoring Trinomials of the Form $-x^2 + bx + c$**

How can you factor $-x^2 - 5x - 6$?

What about $-x^2 - 15x - 36$?

**<u>Examples</u>**

Factor the following.

a. $-x^2 + 13x - 30$

b. $-x^2 + 16x - 55$

c. $-x^2 - 2x + 3$



Copyright 2020, Jennifer Hill, DivideandConquerMath.com

**Lesson: The Basics of Factoring Trinomials of the Form $x^2 + bxy + cy^2$**

How do you factor $x^2 + 5x + 6$?

How do you factor $x^2 + 5xy + 6y^2$?

**<u>Examples</u>** Factor the following.

a. $x^2 + xy - 12y^2$

b. $x^2 - 2xy + y^2$

c. $3x^2 + 21xy + 18y^2$



Copyright 2020, Jennifer Hill, DivideandConquerMath.com

**Lesson: The Basics of Factoring Trinomials of the Form $\boldsymbol{ax^2 + bx + c}$**

In this lesson we will focus on trinomials that do not have a leading coefficient.

To begin, first let's get warmed up by factoring the following using trial and error:

a. $x^2 + 7x + 12$

b. $x^2 - 3xy + 10y^2$

How do you factor $2x^2 + 5x + 3$ using trial and error?

How do you factor $3x^2 + 16x + 5$ using trial and error?

Another way to factor $3x^2 + 16x + 5$ is by grouping. Show how to use this technique below:



Copyright 2020, Jennifer Hill, DivideandConquerMath.com

**Examples** Factor the following:

a. $7x^2 - 11x + 4$

b. $3x^2 + 10x + 8$

c. $5x^2 - 11x - 36$

d. $3x^2 - 17xy - 6y^2$

e. $-10x^2 + 19x - 6$



Copyright 2020, Jennifer Hill, DivideandConquerMath.com

**Lesson: Factoring Special Trinomials**

How do you factor $x^2 + 6x + 9$?

What's another way to write this factorization?

What do you call this type of trinomials?

**<u>Examples</u>** Factor the following:

a. $x^2 + 12x + 36$

b. $9x^2 - 12x + 16$

c. $x^2 - x + \frac{1}{4}$

d. $36x^2 - 60xy + 25y^2$



Copyright 2020, Jennifer Hill, DivideandConquerMath.com

How do you factor $x^2 - 4$?

What is this type of factoring called?

**<u>Examples</u>** Factor the following:

a. $x^2 - 25$

b. $x^2 - 16$

c. $x^2 - 1$

d. $25x^2 - 36$

e. $16x^2 - 81y^2$

f. $16 - x^2$

g. $25y^2 - 64x^2$

h. $\frac{49}{64} - x^2$



Copyright 2020, Jennifer Hill, DivideandConquerMath.com

**Lesson: How to Factor The Sum and Difference of Cubes**

Write down the formula for the sum of cubes

$a^3 + b^3 =$

Write down the formula for the difference of cubes

$a^3 - b^3 =$

Show how to factor $x^3 + 8$

Show how to factor $8x^3 - 27$

**<u>Examples</u>** Factor:

a. $x^3 - 1$

b. $x^3 - \frac{1}{8}$

c. $x^3 + 64$



Copyright 2020, Jennifer Hill, DivideandConquerMath.com

**Review: An Overview of All the Types of Factoring**

We will review all of the different types of factoring by presenting an example of each type.

**Greatest Common Factor**

1. $4x^2 + 8xy$

2. $6x^3y^2 - 8x^2y^5 + 10x^5y$

**Grouping**

3. $3x + 6y - xz^2 - 2yz^2$

4. $12x^2 - 2y + 3x - 8xy$

**Basic Trinomials of the Form $\boldsymbol{x^2 + bx + c}$**

5. $x^2 + 7x + 10$

6. $x^2 - 2x - 15$



Copyright 2020, Jennifer Hill, DivideandConquerMath.com

**Trickier or Special Forms of Trinomials of the Form $x^2 + bx + c$**

7. $-x^2 - 3x + 28$

8. $6x^2 + 54x + 120$

9. $x^2 - 6xy + 8y^2$

10. $x^2 - 8x + 16$

11. $x^2 - 25$

12. $x^2 - \frac{9}{4}$



Copyright 2020, Jennifer Hill, DivideandConquerMath.com

**Trinomials of the Form $\boldsymbol{ax^2 + bx + c}$**

13. $2x^2 + 11x + 5$

14. $7x^2 - 15x + 8$

15. $-3x^2 - 15x^2 + 198x$

16. $16x^2 - 24xy + 9y^2$

**More Practice with the Difference of Squares**

17. $x^2 - 81$

18. $25x^2 - 4$

19. $\frac{1}{4}x^2 - 9y^2$



Copyright 2020, Jennifer Hill, DivideandConquerMath.com

**Sum and Difference of Cubes**

20. $x^3 + 8$

21. $x^3 - 27$

22. $27x^3 - 1$

23. $8x^3 + 64y^3$



Copyright 2020, Jennifer Hill, DivideandConquerMath.com

**Rational Expressions**
**Video 1: The Basics**

What are rational expressions?

What do rational expressions look like? Write down some examples:

**<u>Simplifying Rational Expressions</u>**
Take down some notes on this:



Copyright 2020, Jennifer Hill, DivideandConquerMath.com

**Examples** together:

a. $\frac{25x^7y^9}{15x^3y^2z^7}$

**Examples** on your own:

b. $\frac{21x^7y^9}{14y^8z^3}$

c. $\frac{16x^4y^7z^3}{15x^3y^4z^8}$



Copyright 2020, Jennifer Hill, DivideandConquerMath.com

**Examples** together:

a. $\frac{x^2+5x+6}{x^2-9}$

**Examples** on your own:

b. $\frac{x^2+7x+10}{x^2+10x+25}$

c. $\frac{x^2-x-6}{x^2-9x+14}$

d. $\frac{x^2+10x+16}{x^3+2x^2+x+2}$

Play the video and check your work.



Copyright 2020, Jennifer Hill, DivideandConquerMath.com

**Examples** on your own:

e. $\frac{x^3-8}{x^2-9x+14}$

f. $\frac{10x^3+15x^7}{10x^3+40x^2+40x}$



Copyright 2020, Jennifer Hill, DivideandConquerMath.com

**Rational Expressions**
**Video 2: Other Things to Know**

When it comes to fractions, where are you allowed to have a zero? In the numerator (top) or denominator (bottom)?

Therefore, what do we have to worry about with rational expressions?

**Examples** on your own:

Evaluate the following rational expressions for $x = 2$.

a. $\frac{x^2+6x+8}{x^2+8x+15}$

b. $\frac{x^2+9x+20}{x^2+3x-10}$



Copyright 2020, Jennifer Hill, DivideandConquerMath.com

**Example** on your own: (evaluate for x=2)

c. $\frac{x^2-4}{x^2+9x+14}$

**To summarize…**

When a rational expression has a zero in the numerator, what does this mean?

When a rational expression has a zero in the denominator, what does this mean?

Define the term **domain:**

What are we concerned with for the domain of rational expressions?



Copyright 2020, Jennifer Hill, DivideandConquerMath.com

**A review of interval notation:**

**Examples**:

Write the following in interval notation:

a.

b.

c.



Copyright 2020, Jennifer Hill, DivideandConquerMath.com

**Example** together:

Determine i) where the expression equals zero ii) where the expression is undefined iii) the domain of the expression

a. $\frac{x+3}{x-5}$

b. $\frac{2x+1}{x^2+7x+10}$

**Examples** on your own:

Determine i) where the expression equals zero ii) where the expression is undefined iii) the domain of the expression

c. $\frac{x-3}{x-1}$

d. $\frac{x^2-81}{x^2+5x+6}$



Copyright 2020, Jennifer Hill, DivideandConquerMath.com

**Rational Expressions**
**Video 3: The Negative One Trick with Simplifying**

In its current form, can you simplify: $\frac{x-3}{3-x}$? Why or why not?

Show how you can manipulate this expression to simplify it.

There is no formal name for this trick. Some might refer to it as a *multiplicative property of -1,* but I refer to as "that -1 trick." I know, it's not exactly formal sounding!

Let's do one more example of this. Simplify $\frac{5-x}{3x-15}$



Copyright 2020, Jennifer Hill, DivideandConquerMath.com

The first thing to get used to it how to rewrite expressions using this trick.

**Examples**

Rewrite the order of each expression by factoring out -1 first.

a. $4 - x$

b. $3x - 1$

c. $x - 6$

Now let's use this to simplify rational expressions.

**Examples** Simplify the following.

a. $\frac{6x-12}{2-x}$



Copyright 2020, Jennifer Hill, DivideandConquerMath.com

**Examples** Simplify the following.

b. $\frac{4x-20}{30x-6x^2}$

c. $\frac{x^2-4}{2-x}$

d. $\frac{x-6}{36-x^2}$

e. $\frac{5-x}{x^2-7x+10}$



Copyright 2020, Jennifer Hill, DivideandConquerMath.com

**Examples** Simplify the following.

f. $\frac{x^2-10x+25}{25-x^2}$

g. $\frac{27-x^3}{x^2-5x+6}$

h. $\frac{x^3-3x^2+5x-15}{6-3x}$



Copyright 2020, Jennifer Hill, DivideandConquerMath.com

**Examples** Simplify the following.

i. $\frac{54-9x}{x^2-36}$

j. $\frac{8-x^3}{x^2-9x+14}$

k. $\frac{y^3-x^3}{x^2-y^2}$



Copyright 2020, Jennifer Hill, DivideandConquerMath.com

**Example/Question: Troubleshooting the -1 Trick**

Explain the actual DETAIL behind WHY $\frac{4}{5-x} = -\frac{4}{x-5}$

**<u>Examples</u>** Write an equivalent fraction for the following:

a. $\frac{5}{x-8}$

b. $\frac{x-3}{x+2}$



Copyright 2021, Jennifer Hill, DivideandConquerMath.com

**Lesson: Multiplying Rational Expressions**

How do you multiply the fractions $\frac{a}{b} \times \frac{c}{d}$? Include a one-sentence explanation.

**<u>Examples</u>** Multiply the following.

a. $\frac{4}{5} \times \frac{7}{9}$

b. $\frac{2x^3}{7y^2} \times \frac{5x^5}{9y^7}$



Copyright 2023, Jennifer Hill, DivideandConquerMath.com

Show how to make cancellations before multiplying $\frac{12}{25} \times \frac{15}{16}$

We can apply this same logic to rational expressions.

**<u>Examples</u>** Multiply the following and simplify when possible.

a. $\frac{21x^7}{15y^3} \times \frac{5y^8}{42x^4}$

b. $\frac{2x^2+5x+3}{x^2-25} \times \frac{x^3+125}{4x^2+6x}$



Copyright 2023, Jennifer Hill, DivideandConquerMath.com

**Lesson: Dividing Rational Expressions**

How do you divide $\frac{a}{b} \div \frac{c}{d}$? Write a one sentence explanation of how to do this too.

**<u>Example</u>** Divide the following: $\frac{5x}{9} \div \frac{2}{7x^4}$

When can you make cancellations in the process?



Copyright 2023, Jennifer Hill, DivideandConquerMath.com

**<u>Examples</u>** Divide.

a. $\frac{12x^7}{45} \div \frac{42x^3}{15}$

b. $\frac{x^2+4x+4}{x+5} \div (x+2)^5$

c. $\frac{x^3+1}{6x^3-6x^2+6x} \div \frac{x^2-1}{8}$



Copyright 2023, Jennifer Hill, DivideandConquerMath.com

Explain why $\frac{\frac{5x+5y}{24}}{\frac{15x^2+15xy}{12}}$ is both a fraction and a division problem.

**<u>Example</u>** Divide: $\frac{\frac{16x^2-25}{x^5}}{\frac{36x-45}{9x^7}}$



Copyright 2023, Jennifer Hill, DivideandConquerMath.com

**Lesson: Finding the Least Common Denominator for Addition and Subtraction – A Quick Review for Fractions (with only numbers)**

We are going to work on adding and subtracting rational expressions with different denominators. Before we do that, we are going to remind ourselves how to find common denominators for fractions that only have numbers.

The simplest case: what is the least common denominator between the fractions $\frac{1}{2}$ and $\frac{1}{3}$?

Why is that the common denominator?

Now let's look at something slightly more complicated. What is the least common denominator between $\frac{1}{6}$ and $\frac{1}{10}$?

First, take a guess. It's totally fine if this guess is wrong, but just make a guess.

*Why* is this your guess? What did you do?



Copyright 2023, Jennifer Hill, DivideandConquerMath.com

There is a specific procedure that you want to use when finding least common denominators in this class. Write down instructions that were given in the video, but write them our in a way that makes sense to you.

Repeat this procedure to find the least common denominator $\frac{1}{15}$ and $\frac{1}{10}$.



Copyright 2023, Jennifer Hill, DivideandConquerMath.com

Repeat this procedure to find the least common denominator $\frac{1}{12}$ and $\frac{1}{8}$.

Now we will focus on how to write fractions with this desired denominator.

The simplest case: using the least common denominator you found for $\frac{1}{2}$ and $\frac{1}{3}$, show how to write 2 equivalent fractions with the desired denominator. Write out instructions on how you do this. Summarize what was discussed in the explanation in the video.



Copyright 2023, Jennifer Hill, DivideandConquerMath.com

Using the least common denominator you found for $\frac{1}{6}$ and $\frac{1}{10}$, show how to write 2 equivalent fractions with the desired denominator. Write out instructions on how you do this. Summarize what was discussed in the explanation in the video.

Using the least common denominator you found for $\frac{1}{12}$ and $\frac{1}{8}$, show how to write 2 equivalent fractions with the desired denominator. Write out instructions on how you do this. Summarize what was discussed in the explanation in the video.



Copyright 2023, Jennifer Hill, DivideandConquerMath.com

**Lesson: Finding the Least Common Denominator for Rational Expressions**

The simplest case: what is the least common denominator between the fractions $\frac{1}{2x}$ and $\frac{1}{3y^2}$?

**<u>Examples</u>** Find the least common denominator between the following fractions.

a. $\frac{1}{2x^2}, \frac{1}{3xy^2}$

b. $\frac{1}{2x^2y^5}, \frac{1}{3x^7y^2}$

c. $\frac{1}{2x^3y^5z^2}, \frac{1}{3x^5y^7z^8}$



Copyright 2023, Jennifer Hill, DivideandConquerMath.com

**Examples** Find the least common denominator for the following.

a. $\frac{1}{14x^3y^2}, \frac{1}{21x^2y^7}$

b. $\frac{1}{24x^3y}, \frac{1}{12x^2y^5}$

What is the least common denominator between $\frac{1}{x+2}$ and $\frac{1}{x}$?



Copyright 2023, Jennifer Hill, DivideandConquerMath.com

What is the least common denominator between $\frac{1}{x^2-4}$ and $\frac{1}{x^2+5x+6}$?

**<u>Examples</u>** Find the least common denominator between the following fractions.

a. $\frac{3}{5x-10}, \frac{1}{7x-14}$

b. $\frac{1}{x^2-12x+35}, \frac{1}{x^2+x-20}$



Copyright 2023, Jennifer Hill, DivideandConquerMath.com

**Examples** Find the least common denominator between the following fractions.

a. $\frac{1}{x-3}, \frac{1}{3-x}$

b. $\frac{1}{x^2-4}, \frac{1}{2-x}$

c. $\frac{1}{x^2+9x+20}, \frac{1}{x^2-25}, \frac{1}{x^2-x-20}$



Copyright 2023, Jennifer Hill, DivideandConquerMath.com

**Lesson: Writing Equivalent Rational Expressions with the Same Denominator**

**<u>Examples</u>** Find the least common denominator between the following rational expressions, and then write each rational expression with it's equivalent and the LCD.

a. $\frac{2}{15x^2y^5}, \frac{4}{9x^3y^2}$

b. $\frac{5}{x+3}, \frac{4}{x}$



Copyright 2023, Jennifer Hill, DivideandConquerMath.com

**<u>Examples</u>** Find the least common denominator between the following rational expressions, and then write each rational expression with it's equivalent and the LCD.

a. $\frac{x}{x^2+9x+18}, \frac{2}{x^2+5x+6}$

b. $\frac{x}{5x^2-30x}, \frac{x-2}{2x^2-17x+30}, \frac{2}{2x^2-5x}$



Copyright 2023, Jennifer Hill, DivideandConquerMath.com

**Lesson: Adding and Subtracting Rational Expressions**

Show how to add or subtract the following:

a. $\frac{5}{x+2} - \frac{3}{x+2}$

b. $\frac{5}{x-4} + \frac{7}{x}$

c. $\frac{5}{12xy^2} - \frac{7}{8x^3y}$



Copyright 2023, Jennifer Hill, DivideandConquerMath.com

d. $\frac{x}{x+3} - \frac{2}{x^2-9}$

e. $\frac{x}{x^2-25} - \frac{5}{x^2-3x-40}$



Copyright 2023, Jennifer Hill, DivideandConquerMath.com

**Example/Question: When Are You Allowed to Cancel with Rational Expressions?**

What is the wrong way to cancel $\frac{(x+1)-3(x-3)}{2(x-3)+4(x+1)}$ and explain why you can't cancel like that? How can you tell it's wrong?

What is the difference between $\frac{(x+1)-3(x-3)}{2(x-3)+4(x+1)}$ and $\frac{3(x+1)(x-3)}{2(x-3)(x+1)}$?

How do you simplify $\frac{(x+1)-3(x-3)}{2(x-3)+4(x+1)}$?



Copyright 2021, Jennifer Hill, DivideandConquerMath.com

**Lesson: Complex Fractions**

First let's review how to simplify a complex fraction we've already discussed. Show how to simplify:

$$\frac{\frac{2x}{x+5}}{\frac{2}{x^2-25}}$$

Explain what makes the problem below different from the one we just reviewed above.

$$\frac{\frac{1}{2}-\frac{1}{3}}{\frac{5}{6}+\frac{1}{3}}$$



Copyright 2023, Jennifer Hill, DivideandConquerMath.com

Outline the steps required to simplify. Write out the instructions as they were explained in the video.

$$\frac{\frac{1}{2}-\frac{1}{3}}{\frac{5}{6}+\frac{1}{3}}$$

**<u>Example</u>** Simplify the following

$$\frac{\frac{7}{9}-\frac{1}{3}}{1+\frac{5}{9}}$$



Copyright 2023, Jennifer Hill, DivideandConquerMath.com

**Examples** Simplify the following.

a. $\dfrac{\frac{5}{x}+\frac{2}{y}}{\frac{1}{y}-\frac{3}{x}}$

b. $\dfrac{\frac{6}{x+3}-\frac{4}{x-1}}{\frac{2}{x-1}+\frac{5}{x+3}}$



Copyright 2023, Jennifer Hill, DivideandConquerMath.com

**<u>Example</u>** Simplify the following.

$$\frac{1-\dfrac{4}{t+5}}{\dfrac{4}{t^2-25}+\dfrac{t}{t-5}}$$



Copyright 2023, Jennifer Hill, DivideandConquerMath.com

**Complex Fractions**
**Video 2: More Complicated Examples**

Complex fractions look like this:

$$\frac{\frac{4x}{15y^2}}{\frac{6x^4}{25y^8}} \quad \text{or} \quad \frac{\frac{1}{3}-\frac{1}{6}}{\frac{3}{2}+\frac{5}{6}} \quad \text{or} \quad \frac{\frac{4}{x^2}-\frac{4}{y^2}}{\frac{1}{xy}+\frac{5}{y}}$$

First we will discuss the basics.

**<u>Examples</u>**

a. $\frac{\frac{1}{x^2}-\frac{1}{y}}{\frac{3}{x}-\frac{4}{y^2}}$

b. $\frac{\frac{3}{x}-x}{\frac{2}{x}+x}$



Copyright 2020, Jennifer Hill, DivideandConquerMath.com

**Examples**

a. $\dfrac{\frac{3}{x-1}-\frac{2}{x+3}}{\frac{5}{x+3}-\frac{2}{x-1}}$

b. $\dfrac{\frac{5}{x-2}-\frac{3}{x+5}}{\frac{1}{x+5}+\frac{2}{x-2}}$



Copyright 2020, Jennifer Hill, DivideandConquerMath.com

**Examples**

a. $\dfrac{1-\frac{1}{x+5}}{\frac{x}{x-5}+\frac{4}{x^2-25}}$

b. $\dfrac{1+\frac{12}{x^2-16}}{\frac{x}{x+4}-\frac{6}{x-4}}$

c. $\dfrac{\frac{1}{x+2}+\frac{4}{x^2-4}}{\frac{3}{x-2}+1}$



Copyright 2020, Jennifer Hill, DivideandConquerMath.com

**Lesson: A Quick Review of Some Things About Graphing**

Remind yourself how to graph the following points. Draw your own graph.

Point 1: $(-3, 4)$ Point 2: $(0, -2)$

Draw another rectangular coordinate system below and label the quadrants and origin.

Often when graphing, we use equations in two variables.

**<u>Example</u>** Find the ordered pair associated with the equation $3x + y^2 = 7$ when $x = 1$



Copyright 2022, Jennifer Hill, DivideandConquerMath.com

**Example** Find at least 3 ordered pairs for the following equations.

a. $y = \sqrt{x+2}$

b. $2x + 3y = 6$

Finding 3 points can be a strategy for graphing.

**Example** Sketch a graph for the previous 2 examples.

What is the x-intercept? And how do you find it?

What is the y-intercept? And how do you find it?



Copyright 2022, Jennifer Hill, DivideandConquerMath.com

**Examples** Find the x- and y-intercepts for the following equations.

a. $y = 3x - 1$

b. $x = \sqrt{y - 1}$

c. $x^2 - 3x + 2 = y$



Copyright 2022, Jennifer Hill, DivideandConquerMath.com

**Lesson: The Distance Formula**

Graph the points $(2, 4)$ and $(-4, -6)$. Explain how you can find the distance between these points by summarizing the explanation given in the video (make a decent effort to explain this – you will have an easier time remembering the formula if you understand WHY it works).

State the distance formula:



Copyright 2022, Jennifer Hill, DivideandConquerMath.com

**Example** Find the distance between the following points: $(4, -1)$ and $(7, 3)$

There are 2 ways we can use the distance formula.

**Example** Show how to use the distance formula to determine whether the following points are the vertices of a right triangle.

a. $(0, -2), (-4, 3)$ and $(5, 1)$

b. $(-2, -8), (0, -4)$ and $(-4, -7)$



Copyright 2022, Jennifer Hill, DivideandConquerMath.com

What does it mean for 3 points to be collinear?

**<u>Example</u>** Show how to use the distance formula to determine if the 3 points are collinear.

a. $(-1, 4), (-2, -1), (1,14)$

b. $(-2, -4), (-6, 11), (0, -12)$



Copyright 2022, Jennifer Hill, DivideandConquerMath.com

**Lesson: The Midpoint Formula**

What is the midpoint formula?

So what is the midpoint formula effectively doing?

**<u>Example</u>** Find the midpoint between the points $(-5, -6)$ and $(-3, 2)$

**<u>Example</u>** The midpoint of a line segment is $(5, 8)$ and the endpoint of that line segment is $(11, 10)$. What is the OTHER endpoint on this line segment?



Copyright 2022, Jennifer Hill, DivideandConquerMath.com

**Example** The midpoint of a line segment is $(3, 1)$ and the endpoint of that line segment is $(6, 8)$. What is the OTHER endpoint on this line segment?

**Example** The midpoint of a line segment is $(2a, 5b)$ and the endpoint of that line segment is $(-1a, 9b)$. What is the OTHER endpoint on this line segment?



Copyright 2022, Jennifer Hill, DivideandConquerMath.com

**Lesson: Equations of Circles and How to Graph Circles**

Draw the circle in the video and label the relevant parts of it.

Using your sketch above, explain how the distance formula can be used to help us determine the equation of a circle (you will need to summarize the explanation in your own words).

What is the **Center-Radius Form** of the equation of a circle?



Copyright 2022, Jennifer Hill, DivideandConquerMath.com

**Example** Find the center radius form of a circle using the given information.

a. center $(-2, 3)$ and radius 4

b. center $(0, -1)$ and radius 2

**Example** Graph the following circles.

a. $(x-1)^2 + (y+3)^2 = 4$

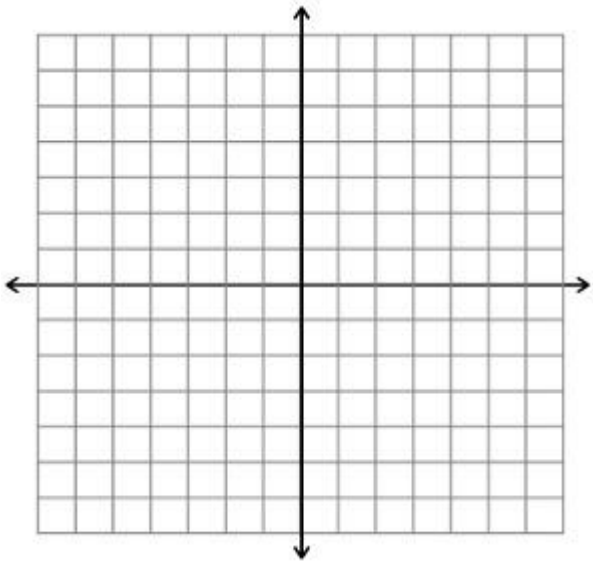

b. $x^2 + y^2 = 9$

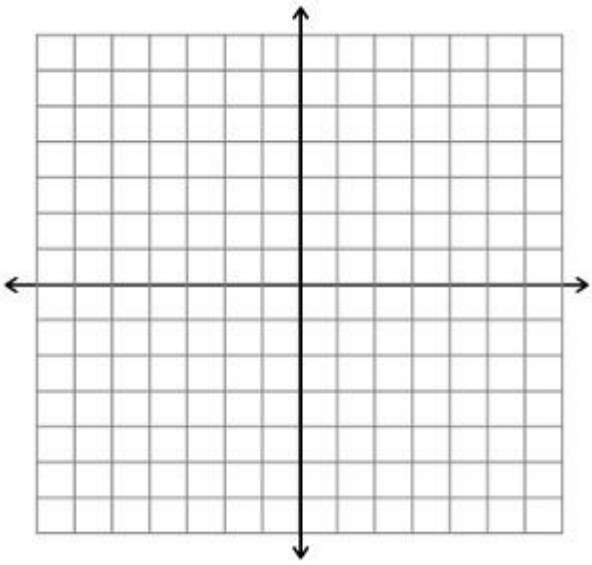



Copyright 2022, Jennifer Hill, DivideandConquerMath.com

Expand $(x-1)^2+(y+3)^2=4$ and show how this creates the general form.

What is the **General Form** of the equation of a circle?

**<u>Example</u>** Review how to use completing the square with the equation: $x^2-6x+4=0$.



Copyright 2022, Jennifer Hill, DivideandConquerMath.com

**<u>Example</u>** Show how to use completing the square to write each in the center-radius form, and then sketch a graph of the circle.

a. $x^2 - 4x + y^2 + 8y - 44 = 0$

b. $x^2 + y^2 + 2x - 6y + 14 = 0$



Copyright 2022, Jennifer Hill, DivideandConquerMath.com

**Examples: Working with the General Form Equation of a Circle**

**<u>Example</u>** Show how to use completing the square to write in the center-radius form, and then sketch a graph of the circle if possible.

a. $4x^2 + 4y^2 + 4x + 16y - 19 = 0$

b. $x^2 + y^2 - 4x - 4y + 8 = 0$



Copyright 2022, Jennifer Hill, DivideandConquerMath.com

c. $x^2 + y^2 + 2x - 4y + 18 = 0$

d. $9x^2 + 9y^2 + 12x - 18y - 23 = 0$



Copyright 2022, Jennifer Hill, DivideandConquerMath.com

**Examples: Graphing Circles Using Technology**

You can use this page to take notes for how to solve the following 2 examples:

a. Find all coordinates of points whose distance from (-3, 2) and (-2, 1) is $\sqrt{5}$.

b. There's an earthquake! There are 2 receiving stations with the following coordinates:

$$A = (-1, 1), B = (-2, 1), C = (-3, -1)$$

The epicenter of the earthquake is 2 units from stations A and C, and $\sqrt{5}$ units from B. Where is the epicenter?



Copyright 2022, Jennifer Hill, DivideandConquerMath.com

**Lesson: Solving Linear Equations, A Review of the Basics**

To begin, let's review some of what we've learned about working with equations and using graphs to solve them.

**Linear Equation in One Variable**
An equation that can be written in the form ax+b=0 where a and b are real numbers

**Solution**
A value that when substituted into the variable of an equation makes the equation true

**Example 1**
Determine if $x = -1$ is a solution to the following equations.
a. $5 - 4x = 9$

b. $2x + 3 = 1 - 3x$

We will now work with some basic ideas of solving linear equations. There are two key concepts we must understand to do this.

**The Addition Principle**
Let a, b, and c be real numbers. If a=b then:



Copyright 2020, Jennifer Hill, DivideandConquerMath.com

**Example 1**

Use the addition principle to solve the following:

Choose at least one from each category. Label the examples you choose as a, b, c, etc to keep the class organized.

a. $x - 4 = 2$

b. $x + 3 = 3$

c. $x - \frac{1}{3} = \frac{1}{2}$

**The Multiplication Principle**

Let a, b, c be real numbers. If a=b then:

**Example 2**

Use the multiplication principle to solve the following:

a. $3x = 15$

b. $5x = 0$

c. $-\frac{2}{5}\mathrm{x} = 10$



Copyright 2020, Jennifer Hill, DivideandConquerMath.com

**Example 3**

Solve the following examples:

a. $5 - 4x = 33$

b. $3x + 2 = 2 + 4x - 8$

c. $3(4 - 2x) = 3x + 6$



Copyright 2020, Jennifer Hill, DivideandConquerMath.com

**Lesson: Solving Linear Equations, No Solution and Infinite Solutions**

There are 2 special outcomes we have to watch out for:

**<u>An Example Where There Is No Solution</u>**

$3(2x - 1) = 2(2x + 1) - 2(3 - x)$

**<u>An Example Where There Are Infinite Solutions</u>**

$4x + 5 = 3(2x + 1) - 2(x - 1)$

**<u>A Summary of the 3 Possible Solution Types for Linear Equations</u>**



Copyright 2020, Jennifer Hill, DivideandConquerMath.com

**Examples: Solving Linear Equations, Basic Examples with No Fractions or Decimals**

a. $\mathbf{3x - 5 = 7}$

b. $\mathbf{6 - 2x = 6}$

c. $\mathbf{4x + 7 = 2x - 9}$

d. $\mathbf{3 - 4x - 7 + 2x = 4 - 6x - 8 + 4x}$

e. $\mathbf{4x + 7 + 6x = 7(1 - 2x)}$

f. $\mathbf{3(5 - 2x) - 6(3 - 2x) = 5(1 + 2x)}$

g. $\mathbf{4(2x - 1) - 2(6 - 3x) = 2(3x - 4)}$

h. $\mathbf{3(2x - 5) - 4x + 1 = 4(x - 3) - 2(1 - 3x)}$



Copyright 2020, Jennifer Hill, DivideandConquerMath.com

**Lesson: Solving Linear Equations with Fractions**

To begin, we will look at 3 examples to demonstrate how to clear fractions without parentheses. Take notes as shown in the video.

a. $\frac{1}{2}x + \frac{1}{5} = \frac{6}{5}$

b. $\frac{1}{2}x + \frac{1}{5} - \frac{1}{10}x = 1 + \frac{3}{10}x - \frac{2}{5}$

c. $\frac{1}{2}x + 1 + \frac{1}{4}x = \frac{3}{4} + \frac{2}{3} + \frac{1}{3}x$



Copyright 2020, Jennifer Hill, DivideandConquerMath.com

Now we will look at how to clear fractions in equations with parentheses.

a. $\frac{3}{4}(3+2x)-\frac{1}{2}(5-3x)=\frac{5}{4}$

b. $\frac{1}{2}(x+2)+\frac{1}{3}(2x-5)=\frac{1}{3}(4+2x)$



Copyright 2020, Jennifer Hill, DivideandConquerMath.com

**Examples: Solving Linear Equations with Fractions (No Parentheses)**

a. $\frac{1}{5}x - \frac{1}{3} = \frac{2}{3}$

b. $\frac{1}{3}x - 1 + \frac{1}{5}x + \frac{2}{5} = \frac{2}{5}x + \frac{1}{5}$

c. $\frac{1}{4}x - \frac{1}{10} + \frac{1}{5}x - \frac{4}{5} = \frac{3}{20}x + \frac{1}{10} + \frac{3}{10}$

d. $\frac{2}{3}x + \frac{1}{3} - \frac{1}{2}x = \frac{5}{6}x - \frac{1}{6} - \frac{2}{3}x + \frac{1}{2}$



Copyright 2020, Jennifer Hill, DivideandConquerMath.com

**Examples: Solving Linear Equations with Fractions (With Parentheses)**

a. $\frac{1}{2}(3x-2)-\frac{2}{5}(2x-3)=\frac{1}{5}(x+1)$

b. $\frac{3}{4}(4x+5)+\frac{1}{2}(2-3x)=\frac{3}{4}(2x+1)$

c. $\frac{1}{2}(2x+3)-\frac{1}{3}(2x-1)=\frac{1}{4}(x+7)$

d. $\frac{3}{4}(2x-1)+\frac{5}{8}(2-4x)=\frac{1}{4}(2-4x)$



Copyright 2020, Jennifer Hill, DivideandConquerMath.com

**Lesson: Solving Linear Equations with Decimals**

To begin, we will look at 3 examples to demonstrate how to clear decimals without parentheses. Take notes as shown in the video.

a. $0.03x + 0.04 = 0.19$

b. $0.05x + 0.1 - 0.03x = 0.08$



Copyright 2020, Jennifer Hill, DivideandConquerMath.com

Now we will look at 3 examples to demonstrate how to clear decimals with parentheses. Take notes as shown in the video.

a. $0.4(x+2)-0.3(2x+1)=0.09$

b. $0.1x+0.03(4-2x)=0.5(x+3)$



Copyright 2020, Jennifer Hill, DivideandConquerMath.com

**Examples: Solving Linear Equations with Decimals (no parentheses)**

a. $0.1x - 0.06 - 0.2x - 0.04 = 0.3$

b. $0.3x - 0.6 + x - 0.2 = 0.6x - 0.8 + 0.7x$

c. $1 + 0.2x - 0.7 + 2x = 0.5 - 0.4x + 1.8 + 0.6x$



Copyright 2020, Jennifer Hill, DivideandConquerMath.com

**Examples: Solving Linear Equations with Decimals (with parentheses)**

a. $0.4(3x+1)-1.5(2x+1)=0.6(3-3x)$

b. $0.2(3x+1)-0.05(2x+8)=0.1(2x+4)$

c. $0.09(2-4x)-0.1(2x-1)=0.2(2-x)-0.06(2+6x)$



Copyright 2020, Jennifer Hill, DivideandConquerMath.com

**Lesson: Solving Rational Equations**

How do you know that you need to solve a problem versus simplify it?

Explain how to solve the rational equation. Include some instructions in your notes.

$$\frac{2}{x-1}+\frac{1}{x+4}=\frac{4}{x+4}$$



Copyright 2023, Jennifer Hill, DivideandConquerMath.com

What do we have to watch out for when solving rational equations?

**<u>Examples</u>** For the following, which solutions would NOT work for these rational equations?

a. $\frac{4}{x+1} - \frac{2}{x+3} = \frac{5}{x+7}$

b. $\frac{4}{x^2-9} + \frac{3}{x-3} = \frac{2}{x+3}$



Copyright 2023, Jennifer Hill, DivideandConquerMath.com

**<u>Examples</u>** Solve.

a. $1 - \frac{8}{x} = \frac{10}{x}$

b. $\frac{5}{x-3} - \frac{2}{x^2-9} = \frac{5x+13}{x^2-9}$



Copyright 2023, Jennifer Hill, DivideandConquerMath.com

c. $\frac{x^2}{2} = \frac{x^2-6x}{3}$

d. $\frac{4}{x+1} = \frac{10}{x^2-1} - \frac{5}{x-1}$



Copyright 2023, Jennifer Hill, DivideandConquerMath.com

**Solving Equations with Rational Expression**

We will learn how to solve equations that look like this:

$$z = \frac{x+3y}{4w} \quad \text{or} \quad \frac{1}{a} - \frac{2}{b} = \frac{3}{c}$$

**<u>Examples</u>**

a. Solve for y: $z = \frac{3xy}{5w}$

b. Solve for x: $w = \frac{7+2y}{xz}$

c. Solve for z: $y = \frac{4xw}{z-w}$



Copyright 2020, Jennifer Hill, DivideandConquerMath.com

**Examples**

a. Solve for x: $\frac{3}{x} + \frac{1}{y} = \frac{2}{z}$

b. Solve for b: $\frac{1}{a} - \frac{1}{b} = \frac{3}{c}$

c. Solve for z: $\frac{5}{x} - \frac{3}{y} = \frac{7}{z}$



Copyright 2020, Jennifer Hill, DivideandConquerMath.com

**Lesson: Three Ways to Use the LCD with Rational Expressions**

We have spent quite a bit of learning how to find the LCD between rational expressions and then using it in very different ways. We are going to compare the 3 techniques for how we used the LCD in this video.

First, simplify completely:

$$\frac{9}{x+5} - \frac{4}{x+1}$$

Before we begin, should x have a solution? Why or why not?

Now show your work below.

What type of problem is this? How did we leverage the LCD in this case?



Copyright 2023, Jennifer Hill, DivideandConquerMath.com

Simplify completely:

$$\frac{\frac{9}{x+5}-\frac{4}{x+1}}{\frac{10}{x^2+6x+5}-\frac{3}{x+1}}$$

Before we begin, should x have a solution? Why or why not?

Now show your work below.

What type of problem is this? How did we leverage the LCD in this case?



Copyright 2023, Jennifer Hill, DivideandConquerMath.com

Solve:

$$\frac{9}{x+5} - \frac{4}{x+1} = \frac{10}{x^2+6x+5}$$

Before we begin, should x have a solution? Why or why not?

Now show your work below.

What type of problem is this? How did we leverage the LCD in this case?



Copyright 2023, Jennifer Hill, DivideandConquerMath.com

**Example/Question: When Can You Cross Multiply**

Explain what a ratio is:

When can you cross-multiply?

Solve: $\frac{8}{x+2} - \frac{12}{x-4} = \frac{2}{x+2}$. Show that you CANNOT cross-multiply in this situation.

Now show why cross-multiplying works with $-\frac{x}{5} = \frac{3}{x+8}$



Copyright 2021, Jennifer Hill, DivideandConquerMath.com

**Lesson: Applications and Modeling with Linear Equations**

We will revolve a few different types of applications for linear equations.

**Example** Two sides of a triangle have the same length. The third side measures 8 inches less than twice the common length. The perimeter of the triangle of 20 inches. What are the lengths of the three sides?

**Example** Dan ran the 100-m dash with a time of 9.92 seconds. If this pace could be maintained for an entire 26-mile marathon, what would his time be? (Note: 1 m = 3.281 ft, 1 mi = 5280 ft)



Copyright 2022, Jennifer Hill, DivideandConquerMath.com

**Example** Sam earned $25,000 from royalties on his music. He set aside 20% of this for a down payment on a new home. The balance will be used for a new car (eventually). He invested a portion of the money in a CD account (bank certificate of deposit) that earns 2.25%, and the remainder in another CD account that earns 1.75%. If the total interest earned after 1 year is $405, how much money was invested in each account?



Copyright 2022, Jennifer Hill, DivideandConquerMath.com

**Lesson: Applications of Quadratic Equations**

**Example** Find the problem of 2 pairs of 2 consecutive integers whose product is 156.

**Example** You want to buy a rug for a room that is 18ft x 26ft. You want to have a uniform strip of floor around the rug, and you can afford 384 square feet of carpeting. What dimensions should the rug have?



Copyright 2022, Jennifer Hill, DivideandConquerMath.com

**Example** The area of a square is 32 more than its perimeter. Find the length of a side.



Copyright 2022, Jennifer Hill, DivideandConquerMath.com

**Lesson: The Basics of Applications and Word Problems**

As a reminder, here is a review of some of the key words that imply certain operations in math:

| **Words That Imply Addition** | **Words That Imply Subtraction** | **Word That Imply Multiplication** | **Words That Imply Division** |
|---|---|---|---|
| Add | Subtract | Multiplied by | Divided by |
| Increased by | Difference | Times | Quotient of |
| Altogether | Less than | Of | Out of |
| Sum | Fewer | Product of | Ratio |
| Longer than | Decrease | Twice | |
| Plus | Minus | | |
| Above | Take away | | |
| More than | Shorter than | | |

**Example** Juan is memorizing a list of names for a history class quiz. So far, he has memorized 8 of the names, which is one-fourth of the list. How many names are on this list?

**Example** Corey wants to rent a truck for the day. It costs $30 for the base fee, plus $0.23 for each mile driven. When he returned the truck, he owed $41.19. How many miles did he drive?



Copyright 2020, Jennifer Hill, DivideandConquerMath.com

**Example** A café serves both tea and coffee. On Sunday, the café sold 95 teas and coffees combined. The café sold 9 more coffees than teas. How many teas were sold on Sunday?

**Example** Latoya bought a new sweater and a pair of jeans for $64. The jeans cost $8 less than the sweater. How much was the sweater? How much were the jeans?

**Example** There are red, orange, and green balls in a ball pit. There are 12 more orange balls than red balls, and there are 9 more green balls than red balls. How many are there of each color?



Copyright 2020, Jennifer Hill, DivideandConquerMath.com

**Lesson: Consecutive Integer Word Problems**

How do you represent consecutive integers with variables?

**Example** The sum of 2 consecutive integers is 73. Find the integers.

**Example** The sum of 3 consecutive integers is -33. Find the integers.

How do you represent even consecutive integers with variables?

How do you represent odd consecutive integers with variables?

What is noteworthy about how you represent even or odd consecutive integers?



Copyright 2020, Jennifer Hill, DivideandConquerMath.com

**Example** The sum of 2 consecutive even integers is 110. Find the integers.

**Example** The sum of 3 consecutive odd integers is -87. Find the integers.

**Example** Find 3 consecutive odd integers such that their sum is seven more than four times the largest integer.



Copyright 2020, Jennifer Hill, DivideandConquerMath.com

**Lesson: Solving a Linear Equation with Multiple Variables**

**<u>Examples</u>**

a. Solve for x: $x + y = 7$

b. Solve for y: $4y = z$

c. Solve for a: $3a - 6b = 2c$

d. Solve for b: $4a + 8b = 16c$

e. Solve for k: $\frac{1}{3}k = m$

f. Solve for a: $3(a - 2b) = 6c$

g. Solve for b: $\frac{2}{3}(3a + 2b) = c$

h. Solve for a: $-\frac{2}{5}(2a - 4b) = 4$



Copyright 2020, Jennifer Hill, DivideandConquerMath.com

**Lesson: Ratios and Proportions**

What is a ratio?

**Example** The unit price of an item is the ratio of the price of an item to the amount of the item. Find the unit price if 5oz of peanuts costs $1.

**Example** Express the ratio of 12 boys to 14 girls.

What is a proportion?

**Examples** Solve the following proportions:

a. $\frac{x}{5} = \frac{6}{10}$

b. $\frac{x+2}{12} = \frac{x-4}{8}$



Copyright 2020, Jennifer Hill, DivideandConquerMath.com

**Examples: Proportions**

a. $\frac{3}{x} = \frac{9}{21}$

b. $\frac{3x+10}{15} = \frac{2}{5}$

c. $\frac{2x-1}{6} = \frac{4x}{10}$



Copyright 2020, Jennifer Hill, DivideandConquerMath.com

**Lesson: Proportion Word Problems**

It 3 cookies cost $1.36, how much will 7 cookies cost?

At a motorcycle race, the ratio of parents to children was 5 to 3. If 500 children attended the motorcycle race, how many parents were at the race?

One euro is equivalent to $1.18 US dollars. How many euro would you get for $25?



Copyright 2020, Jennifer Hill, DivideandConquerMath.com

**Lesson: Distance, Rate, and Time Problems**

Two cars leave Glen Ellyn, IL, with one driving north and the other driving south. The northbound car is traveling 8mph faster than the southbound car, and after 2 hours they are 420 miles apart. Find the speed of each car.

Marshall and Lilly live together. Marshall leaves the house at 2pm, and then Lilly leaves the house at 2:30pm. If Marshall is driving 30 mph and Lilly is driving 35 mph in the same direction, how long will it be until their cars meet?

A Lamborghini and a Ferrari pass one another at noon on a highway in California. The cars are going opposite directions. If the Lamborghini is traveling 75 mph, and the Ferrari is traveling 80 mph, how long will it take for the cars to be 310 miles away from one another?



Copyright 2020, Jennifer Hill, DivideandConquerMath.com

**Lesson: Money Word Problems**

Sarah has five more nickels than quarters. When combined, the coins are worth $4.75. How many nickels and quarters does she have?

Maria has $75 worth of $1 and $5 bills. In total, she has 27 bills. How many $5 bills does she have?

Tickets at the movie theater course $15 for an adult and $10 for a child. In the last hour, sales were $550. How many adult tickets versus child tickets were sold?



Copyright 2020, Jennifer Hill, DivideandConquerMath.com

**Lesson: Applications of Quadratic Equations**

The area of a rectangle is 15ft squared, and the length of the rectangle is 7ft less than twice the width. Find the dimensions of the rectangle.

An 12ft ladder leans against the side of a house. The bottom of the ladder is 6ft from the side of the house. How high is the top of the ladder from the ground? If necessary, round your answer to the nearest tenth.

A kite flying in the air has a 14ft line attached to it. Its line is pulled taut and casts a 9ft shadow. Find the height of the kite. If necessary, round your answer to the nearest tenth.



Copyright 2020, Jennifer Hill, DivideandConquerMath.com

The longer leg of a right triangle is 2in longer than the shorter leg. The hypotenuse is 4in longer than the shorter leg. Find the side lengths of the triangle.



Copyright 2020, Jennifer Hill, DivideandConquerMath.com

**Solving Formulas with Squares and Square Roots**

In this lesson, we will look at how to solve for formulas that look like this:

$$y = 3x^2 \qquad \text{or} \qquad M = \sqrt{\frac{AB}{C}} \qquad \text{or} \qquad kx^2 + cx - n = 0$$

**Solving Formulas with Squares**

Solve the following for the indicated letters:

a. for x: $y = \frac{4x^2}{z}$

b. for k: $b = \frac{3}{k^2}$



Copyright 2020, Jennifer Hill, DivideandConquerMath.com

**Solving Formulas with Square Roots**

Solve the following for the indicated letters:

a. for b: $a = \sqrt{\frac{b}{c}}$

b. for z: $x = \sqrt{\frac{3y}{z}}$



Copyright 2020, Jennifer Hill, DivideandConquerMath.com

**Solving Formulas in other forms**

Solve the following for the indicated letters:

a. for x: $kx^2 + cx - d = 0$

b. for b: $ab^2 - 5b + m = 0$

c. for k: $\frac{1}{2}k^2 - 5nk + m = 0$



Copyright 2020, Jennifer Hill, DivideandConquerMath.com

**Solving Applications of Quadratic Equations**

An object is thrown upwards off a cliff that is 48 feet above the ground. The height of the object t seconds after the object is released is given by:

$$h = -16t^2 + 32t + 48$$

How long does it take the object to hit the ground?

How long does it take the object to reach a height of 20 feet?



Copyright 2020, Jennifer Hill, DivideandConquerMath.com

A 12 ft by 16 ft pond is going to be surrounded by a border of grass of uniform width all the way around. If the area of the enclosure must be 480 feet squared, what is the width of the grass border?



Copyright 2020, Jennifer Hill, DivideandConquerMath.com

**How to Evaluate Square Roots that Have Imaginary Number Answers and Dealing with Negatives in Square Roots**

In this video, we will look at how to evaluate things like this:

$\sqrt{-4}$ or $\sqrt{-12}$ or $\sqrt{-3} * \sqrt{-6}$

What is an imaginary number?

What is a complex number?

How do you evaluate something like $\sqrt{-9}$?

**<u>Examples</u>** Compute the following:

a. $\sqrt{-25}$

b. $\sqrt{-81}$

c. $\sqrt{-12}$

d. $\sqrt{-7}$

e. $\sqrt{-\frac{25}{16}}$

f. $\sqrt[3]{-8}$

g. $\sqrt[4]{-16}$

h. $\sqrt{-32}$



Copyright 2020, Jennifer Hill, DivideandConquerMath.com

How do you evaluate problems like $\sqrt{-3} * \sqrt{-2}$?

**<u>Examples</u>** Evaluate the following:

a. $\sqrt{-6} * \sqrt{-5}$

b. $\sqrt{-6} * \sqrt{-2}$

c. $\sqrt{-10} * \sqrt{-15}$

d. $\frac{\sqrt{-6}}{\sqrt{-2}}$

e. $\frac{\sqrt{-50}}{\sqrt{-2}}$

f. $\frac{\sqrt{-7}}{\sqrt{-2}}$



Copyright 2020, Jennifer Hill, DivideandConquerMath.com

**Operations with Imaginary Numbers**

In this video, we will look at how to evaluate things like this:

$2i(3i-5)$ or $(4i+1)-(5i+3)$ or $\frac{4}{3+2i}$

**Adding and Subtracting with Imaginary Numbers:**
Use the example $(2i+3)+(5i-6)$ to show how to add or subtract with imaginary numbers.

**<u>Examples</u>** Simplify:
a. $(3i-2)-(4i-9)$

b. $(5i+3)+(2i-1)$

What can we say about $i^2$?



Copyright 2020, Jennifer Hill, DivideandConquerMath.com

With that in mind, explain what is unique about multiplying: $2i(3i+1)$

**<u>Examples</u>** Simplify:

a. $4(2-3i)$

b. $6i(3i+2)$

c. $5i(2-8i)$

d. $(5i+1)(2i-3)$

e. $(4i-3)(6i+7)$



Copyright 2020, Jennifer Hill, DivideandConquerMath.com

**Examples** Simplify:

a. $(5i + 2)^2$

b. $(3i - 5)^2$

Why do you need to rationalize $\frac{3}{2i+1}$? Explain how to do this.

**Examples** Rationalize the following:

a. $\frac{4}{2i+6}$

b. $\frac{7}{i+3}$



Copyright 2020, Jennifer Hill, DivideandConquerMath.com

**Examples** Rationalize the following:

a. $\frac{3i+1}{5i-2}$

b. $\frac{7i+3}{2i+1}$

c. $\frac{i-3}{5i+3}$



Copyright 2020, Jennifer Hill, DivideandConquerMath.com

**Evaluating Higher Powers of Imaginary Numbers**

In this video, we will look at how to evaluate things like this:

$i^{21}$ or $i^{54}$

First we need to investigate the powers of $i$ and the patterns with it. Write this down below:

Now that we can see a pattern, explain how to evaluate the following:

$i^{15}$

$i^{22}$



Copyright 2020, Jennifer Hill, DivideandConquerMath.com

**<u>Examples</u>** Evaluate the following:

a. $i^{36}$

b. $i^{43}$

c. $i^{52}$

d. $i^{33}$

e. $i^{25}$



Copyright 2020, Jennifer Hill, DivideandConquerMath.com

**Lesson: A Review of Imaginary Numbers**

*Please note:* Knowing imaginary numbers if one of the "prerequisite" topics for this course. Ie – you should already know this (though I also realize you probably need a review!). If you have *never* seen imaginary numbers before, then I strongly suggest that you watch my series on imaginary numbers (because, yes, I have one). So if you felt like this went too fast and you want more details, please take responsibility for your education and go back to review this!

How do we represent an imaginary number?

What is $i^2$?

What is a complex number?

When are 2 complex numbers equal?

What does $\sqrt{-a}$ mean?

**Examples** Write using the definition of $\sqrt{-a}$

a. $\sqrt{-12}$

b. $\sqrt{-25}$



Copyright 2021, Jennifer Hill, DivideandConquerMath.com

**Examples** Complete the following operations.

a. $\sqrt{-5} * \sqrt{-3}$

b. $\frac{\sqrt{-12}}{\sqrt{-18}}$

c. $\frac{\sqrt{-50}}{\sqrt{9}}$

To add or subtract complex numbers, we can add/subtract the real parts and the imaginary parts similar to working with like terms.

**Examples** Find the sum or difference.

a. $(2 - 6i) + (8 + 2i)$

b. $(5 - 7i) - (-4 + 2i)$



Copyright 2021, Jennifer Hill, DivideandConquerMath.com

When multiplying complex numbers, recall that $i * i = i^2 = -1$!

**<u>Examples</u>** Multiply.

a. $(2 + 4i)(3 - 5i)$

b. $(4 - 5i)(3 - 2i)$

c. $(3 + 2i)(3 - 2i)$

Recall, the conjugate is found by using the opposite side for the second term!

**<u>Examples</u>** What is the conjugate of the following?

a. $4 + 2i$

b. $-3 - 4i$

c. $i$



Copyright 2021, Jennifer Hill, DivideandConquerMath.com

To find the quotient of 2 complex numbers, we multiply by the conjugate of the denominator.

**Examples** Find each quotient. Write your answer in *standard form,* ie $a + bi$ form

a. $\frac{3-4i}{2+i}$

b. $\frac{5}{i}$

How do the powers of $i$ cycle through?

**Examples** Show how to simplify the following powers of i. Write your work in great detail so that you remember how to do this!

| | |
|---|---|
| a. $i^{17}$ | c. $i^{-14}$ |
| b. $i^{28}$ | d. $i^{-5}$ |



Copyright 2021, Jennifer Hill, DivideandConquerMath.com

**<u>Examples</u>** The following quadratic equations have imaginary solutions. Show how to solve them.

a. $x^2 = -25$ using the **square root property**

b. $x^2 + 75 = 0$ using the **square root property**

c. $2x^2 - 3x = -6$ using the **quadratic formula**

d. $x^4 - 16$ using **factoring** and also the **square root property**



Copyright 2021, Jennifer Hill, DivideandConquerMath.com

**Lesson: A Quick Review of How to Solve Quadratic Equations**

What is the form of a quadratic equation?

How is this different from a quadratic function?

What are the 4 ways you can solve a quadratic equation?

Which technique should you use when solve a quadratic equation?

We will review these 4 techniques on the next page!

What type of answers are possible when you solve a quadratic equation?



Copyright 2022, Jennifer Hill, DivideandConquerMath.com

**Example** Show how to use each of the 4 different techniques for solving quadratic equations by using each one at most once for the following examples.

a. $5x^2 + 6x + 1 = 0$

b. $(x + 4)^2 = 12$

c. $x^2 - 4x + 8 = 0$

d. $x^2 - 5x + 1 = 0$



Copyright 2022, Jennifer Hill, DivideandConquerMath.com

Optional extra help: If you need a more thorough (and more complete) review of the methods we discussed today, watch these:

- A review of ALL the different types of factoring (just factoring, nothing about solving quadratic equations): https://youtu.be/nrI7dJRXe5I and https://youtu.be/yGY5eqZkJcw
- How to solve a quadratic equations by factoring: https://youtu.be/5uof6OEyod0
- How to solve quadratic equations by the square root property: https://youtu.be/a1-smI3Xx5w
- How to solve quadratic equations by completing the square: https://youtu.be/6jXpMTozmhI
- How to solve quadratic equations by the quadratic formula: https://youtu.be/ryp2rdkhks8
- A review that compares all the techniques on the same problem: https://youtu.be/2ny9HbQ8doY



Copyright 2022, Jennifer Hill, DivideandConquerMath.com

**A Quick Refresher of the 4 Ways to Solve Quadratics**

For all of these examples, we will solve $x^2 + 6x + 5 = 0$.

**Solving by Factoring**

**Solving by Completing the Square**

**Solving by Using the Quadratic Formula**

The quadratic formula is: $\frac{-b \pm \sqrt{b^2 - 4ac}}{2a}$



Copyright 2020, Jennifer Hill, DivideandConquerMath.com

One final way we can solve quadratics is by using the square root property.
Use the square root property to solve $(x+3)^2 = 12$



Copyright 2020, Jennifer Hill, DivideandConquerMath.com

**Choosing the Best Method to Solve a Quadratic**

There are 4 ways we can solve quadratics:

1.

2.

3.

4.

Using each of these methods only once, determine the best way to solve these quadratics:

a. $x^2 + 6x = 2$
b. $x^2 + 3 = 2x$
c. $(2x + 1)^2 = 49$
d. $3x^2 + 2 = 3x$



Copyright 2020, Jennifer Hill, DivideandConquerMath.com

**<u>Examples</u>** Using each of these methods only once, determine the best way to solve these quadratics:

a. $(3x-2)^2=-24$

b. $2x^2+5x-1=0$

c. $x^2-12=x$

d. $x^2-2x+5=0$



Copyright 2020, Jennifer Hill, DivideandConquerMath.com

**Lesson: A Quick Review of The Discriminant**

What is the discriminant?

Fill in the table below:

| If the discriminant is … | How many solutions are there? | What type of solution? |
|---|---|---|
| **Positive and a perfect square** | | |
| **Positive (not perfect square)** | | |
| **Zero** | | |
| **Negative** | | |

**Example** Use the discriminant to determine how many solutions there are to: $x^2 - 4 = 0$.

**Example** Use the discriminant to determine how many solutions there are to: $x^2 + 6x + 9 = 0$.



Copyright 2022, Jennifer Hill, DivideandConquerMath.com

**Lesson: Solving for Quadratic Variables**

**<u>Example</u>** Solve for t: $s = \frac{1}{2}gt^2$

**<u>Examples</u>** Solve for x: $kx^2 - tx = m$



Copyright 2022, Jennifer Hill, DivideandConquerMath.com

**Solving Quadratic Equations with Factoring**

In this video, we will look at how to solve equations by factoring, which looks like this:

$$x^2 + 5x + 6 = 0 \rightarrow (x + 2)(x + 3) = 0$$

Quadratic equations are equations of the form:

Where a, b, and c are real numbers and $a \neq 0$.

How would you solve the quadratic equation $x^2 + 7x + 6 = 0$ by factoring?

**<u>Examples</u>** Solve the following by factoring:

a. $x^2 - x - 12 = 0$

b. $x^2 + 9 = -6x$

c. $x^2 = 25$



Copyright 2023, Jennifer Hill, DivideandConquerMath.com

**<u>Examples</u>** Solve the following by factoring:

a. $x^2 + 7x = 0$

b. $\frac{1}{10}x^2 + \frac{1}{2}x + \frac{3}{5} = 0$

c. $2x^3 + 28x^2 + 90x = 0$



Copyright 2023, Jennifer Hill, DivideandConquerMath.com

**Solving Quadratic Equations using the Square Root Property**

In this video, we will look at how to solve equations by using the square root property, which looks like this:

$$(x+2)^2 = 9 \quad \rightarrow \quad x+2 = \pm 3$$

Quadratic equations are equations of the form $ax^2 + bx + c = 0$ where a, b, and c are real numbers and $a \neq 0$.

What are the solutions to $x^2 = 25$?

In general, how do you solve equations of the form $Q^2 = k$, where Q is an expression and k is a constant? In other words, what is the **square root property**?

**<u>Examples</u>** Solve the following equations using the square root property:

a. $(x+3)^2 = 25$

b. $(x+3)^2 = 12$



Copyright 2020, Jennifer Hill, DivideandConquerMath.com

**Examples** Solve the following equations using the square root property:

a. $(5x-2)^2+5=29$

b. $(6x+7)^2+4=-41$



Copyright 2020, Jennifer Hill, DivideandConquerMath.com

**Solving Quadratic Equations by Completing the Square**

In this video, we will look at how to solve equations by factoring, which looks like this:

$x^2 + 6x = 7 \qquad b = 6, \quad \frac{1}{2}b = 3, \quad \left(\frac{1}{2}b\right)^2 = 9$

Quadratic equations are equations of the form $ax^2 + bx + c = 0$ where a, b, and c are real numbers and $a \neq 0$.

Before we begin, you should be familiar with the square root property. Solve $(2x + 1)^2 = 49$ using the square root property.

First let's talk about how to complete the square. Show how to complete the square on $x^2 + 6x$ below:



Copyright 2020, Jennifer Hill, DivideandConquerMath.com

**Examples** Complete the square on the following:

a. $x^2 + 8x$

b. $x^2 - 10x$

c. $x^2 + 3x$

d. $x^2 - \frac{1}{2}x$

e. $x^2 + \frac{2}{3}x$



Copyright 2020, Jennifer Hill, DivideandConquerMath.com

Show how to solve $2x^2 + 12x - 16 = 0$ by completing the square:



Copyright 2020, Jennifer Hill, DivideandConquerMath.com

**Examples** Solve the following by completing the square:

a. $x^2 + 4x - 6 = 0$

b. $x^2 + 5 = 2x$



Copyright 2020, Jennifer Hill, DivideandConquerMath.com

**Examples** Solve the following by completing the square:

a. $3x^2 + 15x = -6$

b. $\frac{1}{2}x^2 + 3x - 2 = 0$



Copyright 2020, Jennifer Hill, DivideandConquerMath.com

**Examples: The Distance Formula**

Find the distance between the following sets of points.

a. (6, 2) and (2, 11)

b. (3, -1) and (-4, -2)



Copyright 2023, Jennifer Hill, DivideandConquerMath.com

**Solving Quadratic Equations by the Quadratic Formula**

Complete the square on: $ax^2 + bx + c = 0$

State the quadratic formula:



Copyright 2020, Jennifer Hill, DivideandConquerMath.com

**Examples** Use the quadratic formula to solve the following:

a. $x^2 + 3x + 2 = 0$

b. $2x^2 + 3x = 5$

c. $\frac{1}{2}x^2 + \frac{1}{3}x + \frac{5}{6} = 0$



Copyright 2020, Jennifer Hill, DivideandConquerMath.com

**Lesson: The Discriminant**

Restate the Quadratic Formula, and then label the discriminant.

| Value of the Discriminant | Interpretation |
|---|---|
| | |
| | |
| | |
| | |



Copyright 2023, Jennifer Hill, DivideandConquerMath.com

**Examples** Find the values of the discriminant for the following equations. Then solve the equations (using the most efficient method) to determine if this makes sense.

a. $x^2 - 4x + 4 = 0$

b. $x^2 + 6x + 5 = 0$

c. $3x^2 + 2x + 5 = 0$



Copyright 2023, Jennifer Hill, DivideandConquerMath.com

**Solving Equations that End Up Having Quadratics**

In this lesson, we will review some techniques from previous lessons.

Solve $\frac{2}{x} - \frac{1}{x+1} = \frac{2}{3}$

Solve $\sqrt{2x+8} = x + 4$



Copyright 2020, Jennifer Hill, DivideandConquerMath.com

**<u>Examples</u>** Solve the following:

a. $\frac{4}{x-2}+\frac{x}{x-3}=\frac{2}{x-3}$

b. $\sqrt{3x+5}=x-3$



Copyright 2020, Jennifer Hill, DivideandConquerMath.com

**Solving Equations that Are Similar to Quadratics**

In this lesson, we will look at how to solve equations that look like this:

$$x^{\frac{2}{3}} - x^{\frac{1}{3}} - 12 = 0 \qquad \text{or} \qquad (2x+3)^2 + 5(2x+3) + 6 = 0$$

Before we begin, what do the following equations have in common if you **look at their exponents**?

a. $x^2 + 5x + 6 = 0$

b. $x^{\frac{2}{3}} + 5x^{\frac{1}{3}} + 6 = 0$

c. $x + 5x^{\frac{1}{2}} + 6 = 0$

d. $x^4 + 5x^2 + 6 = 0$

Explain how to solve $x^4 - 13x^2 + 36 = 0$



Copyright 2020, Jennifer Hill, DivideandConquerMath.com

**<u>Examples</u>** Solve the following:

a. $x^{\frac{2}{3}} - 2x^{\frac{1}{3}} - 15 = 0$

b. $x - 2x^{\frac{1}{2}} - 8 = 0$

d. $x^{-2} + 8x^{-1} - 9 = 0$



Copyright 2020, Jennifer Hill, DivideandConquerMath.com

**Examples** Solve the following:

a. $(x+3)^2 - 4(x+3) - 5 = 0$

b. $(2x+1)^2 - 4(2x+1) - 21 = 0$



Copyright 2020, Jennifer Hill, DivideandConquerMath.com

**Lesson: Solving Rational Equations**

Rational equations are equations that look like:

$\frac{2x}{x+1} - \frac{3}{x} = \frac{5}{x+1}$ or $\frac{3}{x^2-4} + \frac{2}{x^2+4x+4} = \frac{5}{x-2}$

What is the general strategy for solving a rational equation?

What do you have to watch out for with rational equations?

**<u>Examples</u>** Solve each equation.

a. $\frac{x}{x-4} - 4 = \frac{4}{x-4}$

b. $\frac{3}{x+2} + \frac{10}{x^2-6x-16} = \frac{5}{x-8}$



Copyright 2022, Jennifer Hill, DivideandConquerMath.com

**Examples** Solve each equation.

a. $-\frac{14}{3x^2+15x-18}=\frac{x}{x-1}+\frac{2}{3x+18}$

b. $\frac{x}{x^2+4x-32}+\frac{2}{x^2-14x+40}=\frac{6}{x^2-2x-80}$



Copyright 2022, Jennifer Hill, DivideandConquerMath.com

**Lesson: A Review of Solving Radical Equations and Equations with Rational Exponents**

What is the general strategy with solving radical equations?

What do you have to watch out for when solving radical equations?

**<u>Examples</u>** Solve each equation.

a. $x - 3\sqrt{x+2} = 2$

b. $\sqrt{6x+7} - 9 = x - 7$



Copyright 2022, Jennifer Hill, DivideandConquerMath.com

**<u>Examples</u>** Solve: $\sqrt{3x+4}-5=\sqrt{3x-11}$



Copyright 2022, Jennifer Hill, DivideandConquerMath.com

**Example** Solve each equation.

a. $\sqrt[3]{2x+1} = \sqrt[3]{3x+5}$

b. $\sqrt[4]{x+3} = 2$

**Example** Solve each equation.

a. $x^{\frac{5}{4}} = 32$

b. $(2x+1)^{\frac{2}{3}} = 36$



Copyright 2022, Jennifer Hill, DivideandConquerMath.com

**<u>Example</u>** Solve for x: $y = k\sqrt{x}$



Copyright 2022, Jennifer Hill, DivideandConquerMath.com

**Lesson: A Review of Solving Equations Quadratic in Form (Using Substitution)**

**<u>Examples</u>** Solve each equation.

a. $x^4 - 10x^2 + 9 = 0$

b. $(x+1)^{\frac{2}{5}} - 3(x+1)^{\frac{1}{5}} + 2 = 0$

c. $x^{-\frac{2}{3}} - x^{-\frac{1}{3}} - 6 = 0$



Copyright 2022, Jennifer Hill, DivideandConquerMath.com

**Solving Equations with Radicals**
**Part 1: One Square Root in the Equation**

In this video, we will look at how to solving equations like this:

$$\sqrt{3x+1} = 2 \qquad \text{or} \qquad \sqrt{4x-2} = 5 - x$$

Use the example $\sqrt{3x+1} = 4$ to show the general procedure for solving these types of equations:

Why must we check the solutions?

**<u>Example</u>** Solve $\sqrt{3x+1} = 8$



Copyright 2020, Jennifer Hill, DivideandConquerMath.com

**Examples** Solve

a. $\sqrt{5x-4}+2=8$

b. $\sqrt{1+3x}+5=2$

Explain what is different about solving $\sqrt{5x+4}=x+2$



Copyright 2020, Jennifer Hill, DivideandConquerMath.com

**Examples** Solve the following.

a. $\sqrt{3x-6} = x - 2$

b. $\sqrt{2x+4} = x - 2$

c. $\sqrt{5x+1} + 5 = 3x$



Copyright 2020, Jennifer Hill, DivideandConquerMath.com

**Solving Equations with Radicals**
**Part 2: Two Square Roots in the Equation**

In this video, we will look at how to solving equations like this:

$$\sqrt{4x-2} = 3\sqrt{2x+6} \qquad \text{or} \qquad \sqrt{3x-1} + 2 = \sqrt{4x-2}$$

Let's begin by explaining how to solve: $\sqrt{5x+2} = \sqrt{3x+6}$

**Example**s Solve:

a. $\sqrt{3-2x} = \sqrt{2x+7}$

b. $\sqrt{5+3x} = \sqrt{3+2x}$

c. $4\sqrt{3-2x} = 2\sqrt{1+3x}$



Copyright 2020, Jennifer Hill, DivideandConquerMath.com

**Example** Solve: $6\sqrt{x} = 4\sqrt{2x+1}$

Now write out the detailed explanation of how to solve $\sqrt{4x+1} - 2 = \sqrt{2x+1}$



Copyright 2020, Jennifer Hill, DivideandConquerMath.com

**Examples** Solve:

a. $\sqrt{3x+6} = 2 + \sqrt{2x-4}$

b. $\sqrt{3x+1} = 2 + \sqrt{2x-2}$



Copyright 2020, Jennifer Hill, DivideandConquerMath.com

**Examples** Solve:

a. $\sqrt{2x+4}+\sqrt{1-2x}=3$

b. $\sqrt{2x+4}=2+\sqrt{2x+3}$



Copyright 2020, Jennifer Hill, DivideandConquerMath.com

**Solving Equations with Radicals**
**Part 3: Two Cube Roots of Higher in the Equation**

In this video, we will look at how to solving equations like this:

$$\sqrt[3]{3x+1} = 2 \qquad \text{or} \qquad \sqrt[4]{2x-1} = 5$$

Explain how to solve: $\sqrt[3]{3x+1} = 2$

Explain how to solve: $\sqrt[4]{3x+4} = 2$

When is it more likely a solution will not work?



Copyright 2020, Jennifer Hill, DivideandConquerMath.com

**Examples** Solve the following:

a. $\sqrt[3]{4x+7} = 3$

b. $\sqrt[3]{3-5x} = 2$

c. $\sqrt[4]{3-2x} = 3$

d. $\sqrt[4]{4x-1} = -7$



Copyright 2020, Jennifer Hill, DivideandConquerMath.com

**Rational Expression Applications**
**Video 1: Proportion Type Problems**

What is a proportion?

A bakery can make 300 cookies in 1.5 hours. How long would it take to make 525 cookies?

The ratio of patrons at a café who purchase coffee versus those who purchase tea is 5 to 3. On Monday, the café sold 45 teas. How many coffees were sold?



Copyright 2020, Jennifer Hill, DivideandConquerMath.com

A painter makes a particular shade of orange by using 3 parts red and 4 parts yellow. The painter has four more gallons of yellow paint than he has of red paint. How many gallons of red paint should he use?



Copyright 2020, Jennifer Hill, DivideandConquerMath.com

**Rational Expression Applications**
**Video 3: Work Problems**

What is the setup for work problems?

It takes Maria 3 hours to paint a room, while it takes her younger sister Lupe 5 hours to paint the same room. How long would it take if the girls painted the room together?

It takes Max 30 minutes to shovel the driveway, while it takes his brother Darrell 45 minutes to do the same job. How long would it take for the guys to do it together?



Copyright 2020, Jennifer Hill, DivideandConquerMath.com

**Rational Expression Applications**
**Video 2: Distance, Rate, and Time Problems**

In these types of problems, we need to use the equation:

$$d = rt$$

Where d=distance, r=rate/speed of a vehicle, and t=time

We can also see that we can rearrange this formula in a few ways:

A boat travels 30 miles downstream in the same time that it takes to travel 20 miles upstream. The current of the river is 5mph. How fast would the boat travel in still water?



Copyright 2020, Jennifer Hill, DivideandConquerMath.com

A boat travels 16 miles downstream in the same time that it travels 12 miles upstream. In still water, the boat can travel 6mph. What is the speed of the current?

A plane travels 550 miles with the wind. In the same amount of time, it travels 375 miles against the wind. If the wind is blowing at a speed of 25 mph, what is the speed of the plane when there is no wind?



Copyright 2020, Jennifer Hill, DivideandConquerMath.com

**Lesson: A Review of Basic Inequalities**

Please check out the examples video on how to graph on a number line, use interval notation, or use set notation in case you forgot!

**The Inequality Signs**

$<$ Less than

$\leq$ Less than or equal to

$>$ Greater than

$\geq$ Greater than or equal to

**The Properties of Inequalities**

If a, b, and c are real numbers then:

1. If $a < b$, then $a + c < b + c$

2. If $a < b$ and $c > 0$ then $ac < bc$

3. If $a < b$ and $c < 0$, then $ac > bc$

These properties also hold if you switch to $>, \leq, \geq$

**<u>Examples</u>** Solve the following. Put your final answer in interval notation.

$-2x + 8 < 10$



Copyright 2022, Jennifer Hill, DivideandConquerMath.com

**<u>Examples</u>** Solve the following. Put your final answer in interval notation.

a. $-\frac{1}{3}(x+3)+\frac{1}{3}x+\frac{2}{5}x \leq \frac{1}{10}$

b. $-5 \leq 1+2x < 13$

c. $2 \leq -6x-3 < 9$



Copyright 2022, Jennifer Hill, DivideandConquerMath.com

**Lesson: Quadratic Inequalities**

A quality inequality is an inequality in the form: $ax^2 + bx + c < 0$ where a, b, and c are real numbers. You can interchange $<$ with $\leq, >, \geq$.

There are 3 steps to solving a quadratic inequality. Write out each step as you solve the next example.

**<u>Example</u>** Write out the steps that you use to solve the following: $x^2 - x - 6 > 0$. Write your answer in interval notation.

Explain Step 1:

Explain Step 2:

Explain Step 3:



Copyright 2022, Jennifer Hill, DivideandConquerMath.com

**Example** Solve: $3x^2 - 4 \leq x$. Write your answer in interval notation.

**Example** Solve $x^2 \geq 25$. Write your answer in interval notation.



Copyright 2022, Jennifer Hill, DivideandConquerMath.com

**Lesson: Rational Inequalities**

Rational inequalities look like this:

$\frac{5}{x+3} > 3$ or $\frac{2x+5}{4x-1} \leq 2$

We will out the steps to solve a rational inequality by using the following example.

**<u>Example</u>** Solve $\frac{4}{x+2} \geq 6$ Put your final answer in interval notation.

Explain Step 1 and show how to do it:

Explain Step 2 and show how to do it:

Explain Step 3 and show how to do it:



Copyright 2022, Jennifer Hill, DivideandConquerMath.com

What do you have to watch out for with rational inequalities?

**<u>Example</u>** Solve $\frac{3}{x+6} \leq 2$ Put your final answer in interval notation.

**<u>Example</u>** Solve $\frac{x+3}{x-5} \geq 1$ Put your final answer in interval notation.



Copyright 2022, Jennifer Hill, DivideandConquerMath.com

**Lesson: Number Lines, Interval Notation, and Set Notation**

Show how to set up the number line, interval notation, and set notation for the following:

a. $x > 5$

b. $x \leq 7$

c. $x \geq 0$

d. $-3 < x < 5$

e. $-7 \leq x < -1$

f. $3 < x \leq 8$



Copyright 2020, Jennifer Hill, DivideandConquerMath.com

**Lesson: How to Solve Linear Inequalities in One Variable**

Linear inequalities in one variable have the form $ax + b < 0$. Alternatively, they could use the symbol $\leq, >, \geq$.

Solving linear inequalities has some similarities and some differences when compared to solving for linear equations.

**The Addition and Subtraction Properties**

Let a, b, c be real numbers. If $a < b$, then:

This also holds for $\leq. >, \geq$

**<u>Examples</u>** Solve the following. Put your final answer both on a number line and in interval notation.

a. $x + 4 > 9$

b. $x - 8 \leq 12$



Copyright 2020, Jennifer Hill, DivideandConquerMath.com

**The Multiplication and Division Properties**

Let a, b, c be real numbers. If $a < b$, then:

- if c is positive ($c > 0$):

- if c is negative ($c < 0$)

This also holds for $\leq . >, \geq$

Why is this rule different? Use the following example.

To begin, is $-2 < 4$ a true statement? True False

Now multiply both sides of the inequality by 3 and write down the new result below:

This new statement is True False

Now multiply both sides of the inequality by -3 and write down the new result below:

This new statement is True False

Now divide both sides of the inequality by -2 and write down the new result below:

This new statement is True False



Copyright 2020, Jennifer Hill, DivideandConquerMath.com

**Examples** Solve the following. Put your final answer both on a number line and in interval notation.

a. $3x \leq 15$

b. $-2x > 8$

c. $5x < -10$

d. $-4x \geq -12$

e. $-9x \leq 27$



Copyright 2020, Jennifer Hill, DivideandConquerMath.com

From here, you can start to combine the rules to solve more types of inequalities.

**<u>Examples</u>** Solve the following. Put your final answer both on a number line and in interval notation.

a. $2x - 4 < 6$

b. $3x + 7 > 5x - 9$

c. $\frac{1}{2}x + \frac{1}{5} > \frac{3}{4}x + \frac{7}{10}$



Copyright 2020, Jennifer Hill, DivideandConquerMath.com

**Examples: Solving Linear Inequalities – Basic Examples**

Solve the following. Put your final answer both on a number line and in interval notation.

a. $2x + 7 \geq 13$

b. $4x - 6 < 6x - 10$

c. $3(5 - 2x) > 5(3 + 2x)$

d. $2(4 - 2x) - 3(4 - 4x) \leq 4(3x + 3)$



Copyright 2020, Jennifer Hill, DivideandConquerMath.com

**Examples: Solving Linear Inequalities – Examples with Fractions Decimals**

Solve the following. Put your final answer both on a number line and in interval notation.

a. $\frac{1}{3}x - \frac{1}{5} \leq \frac{1}{3} + \frac{2}{5}x$

b. $0.03x + 0.2 > 0.02$

c. $\frac{3}{5}(2x - 1) - \frac{3}{4}(2 - 3x) < \frac{1}{10}(4 - 3x)$

d. $0.2(2x - 4) + 0.03(6 - 10x) \geq 0.06(x + 9)$



Copyright 2020, Jennifer Hill, DivideandConquerMath.com

**Lesson: Three-Part Inequalities**

Show how to solve the following three-part inequalities. Put your final answer both on a number line and in interval notation.

a. $4 < x + 2 \leq 10$

b. $-3 \leq 2x - 1 < 11$

c. $-5 < 3x + 4 < 19$

d. $4 \leq -1 - 5x < 14$



Copyright 2020, Jennifer Hill, DivideandConquerMath.com

**Lesson: The Basics of Compound Inequalities**

The word "and" has special implications in mathematic. One place it is often used is with sets, and we represent "and" with the intersection symbol ∩.

The word "or" also has special implications in mathematic. It is also used is with sets, and we represent "or" with the intersection symbol ∪.

**<u>Examples</u>** Given $A = \{1, 2, 3, 4, 5\}, B = \{2, 4, 6, 8, 10\}, C = \{1, 3, 5, 7\}$, find the following:

a. $A \cap B$

b. $A \cap C$

c. $A \cup C$

d. $B \cup C$

We use similar ideas with compound inequalities.

Show how to represent a solution to $x \geq -2$ and $x < 5$

**<u>Example</u>** Represent the following with a number line and interval notation.

a. $x > 0$ and $x \leq 7$

b. $x > 8$ and $x \leq -2$



Copyright 2020, Jennifer Hill, DivideandConquerMath.com

Show how to represent a solution to $x \geq 4$ or $x < -3$

**<u>Example</u>** Represent the following with a number line and interval notation.

a. $x \leq 0$ or $x > 5$

b. $x > 0$ or $x \leq 5$

We can create more complicated problems where we first have to isolate x, but then we can represent in the same manner as shown above.

**<u>Example</u>** Represent the following with a number line and interval notation.

$3x - 1 > 5$ and $5x + 4 \leq 24$



Copyright 2020, Jennifer Hill, DivideandConquerMath.com

**Examples: Compound Inequalities**

Put your final answer both on a number line and in interval notation.

a. $x - 4 > 8$ or $x + 2 < -3$

b. $2x + 1 \geq 7$ and $5x - 10 < 20$

c. $4x + 2 > 18$ or $3x - 1 < 17$



Copyright 2020, Jennifer Hill, DivideandConquerMath.com

d. $2 - 3x > 8$ and $5x - 2 > 12$

e. $5x + 9 < 16$ or $4 - 3x > 14$

f. $3 - 2x > 9$ and $5 - x < -12$



Copyright 2020, Jennifer Hill, DivideandConquerMath.com

**Absolute Value Equations**
**Video 1: The Basics**

Absolute value equations look like this:

$$|x+2| = 7 \quad \text{or} \quad |3x-5| + 4 = 2$$

To understand how to solve these types of equations, first think about: what are the solutions to $|x| = 5$? Explain why.

From here, we can see that we must consider 2 possible solution sets to find all solutions to absolute value equations. Write down the general strategy for solving absolute value equations:

Solve: $|2x+3| = 9$



Copyright 2020, Jennifer Hill, DivideandConquerMath.com

**Examples** Solve the following:

a. $|3x - 9| = 6$

b. $|7 - 4x| = 3$

To solve $|5x - 4| + 2 = 13$, what must we do first?

Solve:



Copyright 2020, Jennifer Hill, DivideandConquerMath.com

**<u>Examples</u>** Solve:

a. $|3x - 6| + 4 = 10$

b. $\left|\frac{1}{2}x + \frac{1}{3}\right| + 5 = 10$

The next video will discuss a special situation and a more complicated equation type.



Copyright 2020, Jennifer Hill, DivideandConquerMath.com

**Absolute Value Equations**
**Video 2: More Complicated Situations**

In this video, we will discuss how to solve equations like:

$$|x+2| = -7 \quad \text{or} \quad |3x-5| = |2x+7|$$

What can we say about the solutions to $|x| = -5$?

**<u>Examples</u>** Solve the following:

a. $|2x-7| = -8$

b. $|3x+5| + 7 = 2$

Absolute value equations can also look like this: $|3x+1| = |2x-5|$. Explain how to solve this.



Copyright 2020, Jennifer Hill, DivideandConquerMath.com

**Examples** Solve the following:

a. $|5x - 10| = |10x + 15|$

b. $|3x - 5| = |5x + 7|$

c. $|4x - 6| = |3x - 8|$



Copyright 2020, Jennifer Hill, DivideandConquerMath.com

**Example/Question: Why Do You Only Make One Side Negative with Solving $|\boldsymbol{ax}+\boldsymbol{c}|=|\boldsymbol{bx}+\boldsymbol{d}|$ type problems?**

What is the approach for solving $|x+1|=5$?

What is key to notice here?

How would you solve $|x+1|=|5x|$?

How would you solve $|x+1|=|5x-3|$?



Copyright 2021, Jennifer Hill, DivideandConquerMath.com

**Lesson: Absolute Value Inequalities**

Absolute value inequalities have 2 key aspects to solving them. What are those 2 key aspects?

Explain the setup to solve an absolute value inequality of the form $|P| \leq k$ (or $< k$).

Explain the setup to solve an absolute value inequality of the form $|P| \geq k$ (or $> k$).



Copyright 2023, Jennifer Hill, DivideandConquerMath.com

Let's try to understand why these are setup this way.

Explain the solutions to $|x| < 3$. Summarize what was explained in the video.

Explain the solutions to $|x| \geq 3$. Summarize what was explained in the video.



Copyright 2023, Jennifer Hill, DivideandConquerMath.com

**Examples** Solve the following inequalities. Graph your solution set on a number line and express your solution in interval notation.

a. $|2x - 4| < 6$

b. $|3x + 6| \geq 9$

c. $|x - 5| - 4 \leq 6$



Copyright 2023, Jennifer Hill, DivideandConquerMath.com

d. $5 \geq |3x - 4|$

e. $7 < 3 + |x - 4|$

f. $6 \leq 4 + |8 - 2x|$



Copyright 2023, Jennifer Hill, DivideandConquerMath.com

**Lesson: Special Absolute Value Inequalities**

We will discuss some special situations. Explain the reasoning for each of these situations:

a. $|2x + 3| + 7 < 4$

b. $|3x - 2| > -3$

c. $|5x + 1| \geq 0$

d. $|2x - 4| < 0$

e. $|6x + 2| \leq 0$



Copyright 2020, Jennifer Hill, DivideandConquerMath.com

**Lesson: A Review of Absolute Value Equations and Inequalities**

We can summarize how to solve each case with the following chart:

| Case (k is a number) | How to Setup |
|---|---|
| $\lvert x \rvert = k$ | |
| $\lvert x \rvert < k$ (or $\leq k$) | |
| $\lvert x \rvert > k$ (or $\geq k$) | |

**<u>Examples</u>** Solve the following. Put your answer on a number line and in interval notation when you have an inequality.

a. $|x + 3| = 5$

b. $|2x - 4| \geq 6$



Copyright 2022, Jennifer Hill, DivideandConquerMath.com

**Examples** Solve the following. Put your answer on a number line and in interval notation when you have an inequality.

a. $|4x - 2| = |6x + 8|$

b. $|5x - 2| + 1 < 9$

c. $|2 - x| - 1 > 9$



Copyright 2022, Jennifer Hill, DivideandConquerMath.com

**Special Cases!**

**<u>Example</u>** Explain what is special about each case below and how to solve the problem.

a. $|4x - 1| = -7$

b. $|4x - 1| = 0$

c. $|4x - 1| < -7$

d. $|4x - 1| > -7$



Copyright 2022, Jennifer Hill, DivideandConquerMath.com

**<u>Example</u>** Explain what is special about each case below and how to solve the problem.

a. $|4x - 1| \geq 0$

b. $|4x - 1| \leq 0$

c. $|4x - 1| < 0$

d. $|4x - 1| > 0$



Copyright 2022, Jennifer Hill, DivideandConquerMath.com

**Lesson: An Intro to Functions**

Define a relation:

Define a domain:

Define a range:

**<u>Example</u>** In the set of ordered pairs $\{(2,3), (4, -1), (7, 2)\}$, define the domain and range of the relation.



Copyright 2023, Jennifer Hill, DivideandConquerMath.com

Define a function:

What is the visual explanation that explains what a function is or is not?

**<u>Example</u>** In the set of ordered pairs $\{(2,3), (4, -1), (7, 2)\}$, is this a function?



Copyright 2023, Jennifer Hill, DivideandConquerMath.com

**Example** Are the following functions?

a. $\{(4,-1),(3,2),(7,-1)\}$

b. $\{(2,4),(3,5),(2,-1)\}$

What is the notation for a function? How do we describe/use this notation?

**Example** In the set of ordered pairs $\{(2,3),(4,-1),(7,2)\}$, what is $f(4)$?



Copyright 2023, Jennifer Hill, DivideandConquerMath.com

**<u>Example</u>** Suppose $f(x) = 2x + 1$ and $g(x) = x^2 - 3$. Find the value of the following:

a. $f(2)$

b. $g(1)$

c. $f(a)$

d. $g(h + k)$



Copyright 2023, Jennifer Hill, DivideandConquerMath.com

What is the vertical line test?

**<u>Example</u>** Do the following graphs represent a function?

a.

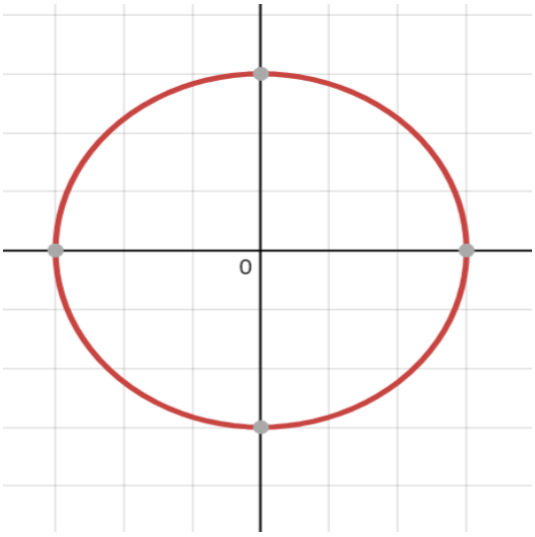


b.

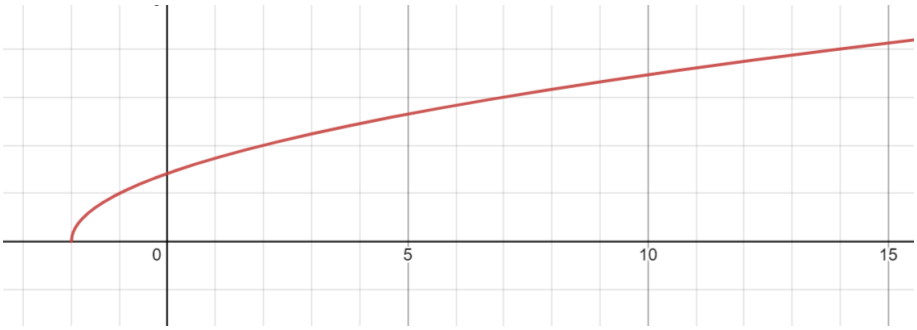




Copyright 2023, Jennifer Hill, DivideandConquerMath.com

**Lesson: Determining the Domain and Range of Functions In General**

How do you determine the domain and range of a set of points like $\{(2,4), (5,8), (4, 6)\}$?

What is the domain and range of that set of points?

In general, it is easiest to determine the domain and range when we have the graph in front of us.

For the following graph, write out how you should determine the domain and range.

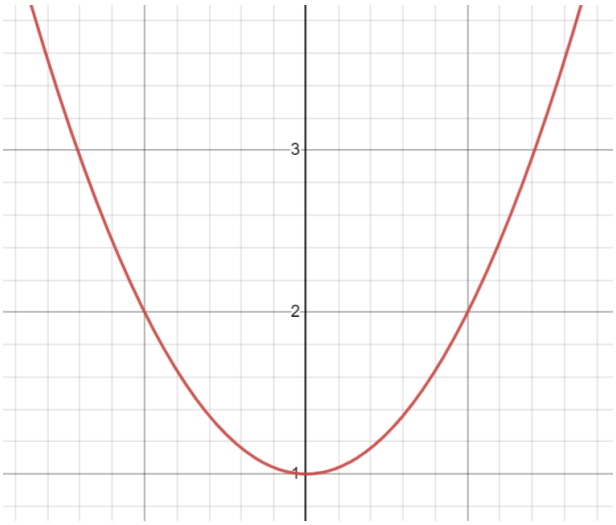


Write a sentence on how you should find the domain:

State the domain:

Write a sentence on how you should find the range:

State the range:



Copyright 2023, Jennifer Hill, DivideandConquerMath.com

**Examples** Determine if the following graphs represent functions, and then state the domain and range.

a.

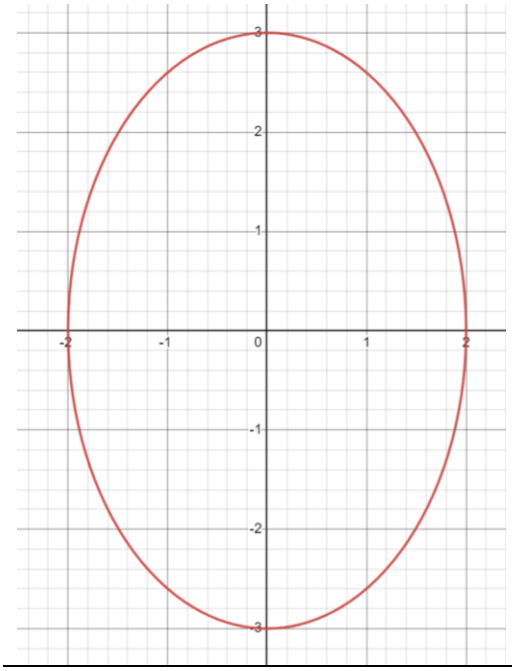


Domain:

Range:

b.

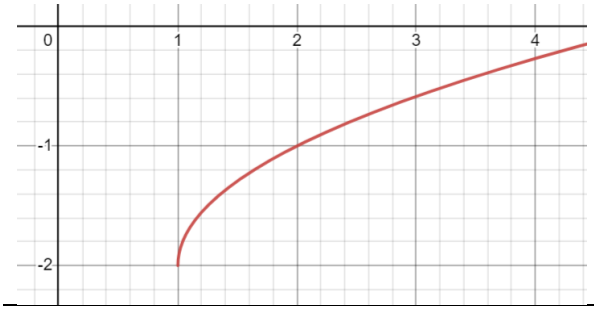


Domain:

Range:

c.

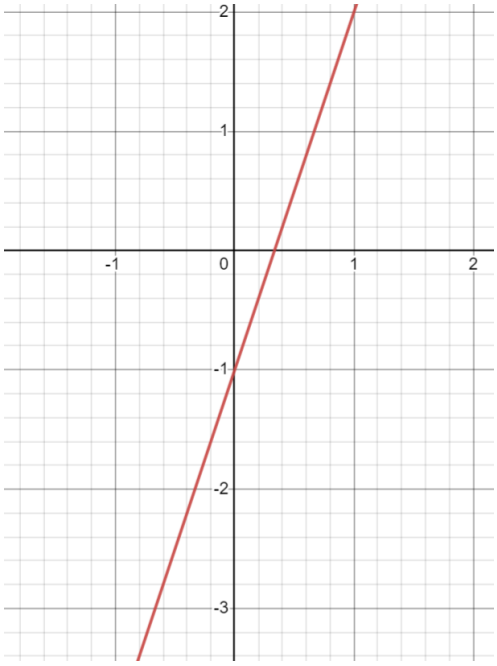


Domain:

Range



Copyright 2023, Jennifer Hill, DivideandConquerMath.com

**Lesson: The Domain of Some Specific Types of Functions**

What is a polynomial? Write some examples.

What is the domain of any polynomial function?

What is a rational function?

What is the domain of any rational function?



Copyright 2023, Jennifer Hill, DivideandConquerMath.com

**Examples** Determine the domain of the following.

a. $f(x) = 3x - 1$

b. $g(x) = \frac{4}{x+2}$

c. $h(x) = 3x^3 - 2x^2 + 4x - 1$

d. $f(x) = \frac{2x+1}{x^2-9}$



Copyright 2023, Jennifer Hill, DivideandConquerMath.com

What is a square root function?

What is the domain of a square root function?

**<u>Examples</u>** Find the domain of the following:

a. $f(x) = \sqrt{x - 2}$

b. $g(x) = \sqrt{4x - 1}$

c. $h(x) = \sqrt{4 - x}$



Copyright 2023, Jennifer Hill, DivideandConquerMath.com

**Lesson: How to Graph a Function**

How do you graph a function?

**<u>Examples</u>** Graph the following functions.

a. $f(x) = 3x + 1$

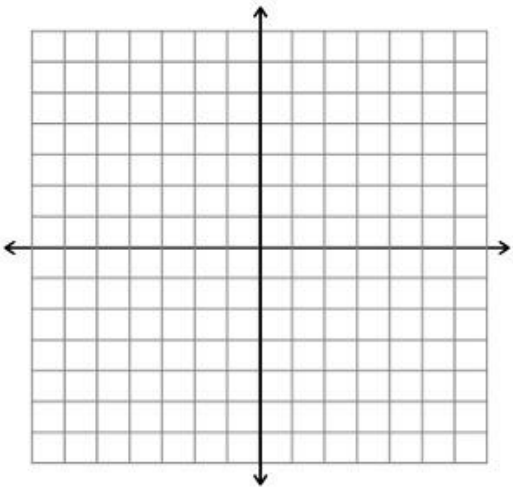

b. $g(x) = 4$

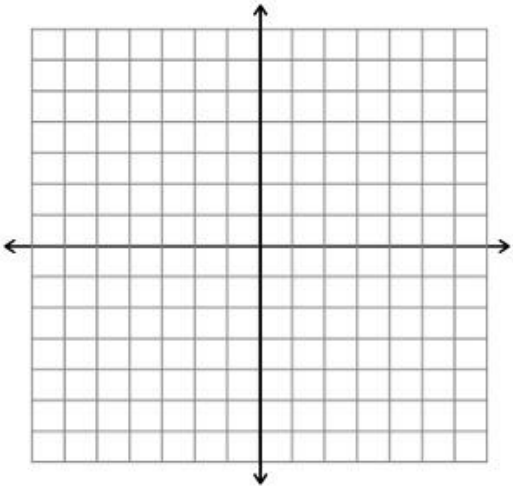



Copyright 2023, Jennifer Hill, DivideandConquerMath.com

**Lesson: Review of Functions**

How do you represent a function?

What is a function often interchangeable with? How can you rewrite $f(x) = 3x + 8$?

So what IS a function? What does it actually represent?

What's another handy feature of functions?



Copyright 2022, Jennifer Hill, DivideandConquerMath.com

What are the domain and range?

Does domain and range only work for functions?

**<u>Examples</u>** Are the following functions, and what is the domain and range?

a. $\{(2,3), (5, -1), (-3, 7)\}$

b. $\{(-1, 5), (-8, 3), (-1, 6)\}$



Copyright 2022, Jennifer Hill, DivideandConquerMath.com

What is the Vertical Line Test, and how does it help you determine if you have a function?

**<u>Example</u>** State the domain and range of the following, and use the vertical line test to determine if the graph represents a function.

a.

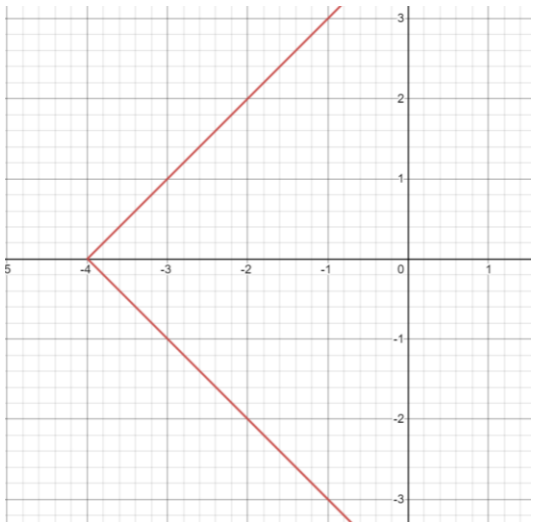


b.

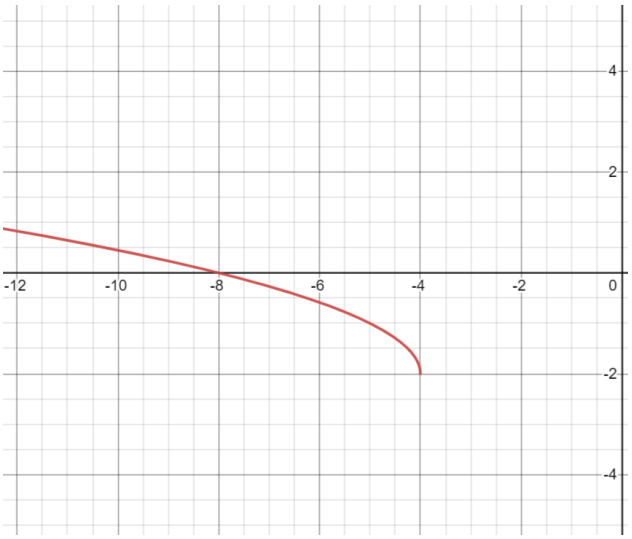




Copyright 2022, Jennifer Hill, DivideandConquerMath.com

**Examples** Determine if the following represent functions.

a. $y = 3x^2$

b. $x = y^2$

c. $y = \frac{5}{x^2}$



Copyright 2022, Jennifer Hill, DivideandConquerMath.com

**Example** Write the following in function notation: $3x + 2y = 6$

**Example** Suppose $f(x) = 3x - 5$ and $g(x) = x^2 + 4x - 1$ and $h(x) = \{(2,5),(6,-3),(-1,-4)\}$. Find the following:

a. $f(7) =$

b. $g(3) =$

c. $f(k) =$

d. $g(x + h) =$

e. $h(6) =$



Copyright 2022, Jennifer Hill, DivideandConquerMath.com

**Lesson: Increasing, Decreasing, and Constant Functions**

Below are the "formal math" definitions of whether a function is increasing, decreasing, or constant. Let I be an open interval and let $x_1$ and $x_2$ be two points in that interval.

- A function is **increasing** over I if when $x_1 < x_2, f(x)_1 < f(x_2)$
- A function is **decreasing** over I if when $x_1 < x_2, f(x)_1 > f(x_2)$
- A function is **constant** over I if when $x_1 < x_2, f(x)_1 = f(x_2)$

While these are the formal definitions, what we really want to know are the intuitive meanings of these definition.

Sketch a graph that is increasing:

Decreasing:

And constant:



Copyright 2022, Jennifer Hill, DivideandConquerMath.com

**Example** Sketch the graph in the video, and then identify where the graph is increasing, decreasing, or constant.

a.

b.



Copyright 2022, Jennifer Hill, DivideandConquerMath.com

**Lesson: A Few Basic Graphs**

There are a few graphs that are helpful to immediately know as we move forward. Let's break these down.

The Parabola: $f(x) = x^2$

Create table of relevant points and then sketch your own graph.

Absolute Value: $f(x) = |x|$

Create table of relevant points and then sketch your own graph.



Copyright 2023, Jennifer Hill, DivideandConquerMath.com

X cubed: $f(x) = x^3$

Create table of relevant points and then sketch your own graph.

Square Root: $f(x) = \sqrt{x}$

Create table of relevant points and then sketch your own graph.



Copyright 2023, Jennifer Hill, DivideandConquerMath.com

Cube Root: $f(x) = \sqrt[3]{x}$

Create table of relevant points and then sketch your own graph.



Copyright 2023, Jennifer Hill, DivideandConquerMath.com

**Lesson: An Intro to Translations and Reflections of Graphs**

We are going to develop the intuition for this concept before we actually graph anything.

**Vertical Translations**

Draw the base graph of $f(x) = x^2$ in one color and then use some other colors to show how the translations work. Label the graphs.

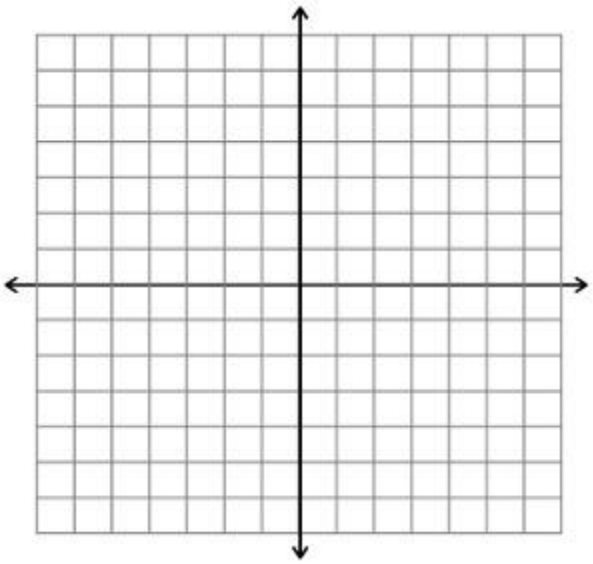

Explain the general way that vertical shifts work:

**<u>Example</u>** How does $f(x) = \sqrt{x} + 6$ shift?



Copyright 2023, Jennifer Hill, DivideandConquerMath.com

**Horizontal Translations**

Draw the base graph of $f(x) = |x|$ in one color and then use some other colors to show how the translations work. Label the graphs.

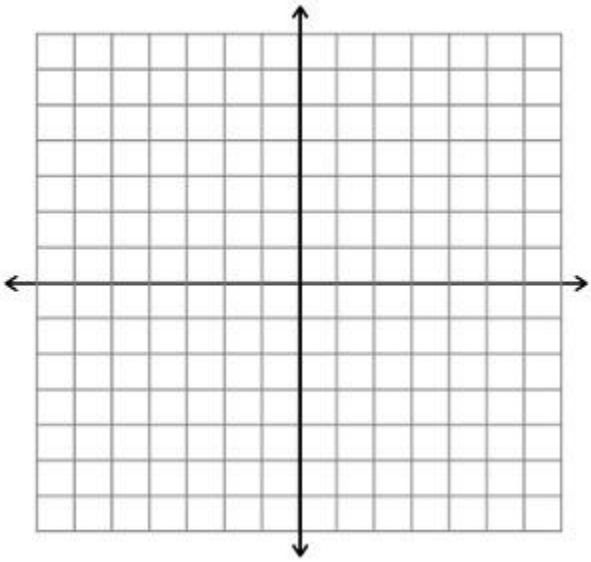

Explain the general way that horizontal shifts work:

**<u>Example</u>** How does $f(x) = \sqrt[3]{x+3}$ shift?



Copyright 2023, Jennifer Hill, DivideandConquerMath.com

**Reflections Over the X-Axis**

Draw the base graph of $f(x) = \sqrt{x}$ and then graph the reflection in another color. Label the graph of the reflection. Label the graphs.

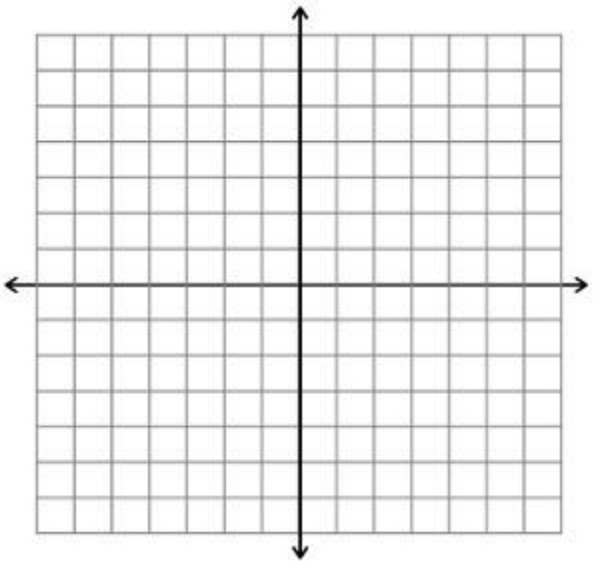

Explain the general way that reflections over the x-axis work:

**<u>Example</u>** How does $f(x) = -x^2$ look?



Copyright 2023, Jennifer Hill, DivideandConquerMath.com

**Example** Describe the translations and reflections of the following.

a. $f(x) = -x^2 + 3$

b. $g(x) = \sqrt{x+2} - 1$

c. $h(x) = (x-5)^3 + 2$

d. $f(x) = -|x+2| + 5$

e. $g(x) = -\sqrt[3]{x-1} - 4$



Copyright 2023, Jennifer Hill, DivideandConquerMath.com

**Lesson: Graphing with Translations and Reflections**

**<u>Examples</u>** For each of the following, describe the translations and reflections. Then graph with 2-3 points.

a. $f(x) = x^2 + 1$
   Describe any translations or reflections:

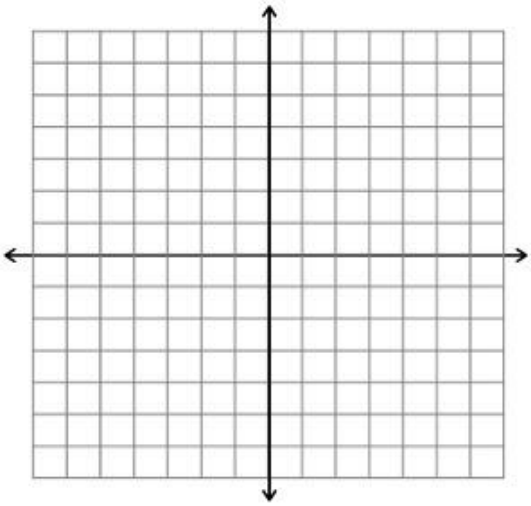

b. $g(x) = \sqrt{x - 2}$
   Describe any translations or reflections:

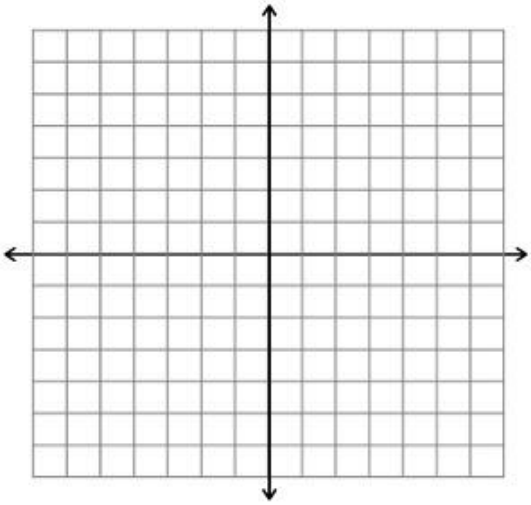



Copyright 2023, Jennifer Hill, DivideandConquerMath.com

c. $f(x) = (x + 2)^3 - 1$
Describe any translations or reflections:

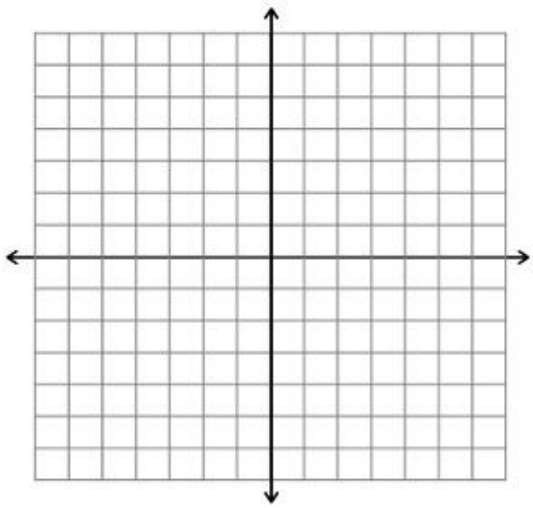

d. $h(x) = |x - 3| + 2$
Describe any translations or reflections:

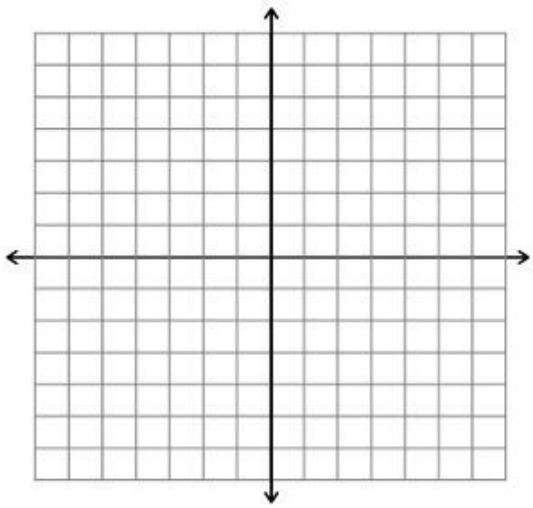



Copyright 2023, Jennifer Hill, DivideandConquerMath.com

e. $f(x) = -|x - 3| - 2$
Describe any translations or reflections:

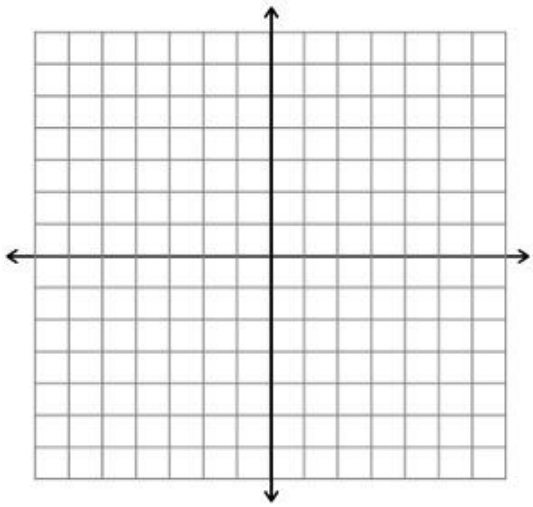

f. $f(x) = -\sqrt{x + 3} + 1$
Describe any translations or reflections:

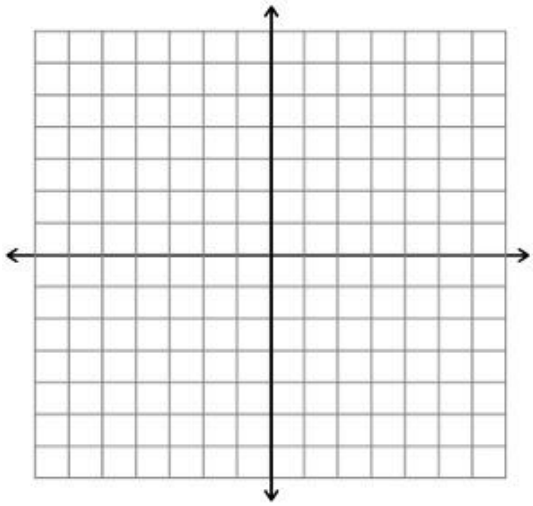



Copyright 2023, Jennifer Hill, DivideandConquerMath.com

**Lesson: Writing Equations of Functions with Translations and Reflections**

**<u>Example</u>** Write the equation of a function $g(x)$ where the following transformations are performed on the graph of $f(x)$

a. $f(x) = \sqrt[3]{x}$ is shifted 3 units down and 2 units right

b. $f(x) = x^2$ is shifted 2.5 units up and $\pi$ units left

c. $f(x) = e^x$ is reflected about the x-axis, shifted 4 units down and 1 unit left



Copyright 2023, Jennifer Hill, DivideandConquerMath.com

**Lesson: Graphs of Basic Functions**

In this section, we will review some basic graphs that are vital to know for this class and calculus. Knowing the "basic shapes" of certain graphs will make your life much easier and give you greater intuition when graphing.

Show hot to graph the following and highlight the **key points** and **key patterns.** This will come in handy for the next lesson. Take your time to sketch your own NEAT CLEAN CLEAR graphs.

$f(x) = x$

$f(x) = x^2$



Copyright 2022, Jennifer Hill, DivideandConquerMath.com

$f(x) = x^3$

$f(x) = \sqrt{x}$



Copyright 2022, Jennifer Hill, DivideandConquerMath.com

$f(x) = \sqrt[3]{x}$

$f(x) = |x|$



Copyright 2022, Jennifer Hill, DivideandConquerMath.com

**Lesson: Piecewise Functions**

What is a piecewise function? Draw an example of what they look like.

**<u>Example</u>** Given the function: $f(x) = \begin{cases} 3x - 1, & x \geq 2 \\ \frac{1}{2}x - 4, & x < 2 \end{cases}$, evaluate the following:

a. $f(3) =$

b. $f(-1) =$

c. $f(2) =$

**<u>Example</u>** Given the function: $f(x) = \begin{cases} 4, & x > 3 \\ 4x - 2, & -2 < x \leq 3 \\ x^2 - 5, & x \leq -2 \end{cases}$ evaluate the following:

a. $f(4) =$

b. $f(-5) =$

c. $f(-2) =$

d. $f(3) =$



Copyright 2022, Jennifer Hill, DivideandConquerMath.com

**Example** Show how to graph the following piecewise functions.

a. $f(x) = \begin{cases} 4, & x > 5 \\ -1, & x \leq 5 \end{cases}$

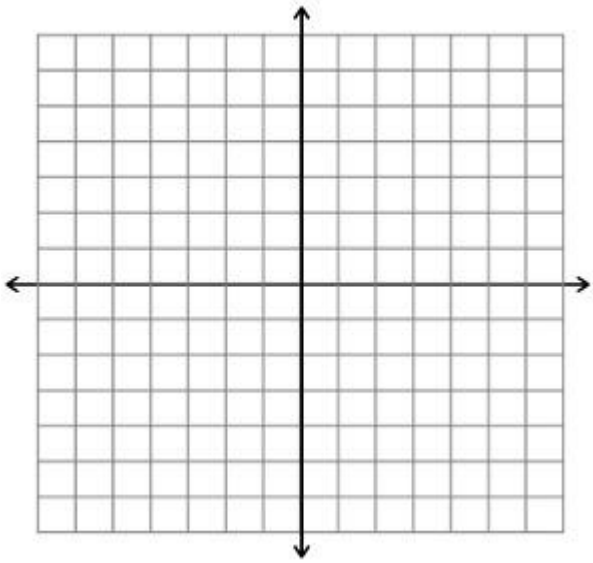

b. $f(x) = \begin{cases} 3x + 1, & x > -3 \\ -2x, & x \leq -3 \end{cases}$

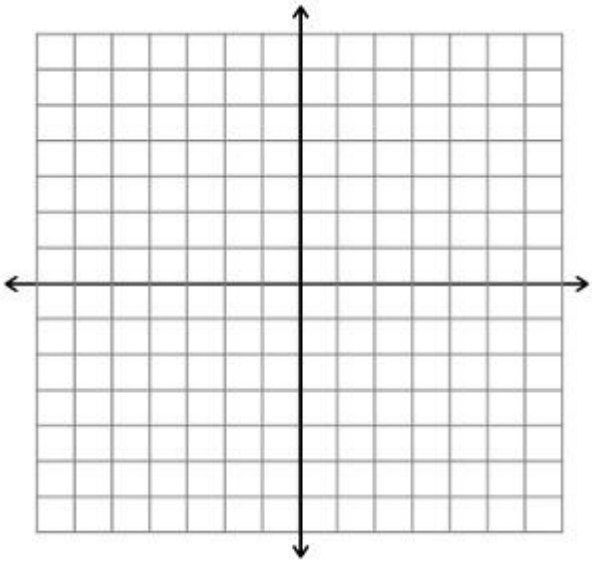

c. $f(x) = \begin{cases} 3, & x > 2 \\ 2x, & -1 < x \leq 2 \\ -x + 3, & x \leq -1 \end{cases}$

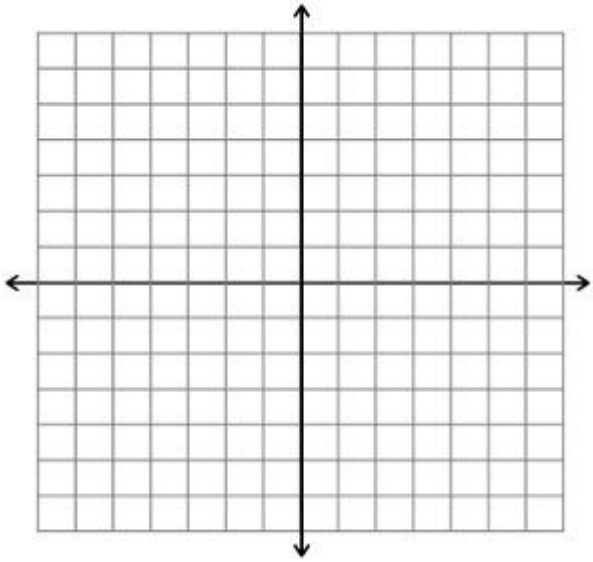

d. $f(x) = \begin{cases} 3x + 1, & x \geq 1 \\ 6, & -1 \leq x < 1 \\ x^2, & x < -1 \end{cases}$

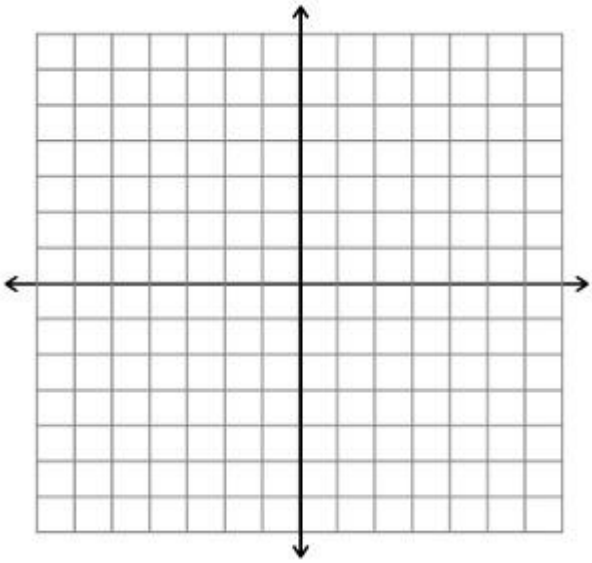



Copyright 2022, Jennifer Hill, DivideandConquerMath.com

**Lesson: The Greatest Integer Function**

Show how to graph the greatest integer function $f(x) = [\![x]\!]$

**<u>Example</u>** Graph $f(x) = \left[\!\left[\frac{1}{2}x - 2\right]\!\right]$



Copyright 2022, Jennifer Hill, DivideandConquerMath.com

**Lesson: Review of Lines and Linear Functions**

What makes a function **linear?** What are 2 forms of a linear function? How do you interpret this equation?

**Examples** What is the domain and range of $f(x) = 4x + 1$. Show how to graph it.

**Examples** What is the domain and range of $f(x) = 5$. Show how to graph it.

**Examples** What is the domain and range of $x = -4$. Show how to graph it.



Copyright 2022, Jennifer Hill, DivideandConquerMath.com

What is the **standard form** of a line?

**<u>Examples</u>** Give the domain and range of $3x - y = 6$. Show how to graph it.

How do you find the **slope** of a line?

What is the slope of a vertical line?

What is the slope of a horizontal line?



Copyright 2022, Jennifer Hill, DivideandConquerMath.com

**Examples** Find the slopes between the following sets of points.

a. $(5, 6)$ and $(-3, 2)$

b. $(-4, 7)$ and $(2, 7)$

c. $(6, 2)$ and $(6, -1)$

**Example** Find the slope of the following lines:

a. $4x - 2y = 8$

b. $-5x + 3y = -15$



Copyright 2022, Jennifer Hill, DivideandConquerMath.com

**Lesson: Review of Writing Equations of Lines**

What is the point-slope form of a line?

**<u>Example</u>** Write the equation of a line through the point $(4, 3)$ with slope $m = -2$.

**<u>Example</u>** Write the equation of a line that goes through the points $(2, 4)$ and $(-4, 10)$. Put your answer in standard form.

What is the slope-intercept form of a line?



Copyright 2022, Jennifer Hill, DivideandConquerMath.com

**Example** Show how to write $4x - 6y = 12$ in slope-intercept form.

**Example** Find the slope, x- and y-intercept, and equation of the line:

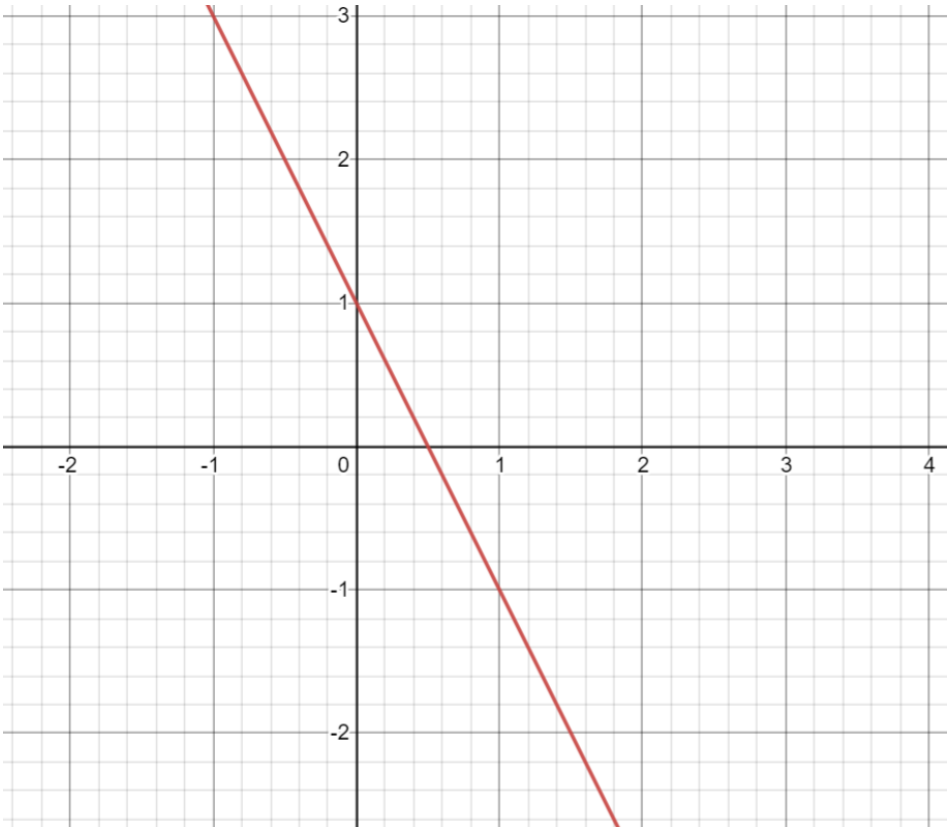




Copyright 2022, Jennifer Hill, DivideandConquerMath.com

What is the form of a vertical line?

What is the form of a horizontal line?

**<u>Example</u>** Determine the equation of the following lines.

a.

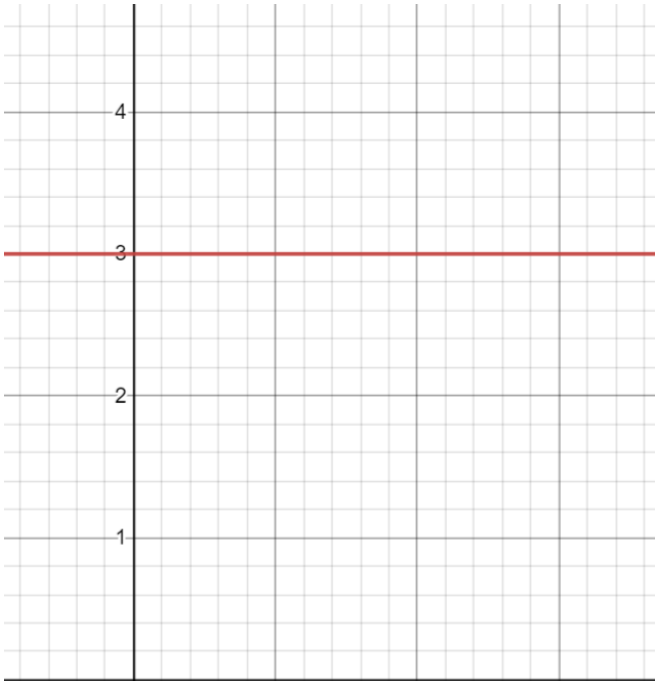


b.

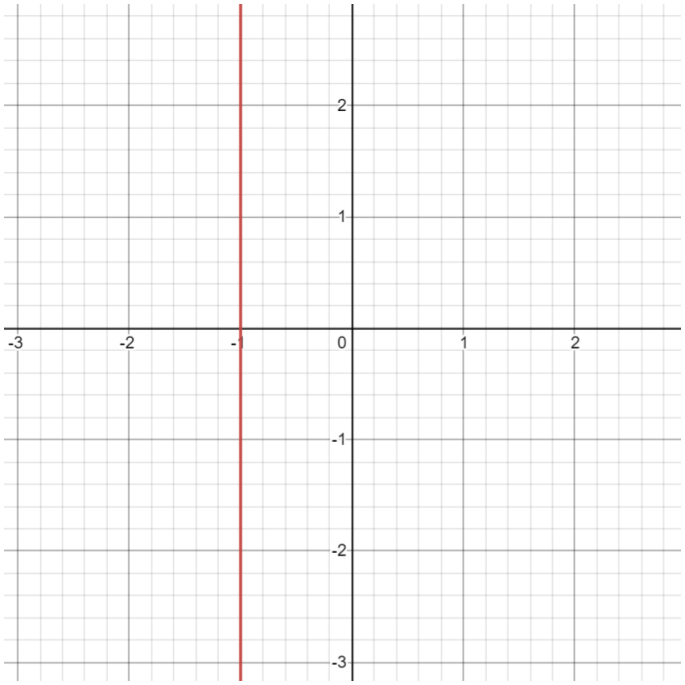


What makes 2 lines parallel?

What makes 2 lines perpendicular?



Copyright 2022, Jennifer Hill, DivideandConquerMath.com

**Examples** Write the equation of a line that goes through $(-2, -5)$ that satisfies the conditions:

a. parallel to the line: $3x - 2y = -6$

b. perpendicular to the line: $x - 2y = -4$



Copyright 2022, Jennifer Hill, DivideandConquerMath.com

**Quick Reference of Line Formulas**

Slope-Intercept Form

Standard Form

Point-Slope Form

Slope Formula

Form of a Horizontal Line

Form of a Vertical Line

What makes 2 lines parallel?

What makes 2 lines perpendicular?



Copyright 2022, Jennifer Hill, DivideandConquerMath.com

**Examples: Writing the Equation of a Line Through 2 Points**

**<u>Example</u>** Write the equation of a line through the given 2 points. Put your answer in standard form, and your standard form should not include any fractions or decimals.

a. $(4, 5)$ and $(2, 9)$

b. $(2, 7)$ and $(-4, 7)$

c. $(-4, 2)$ and $(2, 5)$

d. $(3, 5)$ and $(3, 8)$



Copyright 2022, Jennifer Hill, DivideandConquerMath.com

**Examples: Writing the Equation of a Line Through 2 Points**

**<u>Example</u>** Write the equation of a line through the point $(2, 3)$ that satisfies the given conditions. Your final answer should be in standard form with no fractions or decimals.

a. Parallel to $5x - 2y = 10$

b. Perpendicular to $4x - 2y = 1$

c. Parallel to $y = 5$

d. Perpendicular to $x = 7$



Copyright 2022, Jennifer Hill, DivideandConquerMath.com

**Lesson: The Slope of a Line**

What does slope represent?

Draw the various possible slopes of lines:

How do find the slope of a line?

**<u>Examples</u>** Find the slope of the following lines:

a.

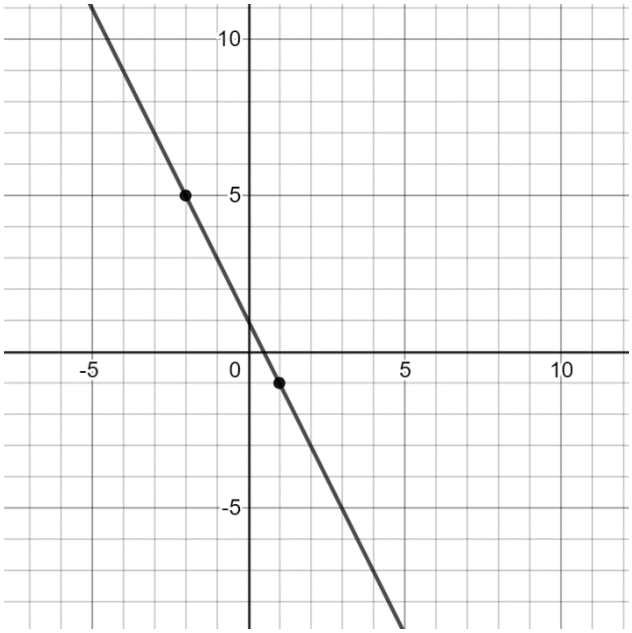


b.

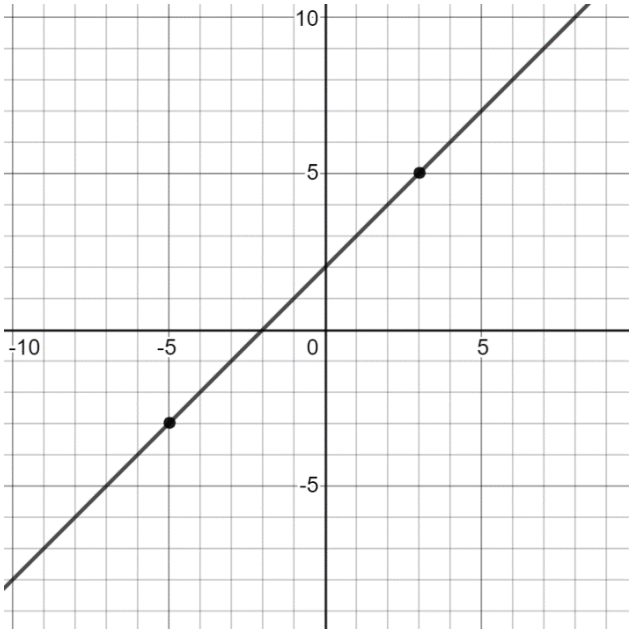




Copyright 2020, Jennifer Hill, DivideandConquerMath.com

What is the slope formula?

**<u>Examples</u>** Use the slope formula to find the slope between the pairs of points:

a. $(3, 5)$ and $(4, 8)$

b. $(6, -2)$ and $(-2, 4)$

c. $(7, 2)$ and $(7, 4)$

d. $(2, 4)$ and $(-1, 4)$



Copyright 2020, Jennifer Hill, DivideandConquerMath.com

**Lesson: Using Slope to Graph Lines; Intro to Slope-Intercept Form**

When the slope of a line and a point are known, a line can be easily graphed.

**<u>Examples</u>** Given the slope and the point, graph the following lines:

a. $m = 2$ and $(-1, 2)$

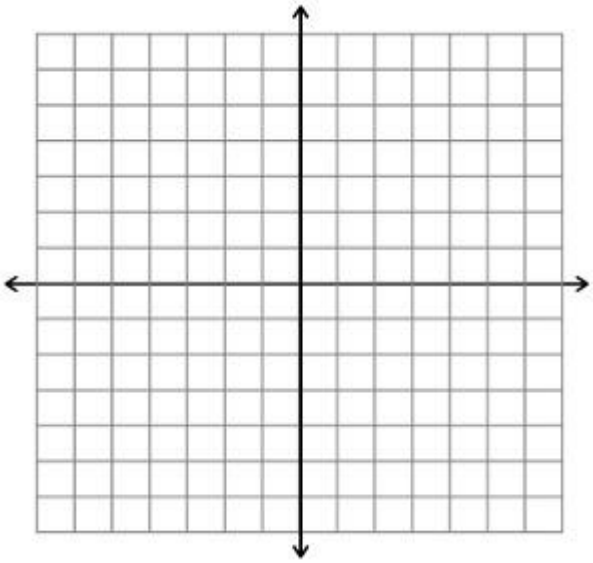

c. $m = 1$ and $(2, -1)$

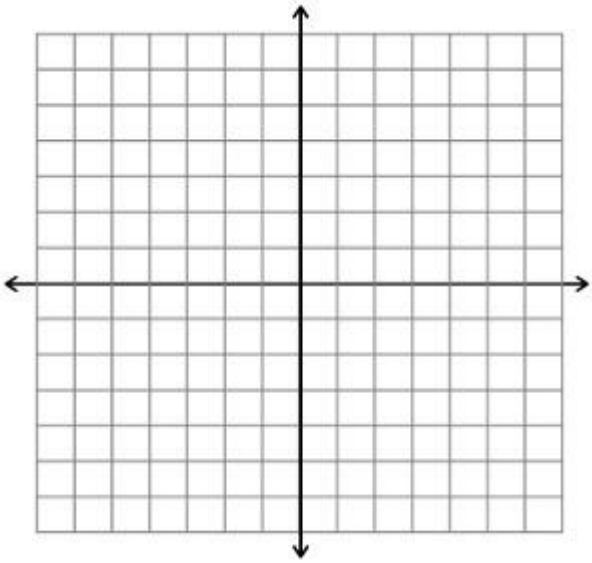

b. $m = -\frac{1}{3}$ and $(-3, 4)$

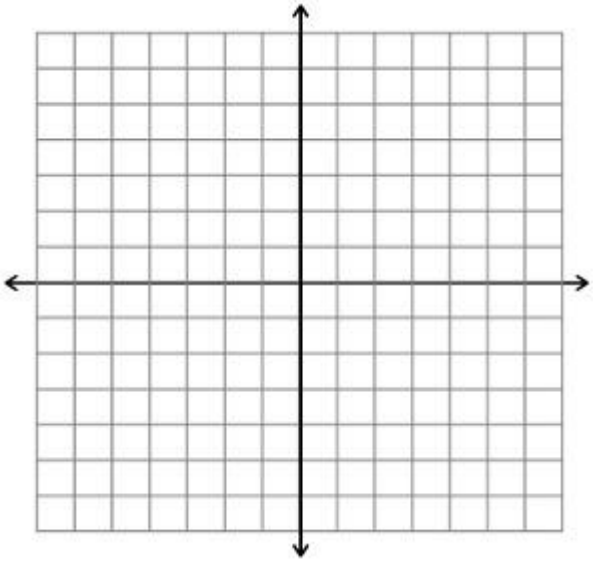

d. $m = \frac{2}{3}$ and $(0, -3)$

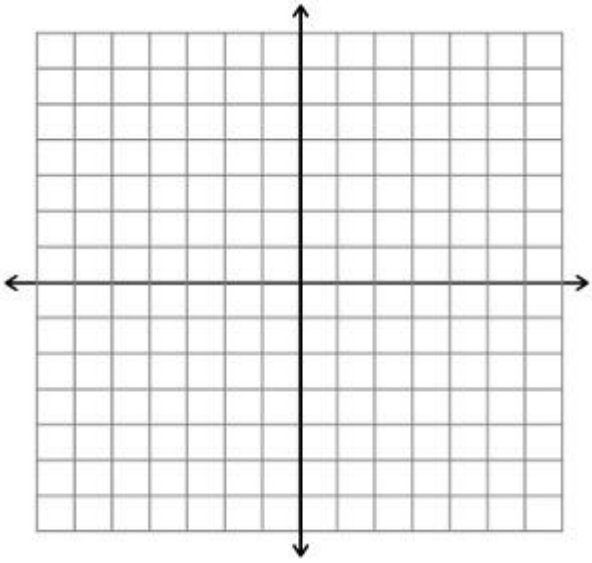

What is the slope-intercept form of a line?



Copyright 2020, Jennifer Hill, DivideandConquerMath.com

**Examples** Identify the slope $m$ and the y-intercept $(0, b)$ in each of the following equations:

| Equation | Slope, m | What stands for b | State the y-intercept (as a point) |
|---|---|---|---|
| a. $y = -2x + 3$ | | | |
| b. $y = \frac{1}{4}x - 7$ | | | |
| c. $y = 3x + 9$ | | | |
| d. $y = x$ | | | |

**Examples** Graph the following lines:

a. $y = 2x + 3$

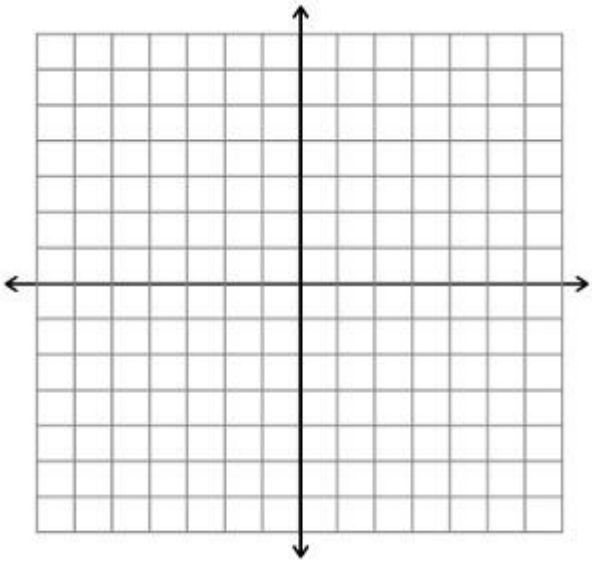

c. $y = \frac{1}{3}x - 4$

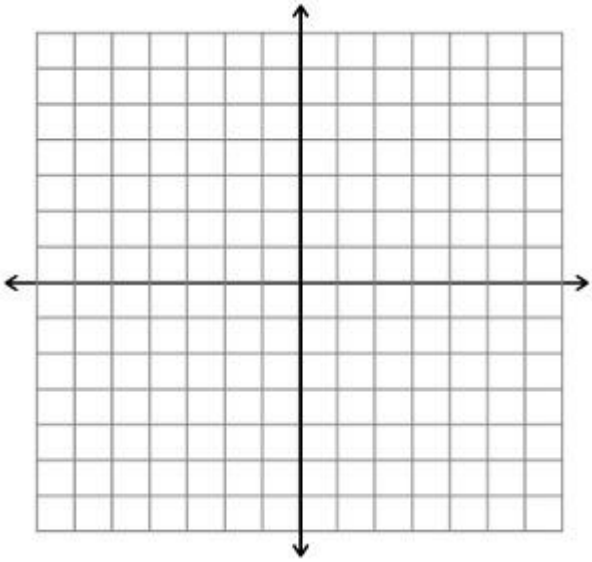

b. $y = -x + 4$

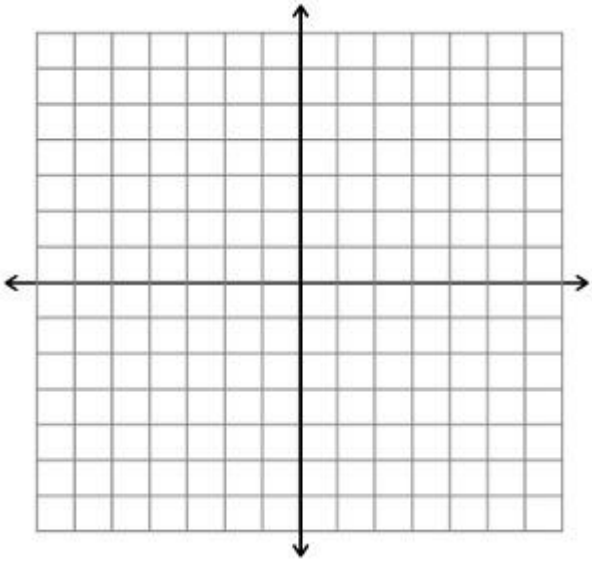

d. $y = 3x$

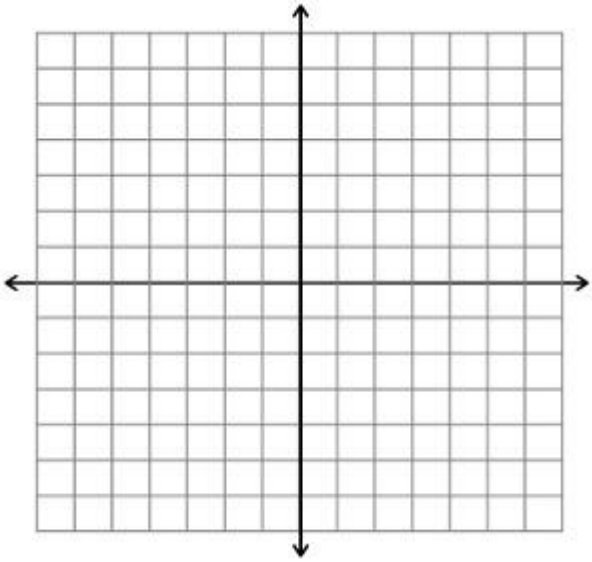



Copyright 2020, Jennifer Hill, DivideandConquerMath.com

**Lesson: Rewriting Linear Equations into Slope-Intercept Form of a Line**

What is the slope-intercept form of a line?

Explain how to put the equation $2x - 4y = 8$ into slope-intercept form.

**<u>Examples</u>** Put the following equations in slope-intercept form:

a. $6y - 3x = 12$

b. $-5x + 2y = -4$



Copyright 2020, Jennifer Hill, DivideandConquerMath.com

**Lesson: Determining Whether Two Lines are Parallel or Perpendicular**

What makes 2 lines parallel?

**<u>Examples</u>** Are the equations $y = \frac{2}{3}x + 5$ and $2x - 3y = 6$ parallel?

What makes 2 lines perpendicular?

**<u>Examples</u>** Determine the negative reciprocal of each of the following:

a. $\frac{2}{3}$

b. $-\frac{1}{5}$

c. $-7$

d. $1$



Copyright 2020, Jennifer Hill, DivideandConquerMath.com

**Example** Are the equations $y = \frac{3}{5}x + 2$ and $-3x + 5y = -15$ perpendicular?

**Examples** Are the following pairs of lines parallel, perpendicular, or neither?

a. $3x - 2y = 6$ and $4y = -6x - 8$

b. $y - 3x = 0$ and $12x - 4y = 24$

c. $y = 3$ and $x = -2$



Copyright 2020, Jennifer Hill, DivideandConquerMath.com

**Examples** Lines A and B contain the given points. Determine whether the lines are parallel, perpendicular, or neither.

a. Line A: $(2, 11), (5, 10)$ Line B: $(1, 3), (-6, -18)$

b. Line A: $(-5, 5), (-7, -2)$ Line B: $(0, 11), (-4, 9)$



Copyright 2020, Jennifer Hill, DivideandConquerMath.com

**Lesson: Putting Equations in Standard Form**

What is the standard form of a line?

**<u>Examples</u>** Write the following equations in standard form:

a. $y = 2x - 4$

b. $y = -5x + 3$

c. $y = -\frac{1}{2}x + 1$

d. $y = \frac{2}{3}x - 2$



Copyright 2020, Jennifer Hill, DivideandConquerMath.com

**Lesson: Writing Equations of Lines with The Point-Slope Form**

What is the point-slope form of a line?

**<u>Examples</u>** Given the point and the slope, write the point-slope form of a line.

a. $m = -2, (1, 3)$

b. $m = -\frac{2}{3}, (5, -2)$

What is the slope-intercept form of a line?

What is the standard form of a line?



Copyright 2020, Jennifer Hill, DivideandConquerMath.com

**Examples** Given the point and the slope, write the equation of the line in the desired format.

a. $m = -1, (2, -5)$ in slope-intercept form

b. $m = 3, (5, -4)$ in standard form

c. $m = -\frac{1}{2}, (6, 3)$

d. $m = \frac{2}{3}, (-5, -1)$



Copyright 2020, Jennifer Hill, DivideandConquerMath.com

**Lesson: Writing the Equation of a Line from Two Points**

Write the equation of the line that contains the following 2 points in the desired format.

a. $(4, 2)$ and $(5, 5)$ in slope-intercept form

b. $(-2, 4)$ and $(-4, -2)$ in standard form

c. $(5, -3)$ and $(3, 5)$ in slope-intercept form

d. $(-1, -3)$ and $(1, 5)$ in standard form



Copyright 2020, Jennifer Hill, DivideandConquerMath.com

**Lesson: Writing the Equation of a Line Parallel/Perpendicular to Another Line**

What makes 2 lines parallel?

What makes 2 lines perpendicular?

**<u>Examples</u>** Write the equation of a line with the given conditions.

a. Parallel to $y = 3x + 1$ that goes through $(-2, -5)$ in slope-intercept form

b. Perpendicular to $y = -\frac{2}{3}x - 5$ that goes through $(6, -2)$ in standard form

c. Parallel to $2x - 3y = 6$ that goes through $(1, -2)$ in slope-intercept form



Copyright 2020, Jennifer Hill, DivideandConquerMath.com

**Examples** Write the equation of a line with the given conditions.

a. Perpendicular to $2x - 4y = 8$ that goes through $(-4, -2)$ in standard form

b. Parallel to $3x - y = 12$ that goes through $(-1, -5)$ in slope-intercept form

c. Perpendicular to $-2x + 3y = 12$ that goes through $(2, -5)$ in standard form



Copyright 2020, Jennifer Hill, DivideandConquerMath.com

**Lesson: Translations and Reflections of Functions**

Using the graph $f(x) = |x|$ as the "base function," sketch how vertical translations work (summarize what was discussed in the video).

How do you describe vertical translations in function notation?

Using the graph $f(x) = x^2$ as the "base function," sketch how horizontal translations work (summarize what was discussed in the video).

How do you describe horizontal translations in function notation?



Copyright 2022, Jennifer Hill, DivideandConquerMath.com

Use the graph $f(x) = \sqrt{x}$ to show how reflections over the x- and y-axis work (summarize what was discussed in the video).

How do you describe reflections over the x-axis and y-axis using function notation.

Use the graph $f(x) = |x|$ to show how stretching and shrinking works (summarize what was discussed in the video).



Copyright 2022, Jennifer Hill, DivideandConquerMath.com

Explain how stretching and shrinking works with function notation.

**<u>Example</u>** Describe any translations / reflections / stretching / shrinking and sketch a graph of each of the following.

a. $f(x) = -x^2 + 3$

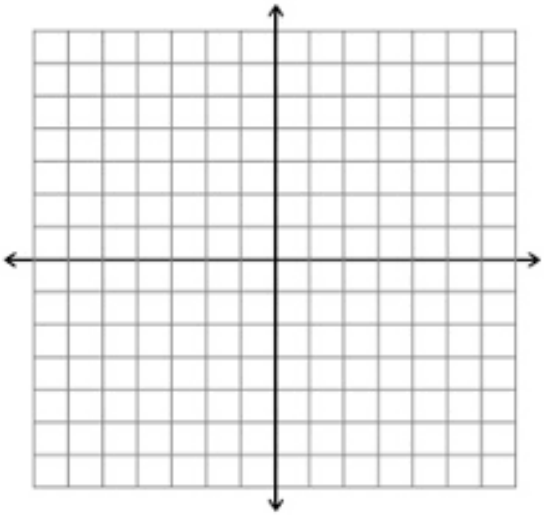

b. $g(x) = (x + 2)^3 - 3$

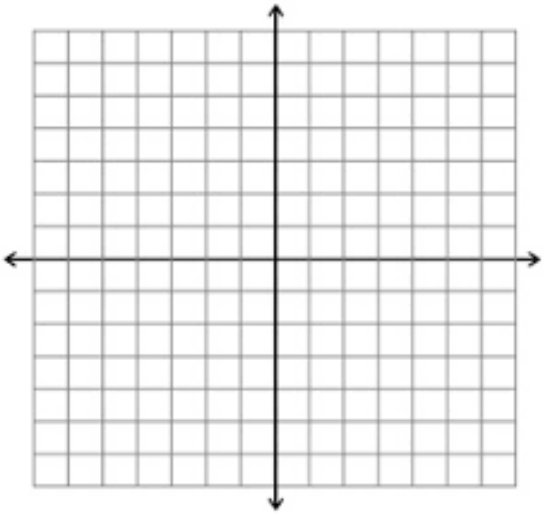



Copyright 2022, Jennifer Hill, DivideandConquerMath.com

**Example** Describe any translations / reflections / stretching / shrinking and sketch a graph of each of the following.

a. $g(x) = -2(x+1)^2 - 5$

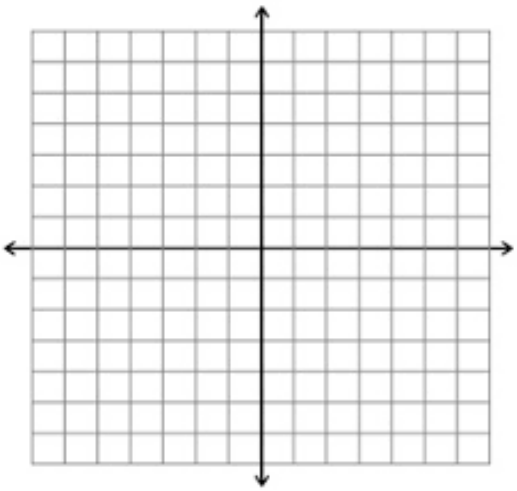

b. $h(x) = 2\sqrt{-x} + 1$

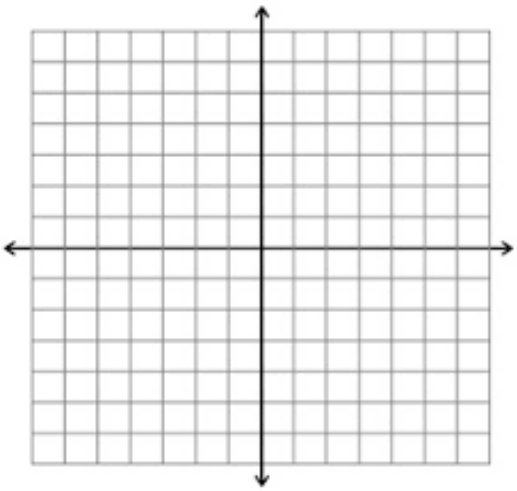

**Examples** Write the equation of the given functions with the following characteristics.

a. The function $f(x) = x^2$ moved 3 units left and 5 units down.

b. The function $g(x) = \sqrt[3]{x}$ reflected over the y-axis, translated 2.5 units right and 1.75 units up.



Copyright 2022, Jennifer Hill, DivideandConquerMath.com

**Transformations of Functions**

These are looking at graphs of things like:

$$f(x) = x^2 - 5 \quad \text{or} \quad f(x) = |x+3| - 2 \quad \text{or} \quad f(x) = \sqrt{x-3}$$

First we need to discuss the shape of a few basic functions. Write these down and note the important points.

a. $f(x) = x^2$

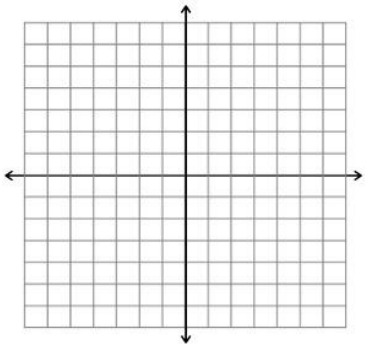

b. $f(x) = |x|$

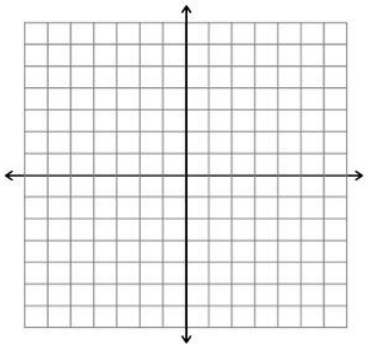

c. $f(x) = \sqrt{x}$

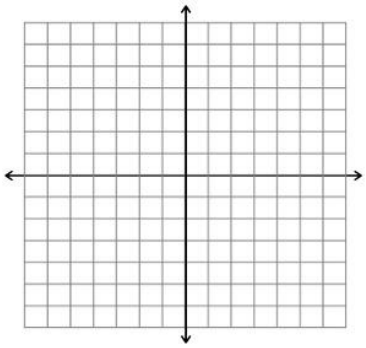

Using a few different colors, sketch out what the graphs of

a. $f(x) = x^2$ versus b. $g(x) = x^2 + 3$ versus c. $h(x) = x^2 - 1$

look like all on the same graph below:

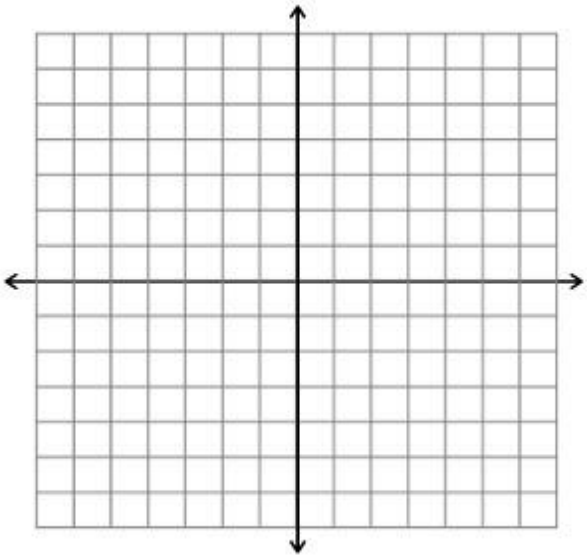



Copyright 2020, Jennifer Hill, DivideandConquerMath.com

This is an example of a vertical shift. Explain what this means in mathematical terms:

Using a few different colors, sketch out what the graphs of

a. $f(x) = |x|$ versus b. $g(x) = |x - 1|$ versus c. $h(x) = |x + 2|$

look like all on the same graph below:

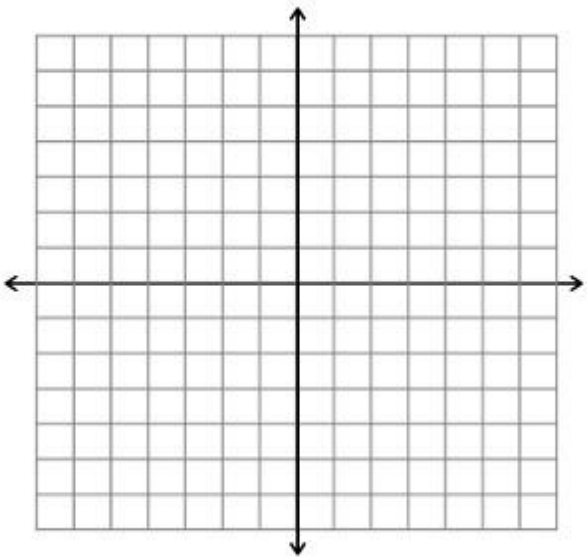

This is an example of a horizontal shift. Explain what this means in mathematical terms:



Copyright 2020, Jennifer Hill, DivideandConquerMath.com

Using a few different colors, sketch out what the graphs of

a. $f(x) = |x|$ versus b. $g(x) = -|x|$

look like all on the same graph below:

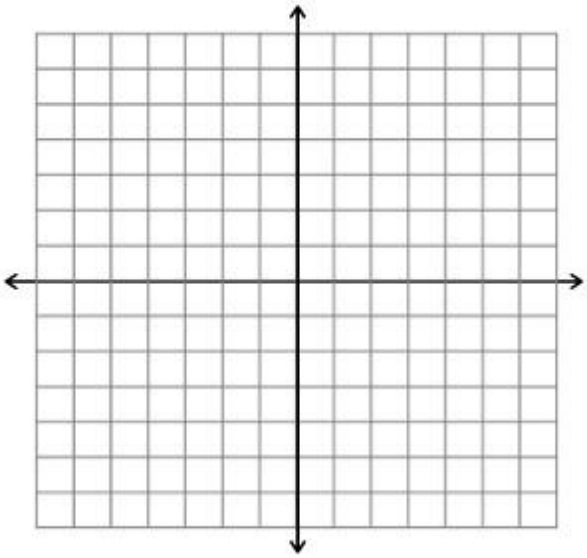

This is an example of a reflection over the x-axis. Explain what this means in mathematical terms:

**<u>Example</u>** Explain in plain language what types of shifts/reflections are occurring, and then graph the function.

$$f(x) = |x| + 3$$

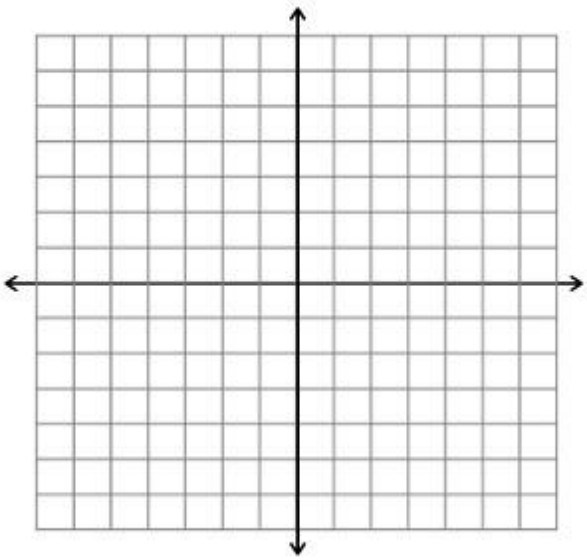



Copyright 2020, Jennifer Hill, DivideandConquerMath.com

**Examples** Explain in plain language what types of shifts/reflections are occurring, and then graph the function.

a. $f(x) = (x-1)^2$

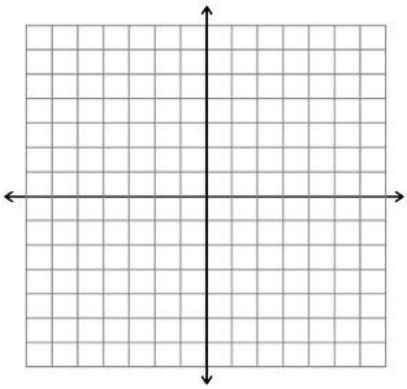

b. $g(x) = \sqrt{x} - 2$

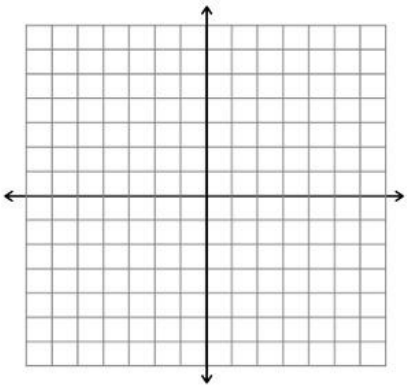

c. $h(x) = |x+1| - 2$

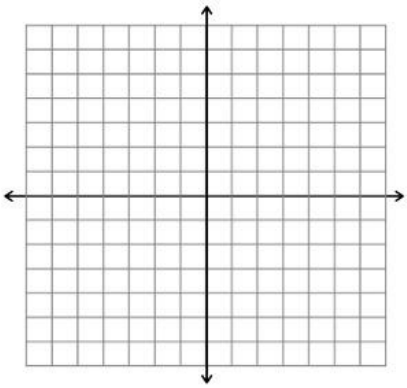

d. $k(x) = (x-2)^2 + 4$

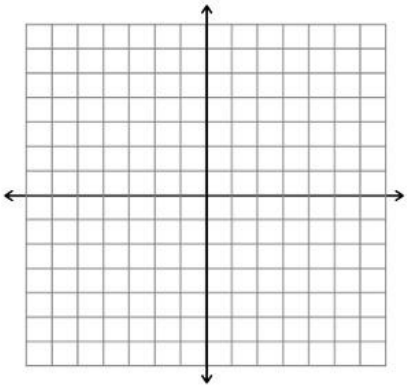

e. $f(x) = -(x+3)^2 - 2$

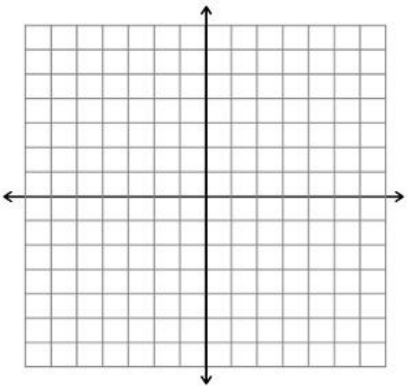

f. $g(x) = -|x+3| - 1$

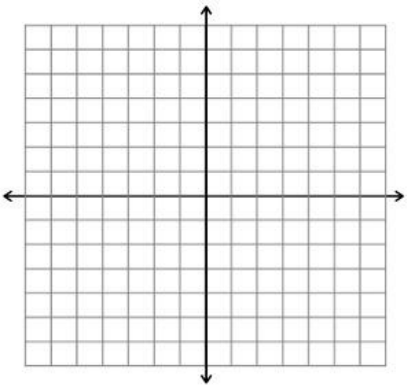

g. $h(x) = -\sqrt{x-2}$

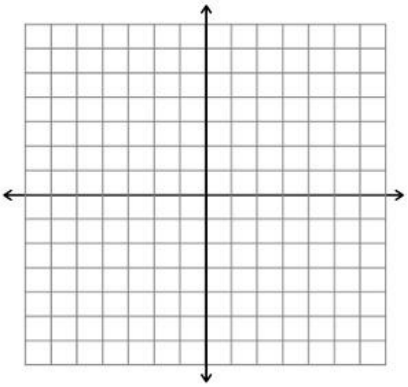

h. $k(x) = -\sqrt{x+1} - 3$

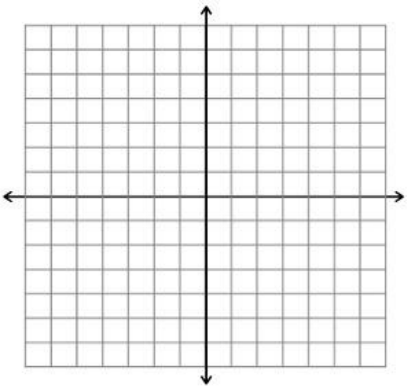



Copyright 2020, Jennifer Hill, DivideandConquerMath.com

**Examples** Write the equations that represent the listed transformations.

a. A function $f(x) = \sqrt{x}$ is shifted 7 units down.

b. A function $g(x) = x^3$ is shifted 3 units left and 2 units up.

c. A function $h(x) = |x|$ is shifted 2.5 units right and reflected over the x-axis.

d. A function $f(x) = e^x$ is shifted 4 units up and reflected over the x-axis.

e. A function $g(x) = \sqrt[3]{x}$ is shifted 3.2 units right, 5.7 units up, and reflected over the x-axis



Copyright 2020, Jennifer Hill, DivideandConquerMath.com

**Examples: Translations and Reflections of Functions**

Describe any translations / reflections / stretching / shrinking and sketch a graph of each of the following.

a. $f(x) = -(x+2)^2 - 3$

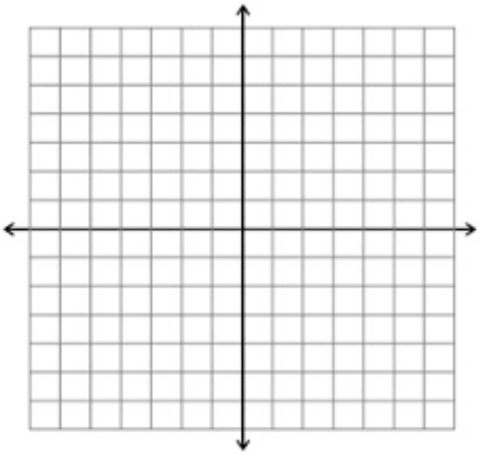

b. $g(x) = \frac{1}{2}(x-1)^3 + 2$

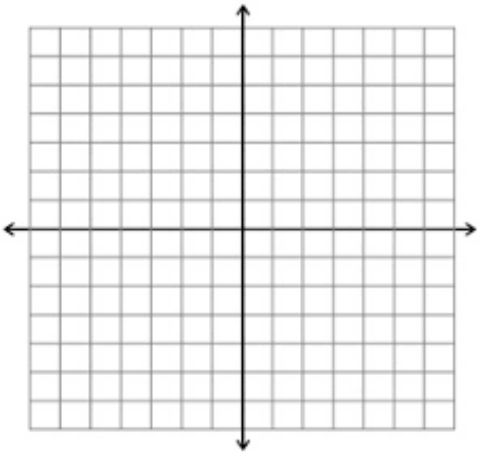

c. $h(x) = -\frac{1}{3}\sqrt{x+1} + 1$

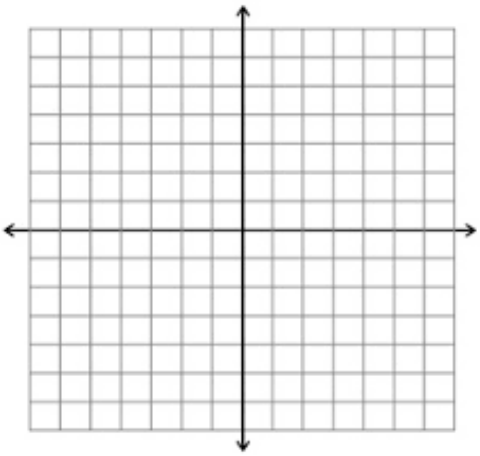



Copyright 2022, Jennifer Hill, DivideandConquerMath.com

**Lesson: Symmetry and Even or Odd Functions**

Explain when a graph is symmetric with respect to the y-axis:

Explain when a graph is symmetric with respect to the x-axis:



Copyright 2022, Jennifer Hill, DivideandConquerMath.com

Explain when a graph is symmetric with respect to the origin:

What makes a function odd?

What makes a function even?



Copyright 2022, Jennifer Hill, DivideandConquerMath.com

So what is the test for even or odd functions?

**<u>Examples</u>** Determine what type of symmetry the following functions have:

a. $y = x^2 + 4$

b. $x^2 + y^2 = 25$



Copyright 2022, Jennifer Hill, DivideandConquerMath.com

**Examples** Determine what type of symmetry the following functions have:

a. $y = x^3 - 5$

b. $y = 7x^2 + 2x - 4$

c. $y = 2x^{\frac{1}{3}} - 3x$



Copyright 2022, Jennifer Hill, DivideandConquerMath.com

**Lesson: Review of Function Operations**

Given that $f$ and $g$ are functions, how do we define the function operations?

$(f+g)(x) =$

$(f-g)(x) =$

$(fg)(x) =$

$\left(\frac{f}{g}\right)(x) =$

**<u>Example</u>** Let $f(x) = 3x+1, g(x) = x^2-4, h(x) = 3x^2+7x+2$, and $k(x) = x^2+6x+9$. Find each of the following:

a. $(f+g)(x) =$

b. $(f+g)(3) =$

c. $(g-k)(1) =$



Copyright 2022, Jennifer Hill, DivideandConquerMath.com

**<u>Example</u>** Let $f(x) = 3x + 1, g(x) = x^2 - 4, h(x) = 3x^2 + 7x + 2$, and $k(x) = x^2 + 6x + 9$. Find each of the following:

a. $\left(\frac{h}{f}\right)(x) =$

b. $(gh)(x) =$

c. $\left(\frac{k}{h}\right)(1) =$



Copyright 2022, Jennifer Hill, DivideandConquerMath.com

**Lesson: Review of Composition of Functions**

For two functions $f$ and $g$, what is the composition $(f \circ g)(x)$?

**<u>Example</u>** Let $f(x) = 3x + 1, g(x) = x^2 - 4, h(x) = \sqrt{x}$, and $k(x) = x^2 + 6x + 9$. Find each of the following:

a. $(f \circ g)(x) =$

b. $(g \circ f)(x) =$



Copyright 2022, Jennifer Hill, DivideandConquerMath.com

**<u>Example</u>** Let $f(x) = 3x + 1, g(x) = x^2 - 4, h(x) = \sqrt{x}$, and $k(x) = x^2 + 6x + 9$. Find each of the following:

a. $(k \circ f)(1) =$

b. $(g \circ h)(4) =$

c. $(h \circ k)(x) =$



Copyright 2022, Jennifer Hill, DivideandConquerMath.com

**Lesson: The Difference Quotient**

Explain what the difference quotient is and draw some sketches to explain how it works. In other words, watch the video explanation and then explain it in your own words on this page.



Copyright 2022, Jennifer Hill, DivideandConquerMath.com

State the formula for the difference quotient here:

**<u>Example</u>** Calculate the different quotient for the following.

a. $f(x) = 4x + 5$

b. $f(x) = x^2 - 1$



Copyright 2022, Jennifer Hill, DivideandConquerMath.com

**Lesson: The Difference Quotient**

Find the difference quotient.

a. $f(x) = \frac{1}{x+3}$

b. $f(x) = x^2 - 4x + 1$

c. $f(x) = -x^2 + 3$



Copyright 2022, Jennifer Hill, DivideandConquerMath.com

**Lesson: Determining if Functions are One-to-One**

Before we begin, you should already be familiar with the concept of functions and the vertical line test. First let's do some review.

**<u>Review</u>** Determine whether the following relations are functions, then determine the domain and range.

a. $\{(2,3),(5,7),(2,4)\}$

b.

Now we will discuss a specific type of function: a one-to-one function. Define this below:

How can we visualize this?



Copyright 2020, Jennifer Hill, DivideandConquerMath.com

**Example** Determine if any of the following are i) functions and ii) one-to-one functions

a. $\{(2,4),(-1,7),(3,7)\}$

b. $\{(3,6),(-1,2),(-3,-4)\}$

Similar to how we have a test to determine if a graph represents a function, we have another test to determine if a function is one-to-one.

Describe the horizontal line test below:

**Examples** Determine whether the following graphs represent i) functions and ii) one-to-one functions (draw your own):

a. b. c.



Copyright 2020, Jennifer Hill, DivideandConquerMath.com

**Lesson: Finding the Inverse of Functions**

One-to-one functions have inverses. Describe what the inverse of a function is:

**<u>Example</u>** Find the inverse of the following function: $\{(1,4),(7,8),(3,-2)\}$

Describe the steps to find the inverse of a function:



Copyright 2020, Jennifer Hill, DivideandConquerMath.com

**<u>Examples</u>** Find the inverse of the following one-to-one functions. Then plot the original function on the graph with its inverse.

a. $f(x) = 3x + 1$

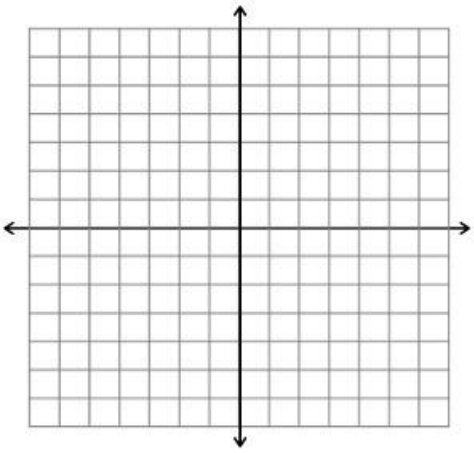

b. $g(x) = -\frac{1}{2}x + 4$

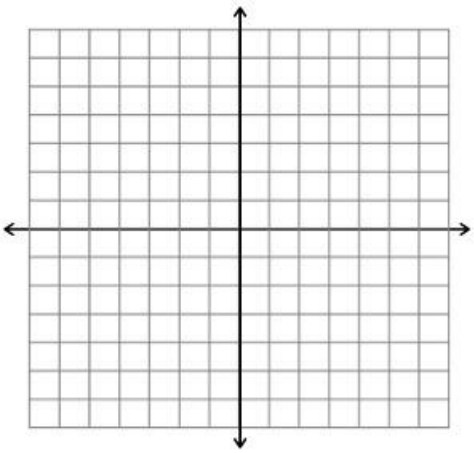

What is the relationship of a graph with its inverse?



Copyright 2020, Jennifer Hill, DivideandConquerMath.com

**<u>Examples</u>** Find the inverse of the following one-to-one functions.

a. $h(x) = \sqrt[3]{x}$

b. $f(x) = x^2, x \geq 0$



Copyright 2020, Jennifer Hill, DivideandConquerMath.com

**Lesson: A Review of Inverse Functions**

What is a one-to-one function?

**<u>Examples</u>** Are the following one-to-one functions? If no, why not?

a. $f(x) = x^2$

b. $g(x) = 2x + 1$

What is the horizontal line test?



Copyright 2022, Jennifer Hill, DivideandConquerMath.com

**Example** Use the horizontal line test to determine if the functions are one-to-one:

a.

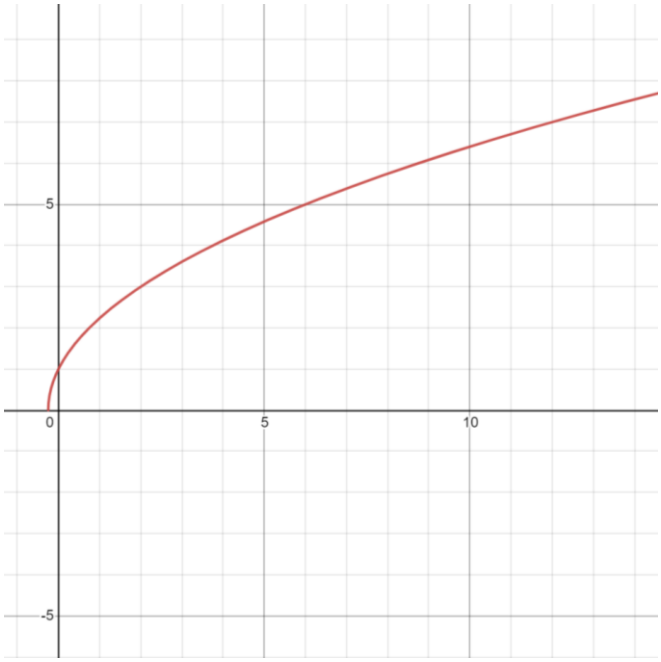


b.

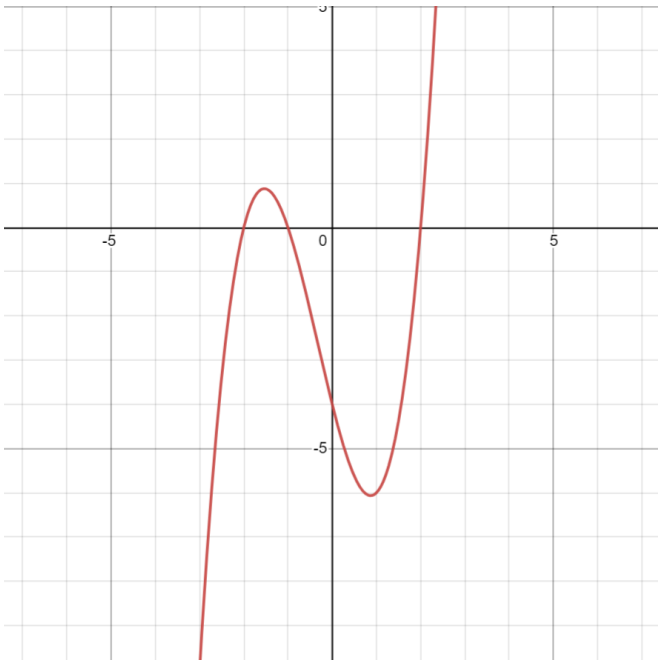


What is an inverse function?

What does an inverse function have to do with one-to-one functions?



Copyright 2022, Jennifer Hill, DivideandConquerMath.com

Describe how to use composition to determine if 2 functions are inverses of one another.

**Example** Use composition to determine if the functions $f(x) = 2x - 4$ and $g(x) = \frac{1}{2}x - 2$ are inverses.

**Example** Use composition to determine if the functions $f(x) = \frac{2}{x+6}$ and $g(x) = \frac{6+x}{2}$ are inverses.



Copyright 2022, Jennifer Hill, DivideandConquerMath.com

Using $f(x) = 4x + 2$, outline the steps for how to find the inverse of a function.



Copyright 2022, Jennifer Hill, DivideandConquerMath.com

**Example** Find the inverse of the following functions.

a. $f(x) = \sqrt[3]{3x+1}$

b. $f(x) = \frac{x+2}{x-1}$

c. $f(x) = \sqrt{x-5}$



Copyright 2022, Jennifer Hill, DivideandConquerMath.com

How can we tell on a graph if 2 functions are inverses of one another?

**<u>Examples</u>** Are the following graphs inverses of one another?

a.

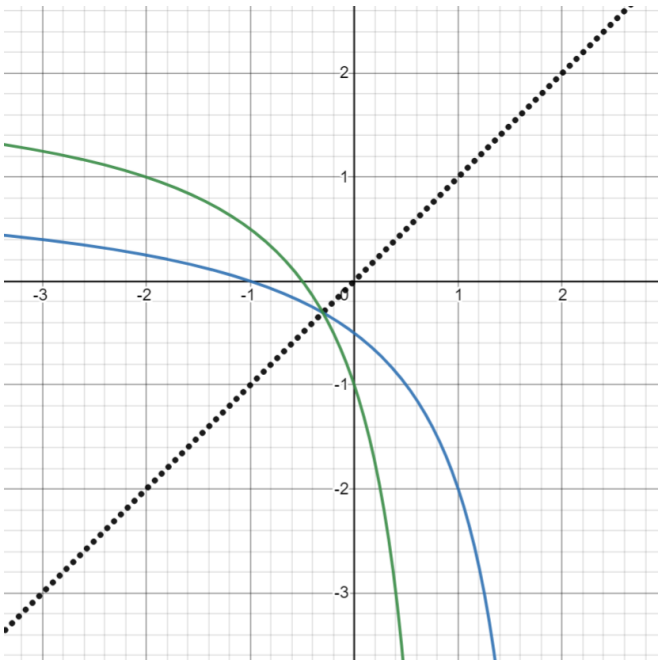


b.

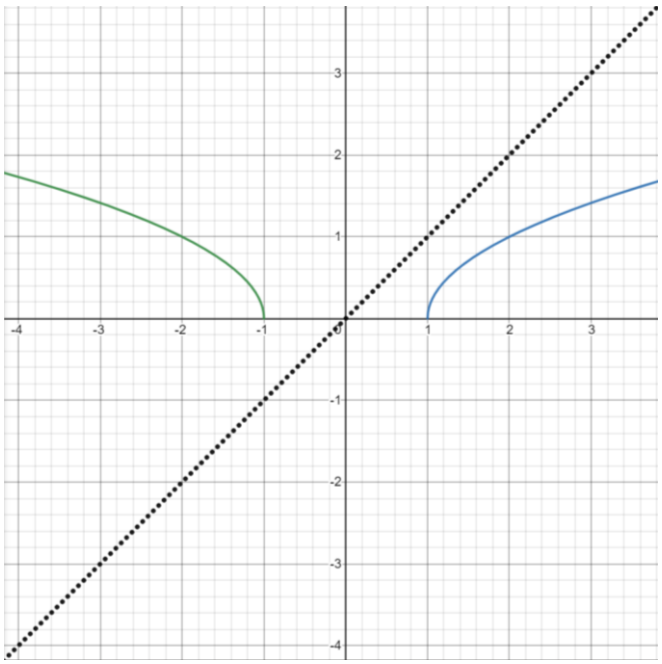




Copyright 2022, Jennifer Hill, DivideandConquerMath.com

**Example** Draw the inverse of the following graph.

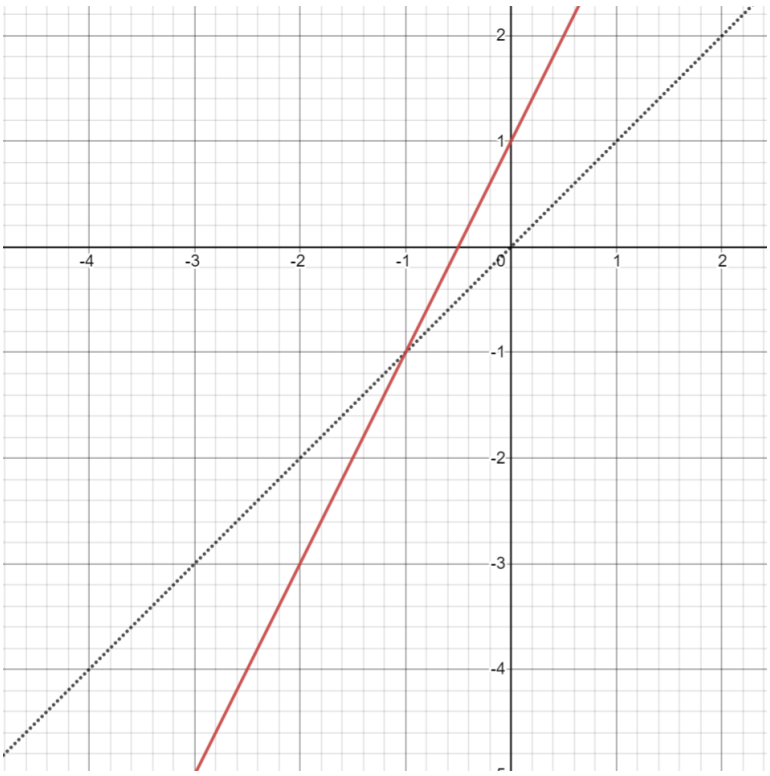




Copyright 2022, Jennifer Hill, DivideandConquerMath.com

**Lesson: Understanding the Graphs of Quadratic Functions**

Quadratic functions are functions of the form _____, where $a \neq 0$. But in previous lessons we worked on graphing quadratic functions, ie parabolas in another way. Let's review that first.

**<u>Examples</u>** Graph the following:

a. $f(x) = (x+2)^2 - 3$

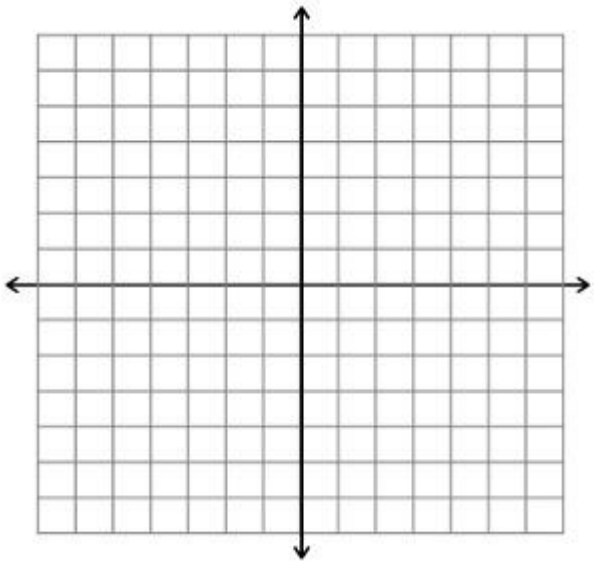

b. $g(x) = -(x-3)^2 + 1$

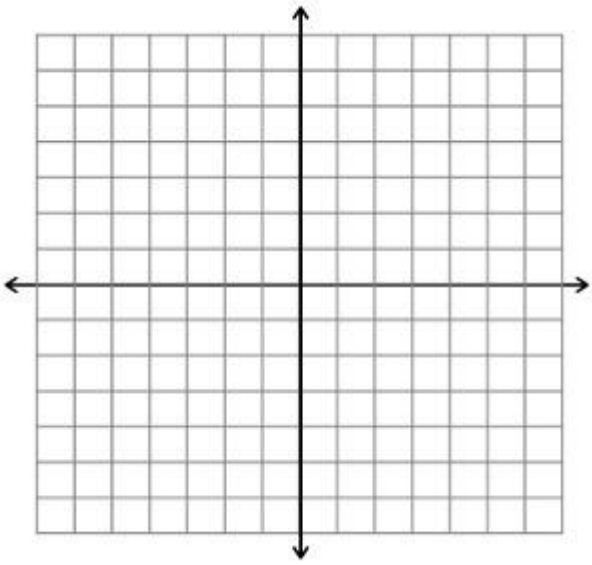

To begin, we will add on one more way to manipulate the graph of a parabola. Explain how to graph the follow:

a. $f(x) = 3x^2$
How do you interpret the 3?

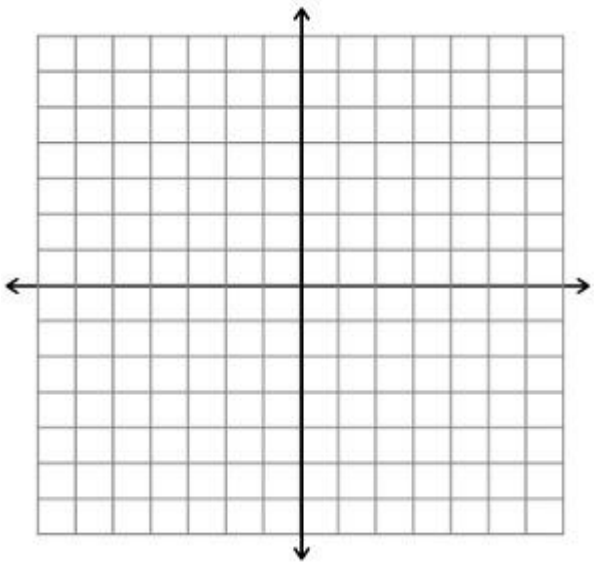

b. $g(x) = -\frac{1}{2}(x-2)^2 + 1$
How do you interpret the $-\frac{1}{2}$?

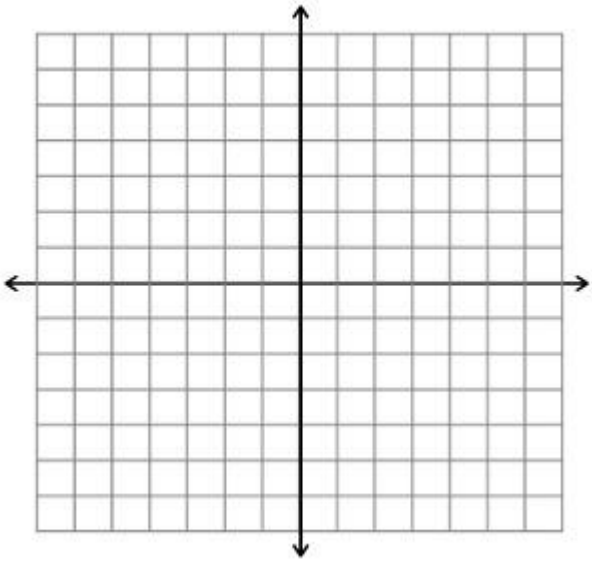



Copyright 2020, Jennifer Hill, DivideandConquerMath.com

**Examples** Graph the following:

a. $f(x) = -2(x+1)^2 + 3$

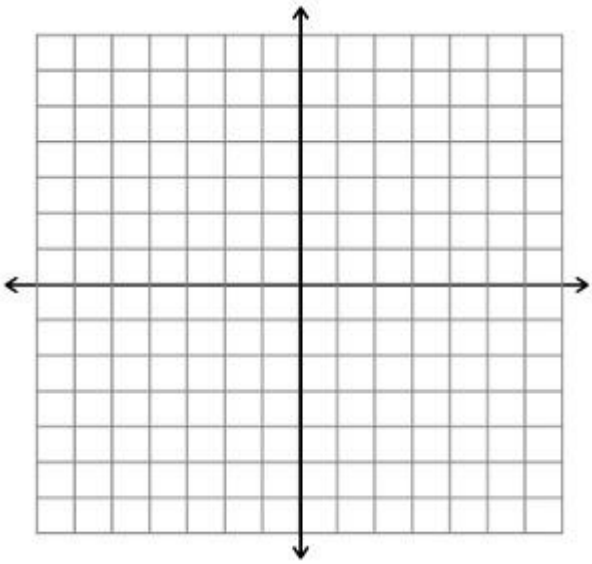

b. $g(x) = \frac{1}{3}(x-2)^2 - 2$

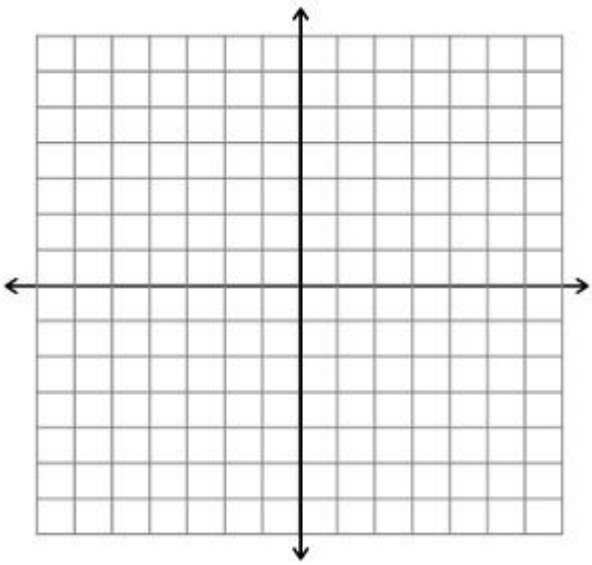

Using all of the examples we have discussed, what is another equation form for the parabola?

Explain some of the characteristics of a parabola that we get from this format:



Copyright 2020, Jennifer Hill, DivideandConquerMath.com

**Examples** For each of the following functions, find and state: (i) the vertex (ii) axis of symmetry (iii) x-intercepts (iv) y-intercepts (v) and then graph the function

a. $f(x) = (x-3)^2 - 4$

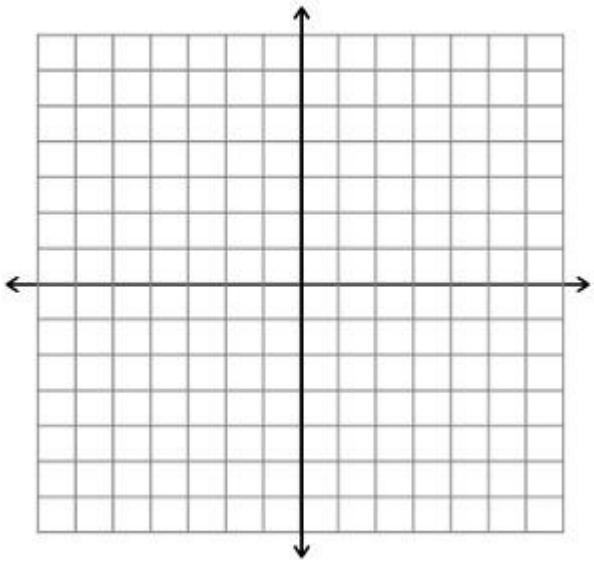

Vertex:

Axis of Symmetry:

X-intercepts:

Y-intercepts:

b. $f(x) = -2(x-3)^2 + 8$

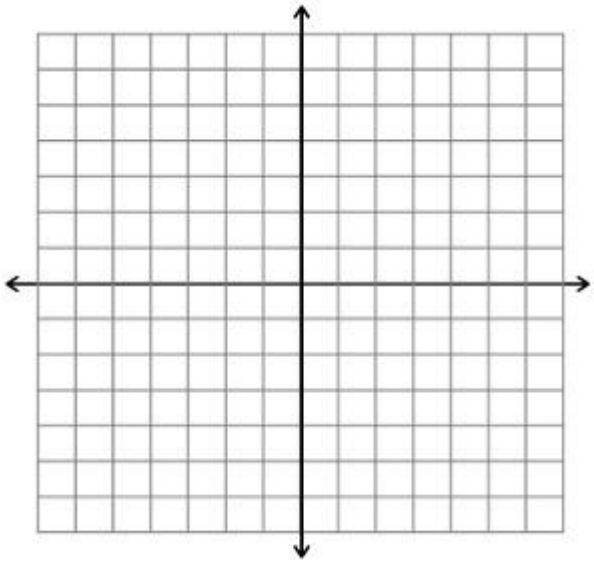

Vertex:

Axis of Symmetry:

X-intercepts:

Y-intercepts:



Copyright 2020, Jennifer Hill, DivideandConquerMath.com

**Examples** For each of the following functions, find and state: (i) the vertex (ii) axis of symmetry (iii) x-intercepts (iv) y-intercepts (v) and then graph the function

a. $f(x) = \frac{1}{4}(x+2)^2 - 3$

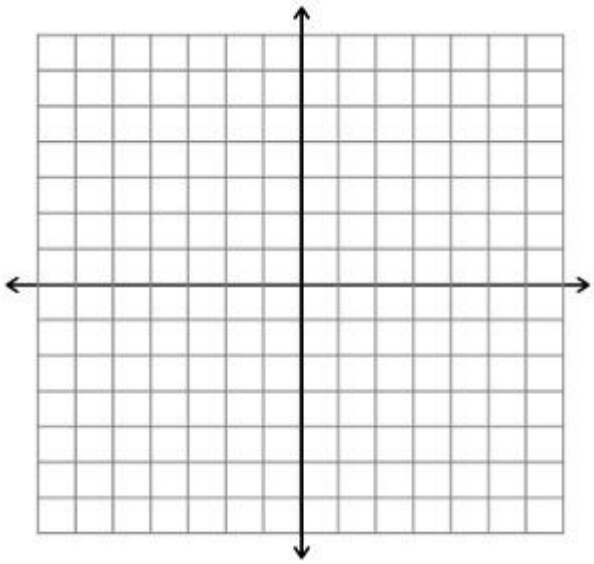

Vertex:

Axis of Symmetry:

X-intercepts:

Y-intercepts:

b. $f(x) = -\frac{1}{3}(x-1)^2 + 3$

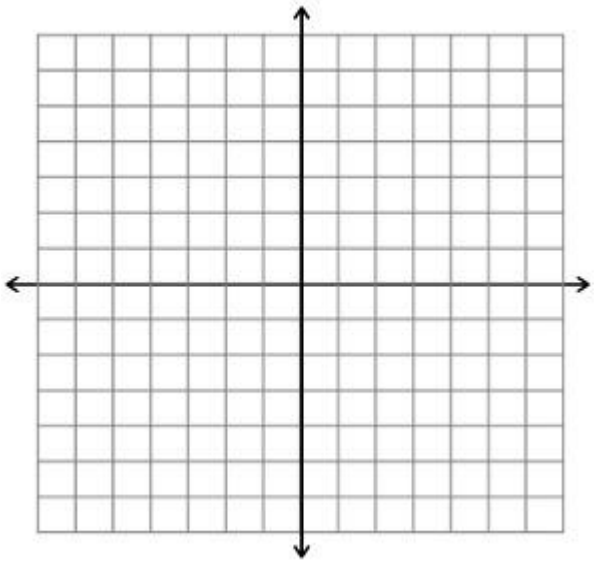

Vertex:

Axis of Symmetry:

X-intercepts:

Y-intercepts:



Copyright 2020, Jennifer Hill, DivideandConquerMath.com

**Examples: Understanding How Many X-Intercepts There Are**

**<u>Examples</u>** For each of the following functions, find and state: (i) the vertex (ii) axis of symmetry (iii) x-intercepts (iv) y-intercepts (v) and then graph the function

a. $f(x) = \frac{1}{2}(x+1)^2 - 8$

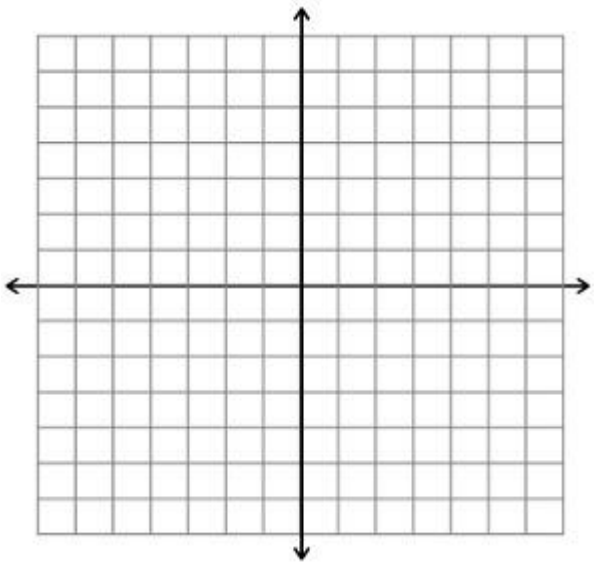

Vertex:

Axis of Symmetry:

X-intercepts:

Y-intercepts:

b. $f(x) = -2(x-3)^2$

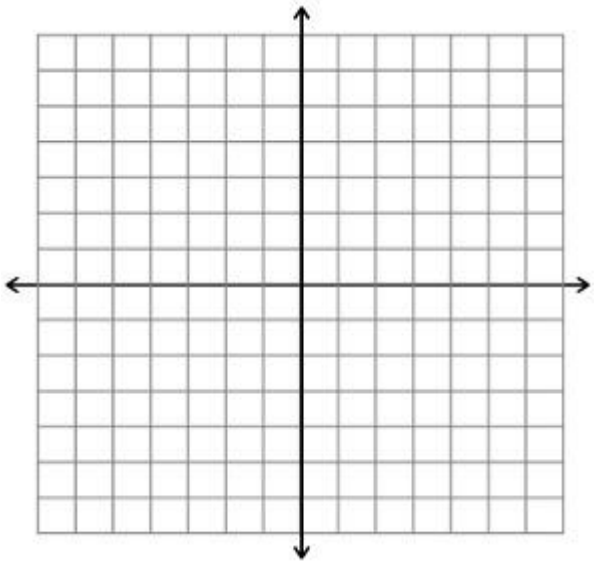

Vertex:

Axis of Symmetry:

X-intercepts:

Y-intercepts:



Copyright 2020, Jennifer Hill, DivideandConquerMath.com

**Examples** For each of the following functions, find and state: (i) the vertex (ii) axis of symmetry (iii) x-intercepts (iv) y-intercepts (v) and then graph the function

a. $f(x) = (x-2)^2 + 1$

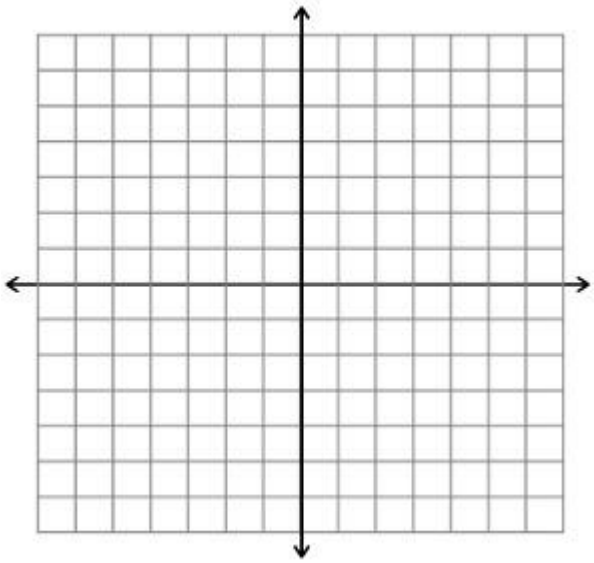

Vertex:

Axis of Symmetry:

X-intercepts:

Y-intercepts:

b. $f(x) = -(x+3)^2 - 1$

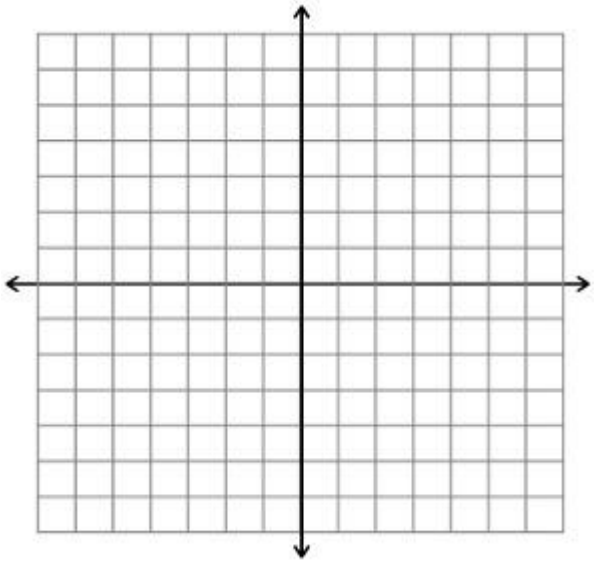

Vertex:

Axis of Symmetry:

X-intercepts:

Y-intercepts:



Copyright 2020, Jennifer Hill, DivideandConquerMath.com

**Lesson: Finding the Vertex of Quadratic Equations in the form $\boldsymbol{f(x) = ax^2 + bx + c}$**

What is the vertex formula?

Show how to use the vertex formula for $f(x) = 3x^2 + 6x - 2$

**<u>Examples</u>** Find the vertex of the following:

a. $f(x) = -x^2 + 4x - 2$

b. $f(x) = -\frac{1}{2}x^2 + 3x - 1$



Copyright 2020, Jennifer Hill, DivideandConquerMath.com

**Lesson: Putting Quadratics into the $f(x) = a(x-h)^2 + k$ Form**

Before you begin this lesson, you should already feel comfortable graphing an equation like $f(x) = 2(x-1)^2 + 3$. Graph this below:

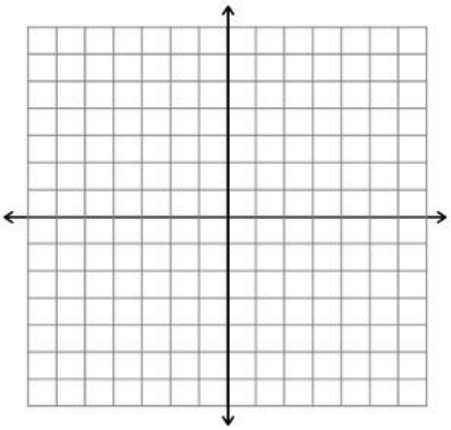

Now show all the steps to put $f(x) = 2x^2 - 8x + 2$ into $f(x) = a(x-h)^2 + k$ form:



Copyright 2020, Jennifer Hill, DivideandConquerMath.com

**Examples** Put the following quadratic functions into $f(x) = a(x-h)^2 + k$ form:

a. $f(x) = x^2 + 4x - 2$

b. $g(x) = x^2 + 6x + 10$

c. $h(x) = -x^2 + 2x - 4$

d. $y = 3x^2 + 6x - 12$



Copyright 2020, Jennifer Hill, DivideandConquerMath.com

**Examples: Putting Quadratics into the $f(x) = a(x-h)^2 + k$ Form**

**<u>Examples</u>** Put the following quadratic functions into $f(x) = a(x-h)^2 + k$ form:

a. $f(x) = \frac{1}{2}x^2 + x - 3$

b. $g(x) = -\frac{1}{3}x^2 + 4x - 2$

c. $y = x^2 + 3x + 2$



Copyright 2020, Jennifer Hill, DivideandConquerMath.com

**Lesson: Determining Whether a Quadratic Function will have a Minimum or a Maximum**

Using the form $f(x) = ax^2 + bx + c$, explain what determines whether the parabola opens up or down:

**<u>Examples</u>** Determine whether the following quadratics open upwards or downwards, and then determine their vertex:

a. $f(x) = -2x^2 + 4x - 2$ upwards downwards

b. $g(x) = -\frac{1}{2}x^2 - 2x + 2$ upwards downwards

c. $h(x) = x^2 + 6x + 1$ upwards downwards



Copyright 2020, Jennifer Hill, DivideandConquerMath.com

**Lesson: Applications of Quadratic Functions 1**

A ball is thrown upwards from a cliff 24 feet about the ground. The height h of the ball, in feet, t seconds after it is thrown is given by:

$$h(t) = -16t^2 + 32t + 24$$

How long does it take the ball to reach its maximum height?

What is the maximum height attained by the ball?



Copyright 2020, Jennifer Hill, DivideandConquerMath.com

**Lesson: Review of Quadratic Functions**

A polynomial function of degree n is a function of the form

$$f(x) = a_n x^n + a_{n-1} x^{n-1} + \cdots + a_1 x + a_0$$

Where $a_n, a_{n-1}, \ldots, a_1, a_0$ are any complex or real number, $a_n \neq 0$, and $n$ is a nonnegative integer.

What do we call $n$ in this equation?

What do we call $a_n$ in this equation?

What do we call $a_n x^n$ in this equation?

**<u>Example</u>** What is the degree, leading coefficient, and dominating term in the following?

a. $f(x) = 4x^4 - 5x^2 + x^7 + 100$

b. $g(x) = x\sqrt{3} - 5$

c. $h(x) = 7$



Copyright 2022, Jennifer Hill, DivideandConquerMath.com

What is a quadratic function?

What do we call the graph of a quadratic function?

Draw and label the parts of a parabola.

**<u>Example</u>** Sketch the graph of $f(x) = -(x+4)^2 - 2$

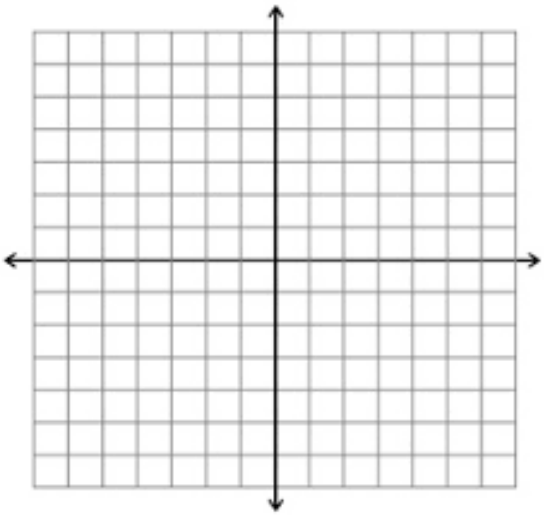

What is the **vertex form** of the equation of the parabola?



Copyright 2022, Jennifer Hill, DivideandConquerMath.com

**Example** Show how to use completing the square to put $f(x) = x^2 + 6x - 4$ in vertex form. Write out clear directions.

**Example** Use completing the square to write $f(x) = 3x^2 + 5x + 2$ in vertex form, then sketch the graph.



Copyright 2022, Jennifer Hill, DivideandConquerMath.com

**<u>Example</u>** Find the intercepts of $f(x) = 3x^2 + 5x + 2$

How many x-intercepts can a parabola have? Draw a little sketch of each situation.

How can you tell how many intercepts a parabola will have if the parabola is in the form: $f(x) = ax^2 + bx + c$



Copyright 2022, Jennifer Hill, DivideandConquerMath.com

What is the vertex formula for a parabola in the form $f(x) = ax^2 + bx + c$?

**<u>Example</u>** Use the vertex formula to find the vertex of the following: $f(x) = 2x^2 - 4x + 1$



Copyright 2022, Jennifer Hill, DivideandConquerMath.com

**Examples: Finding Intercepts, Vertices, Etc of Quadratic Functions**

Find the vertex, axis of symmetry, domain, range, intercepts, and intervals of increasing and decreasing. If the function is in $f(x) = ax^2 + bx + c$ form, put it in vertex form. Sketch the graph. If the function is in $f(x) = a(x-h)^2 + k$ form, put it into standard form.

a. $f(x) = -\frac{1}{2}x^2 - 3x - \frac{1}{2}$



Copyright 2022, Jennifer Hill, DivideandConquerMath.com

b. $f(x) = 2(x-1)^2 + 3$



Copyright 2022, Jennifer Hill, DivideandConquerMath.com

**Lesson: Graphs of Basic Polynomial Functions and Translations of the Basic Graphs**

Explain the graphs of $f(x) = x^2, f(x) = x^4, f(x) = x^6$, etc.

Explain the graphs of $f(x) = x^3, f(x) = x^5, f(x) = x^7$, etc.



Copyright 2022, Jennifer Hill, DivideandConquerMath.com

If we multiply the polynomial like so: $f(x) = ax^n$, what happens to the graph?

What happens if we have $f(x) = a(x-h)^n + k$?

**<u>Example</u>** Sketch the graphs:

a. $f(x) = (x-5)^5 + 3$

b. $f(x) = -2(x+1)^6 - 4$



Copyright 2022, Jennifer Hill, DivideandConquerMath.com

**Lesson: Graphs of Polynomial Functions, Turning Points, and End Behavior**

In the last video, we discuss the graphs of basic polynomials and translations. In this video, we will look at more complicated possibilities.

Below are the graphs of a few polynomials. What patterns do you notice?

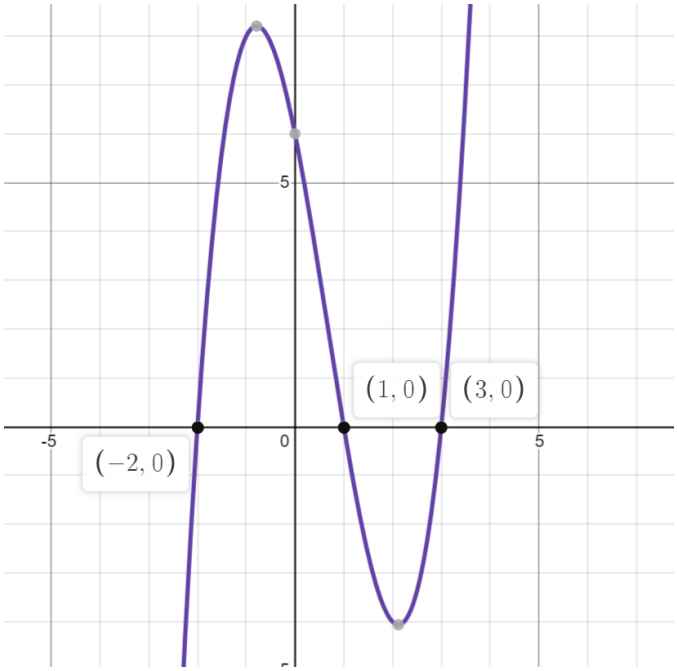


$$f(x) = x^3 - 2x^2 - 5x + 6 = (x-1)(x+2)(x-3)$$

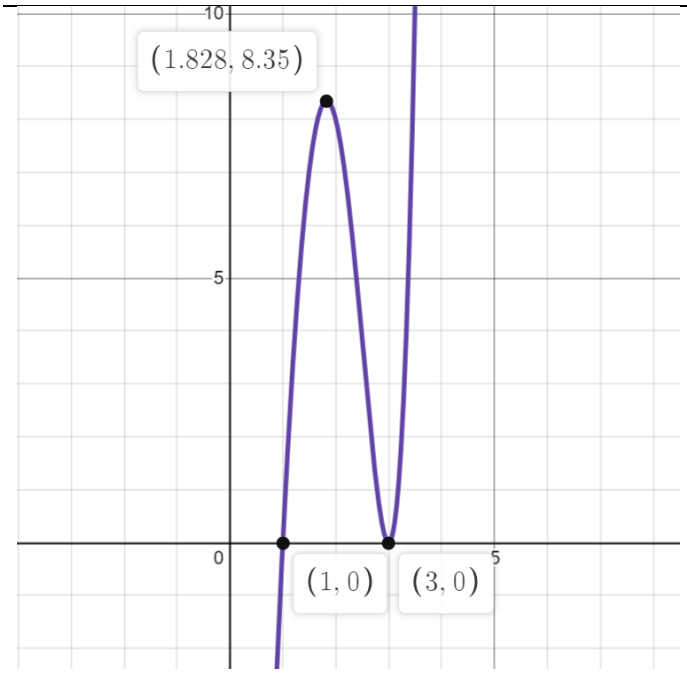


$$f(x) = x^5 - 7x^4 + 19x^3 - 37x^2 + 60x - 36$$
$$= (x-3)^2(x-1)(x-2i)(x+2i)$$



Copyright 2022, Jennifer Hill, DivideandConquerMath.com

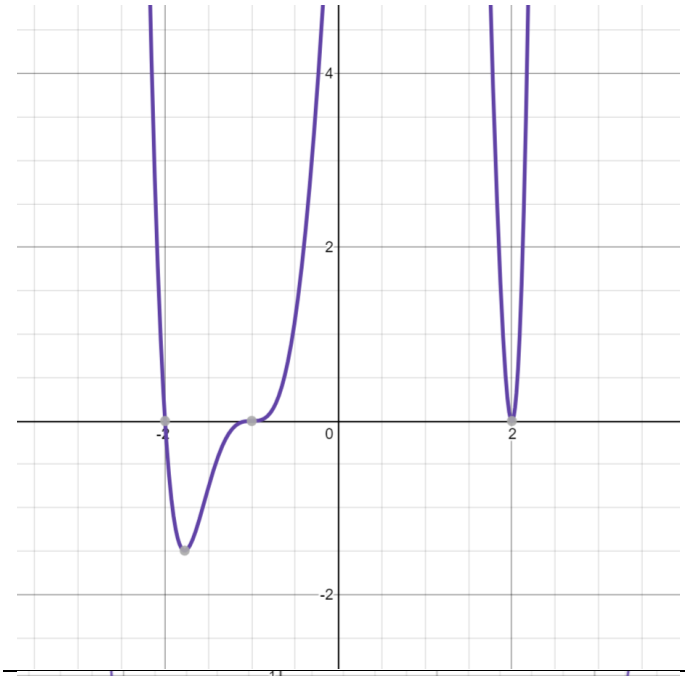


$f(x) = (x-2)^2(x+1)^3(x+2)$

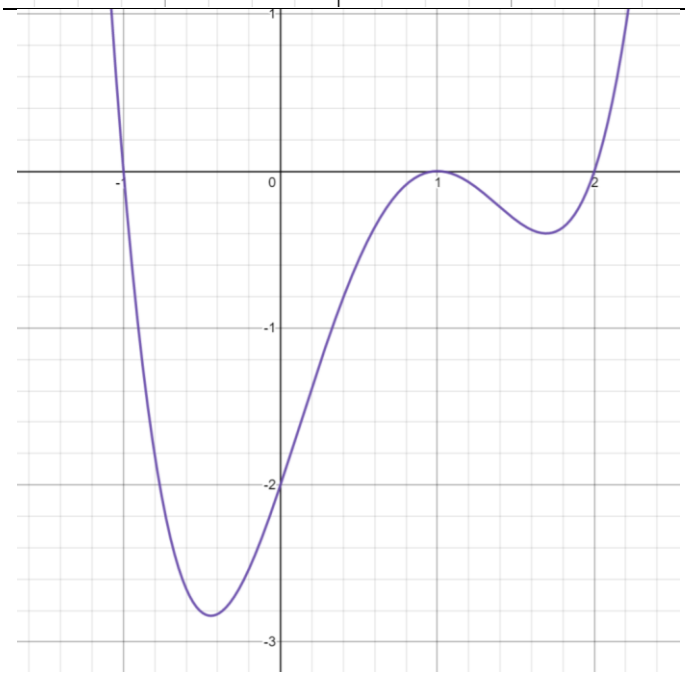


$f(x) = (x-1)^2(x+1)(x-2)$

What do you notice about the behavior of these graphs at zeros? Summarize this in your own words, it was discussed as a general pattern in the video.



Copyright 2022, Jennifer Hill, DivideandConquerMath.com

What are turning points and how many will a degree n polynomial have?

What is the end behavior of a polynomial and how do you determine it?

**<u>Example</u>** What are the number of turning points of the following and what is the end behavior of each?

a. $f(x) = x^2 + 3x + 2$

b. $f(x) = (x+1)^2(x-2)$

c. $f(x) = -\frac{1}{2}x(x-3)^4(x+1)^3(x+2)$



Copyright 2022, Jennifer Hill, DivideandConquerMath.com

List the steps required to graph a polynomial:

**<u>Example</u>** Graph $f(x) = x^3 - x^2 - 4x + 4$



Copyright 2022, Jennifer Hill, DivideandConquerMath.com

**<u>Example</u>** Graph $f(x) = -(x+1)(x-2)^2(x-3)$



Copyright 2022, Jennifer Hill, DivideandConquerMath.com

What is the relationship between x-intercepts, zeros, solutions, and factors of polynomials????



Copyright 2022, Jennifer Hill, DivideandConquerMath.com

**Examples: Graphs of Polynomial Functions, Turning Points, and End Behavior**

Graph the following polynomials:

a. $f(x) = x^3 + 5x^2 + 2x - 8$



Copyright 2022, Jennifer Hill, DivideandConquerMath.com

b. $f(x) = 3x^4 + 5x^3 - 2x^2$



Copyright 2022, Jennifer Hill, DivideandConquerMath.com

c. $f(x) = (x-1)^3(x+2)^2$



Copyright 2022, Jennifer Hill, DivideandConquerMath.com

**Lesson: The Intermediate Value Theorem and the Boundedness Theorem**

State the Intermediate Value Theorem

**<u>Example</u>** Using synthetic division to show $f(x) = -x^3 + 2x^2 - 4x + 5$ has a real zero between 1 and 2.

**<u>Example</u>** Using synthetic division to show $f(x) = x^4 - 4x^3 - x + 3$has a real zero between 0.5 and 1.



Copyright 2022, Jennifer Hill, DivideandConquerMath.com

State the Boundedness Theorem

**<u>Example</u>** Show that $f(x) = x^4 + 5x^2 + 3x - 7$ has no real zero less than -3.

**<u>Example</u>** Show that $f(x) = 2x^5 - x^4 + 2x^3 - 2x^2 + 4x - 4$ has no real zero greater than 2



Copyright 2022, Jennifer Hill, DivideandConquerMath.com

**Lesson: Synthetic Division and the Remainder Theorem**

The outcome of division can be restated using the division algorithm.

State the division algorithm:

Show how we use polynomial long division with $(x^2 - 3x - 1) \div (x + 2)$, and then restate the result using the format of the division algorithm.



Copyright 2022, Jennifer Hill, DivideandConquerMath.com

Now show how to do the operation $(x^2 - 3x - 1) \div (x + 2)$ with synthetic division:

Restate this result using the division algorithm:

**<u>Example</u>** Use synthetic division to perform: $\frac{4x^3-3x^2-7}{x+1}$. Rewrite the result using the division algorithm.



Copyright 2022, Jennifer Hill, DivideandConquerMath.com

So what are 3 keys about using synthetic division to remember?

What is the remainder theorem?



Copyright 2022, Jennifer Hill, DivideandConquerMath.com

**<u>Example</u>** Use the remainder theorem to find the desired functional values: $f(x) = -3x^4 + 5x^3 - 30x + 20, f(2)$. What is the equivalent division problem associated with this? Write the result of your division using the division algorithm.



Copyright 2022, Jennifer Hill, DivideandConquerMath.com

**Example** Use the remainder theorem to find the desired functional values: $f(x) = 3x^2 + 5, k = 3 - i$



Copyright 2022, Jennifer Hill, DivideandConquerMath.com

**Lesson: Synthetic Division and Potential Zeros of Polynomials**

What is a “zero” of a polynomial?

How does the remainder theorem help us to determine if we have a zero?

What are some other terms that we use for “zero” of a polynomial?



Copyright 2022, Jennifer Hill, DivideandConquerMath.com

**<u>Example</u>** Determine if the given k is a zero of the polynomial. If it is not, then what is the value of $f(k)$?

a. $f(x) = x^2 - 4x - 5; k = 5$

b. $f(x) = 2x^3 - 3x^2 + 5; k = 1$

c. $f(x) = x^2 - 2x + 2; k = 1 + i$



Copyright 2022, Jennifer Hill, DivideandConquerMath.com

**Lesson: The Factor Theorem**

What does the factor theorem say?

**<u>Example</u>** Determine whether $(x-1)$ is a factor of each polynomial:

a. $f(x) = 9x^4 - 13x^2 + 4$

b. $f(x) = 4x^3 + 10x^2 + 2x - 4$

Given the above, what can we say is also a zero for example a?



Copyright 2022, Jennifer Hill, DivideandConquerMath.com

**Example** Factor $f(x) = 3x^3 + 4x^2 - 17x - 6$ into linear factors given that $-3$ is a zero.

**Example** Factor $f(x) = 2x^3 - x^2 - 8x + 4$ into linear factors given that $\frac{1}{2}$ is a zero.



Copyright 2022, Jennifer Hill, DivideandConquerMath.com

**Lesson: The Rational Zeros Theorem**

The rational zeros theorem is a way to determine *possible* candidates for *rational* zeros of a polynomial function.

State the Rational Zeros Theorem:

**<u>Example</u>** Find all the possible rational zeros for $f(x) = 2x^3 - x^2 - 8x + 4$ and then factor into linear factors.



Copyright 2022, Jennifer Hill, DivideandConquerMath.com

**<u>Example</u>** Find all the possible rational zeros for $f(x) = 5x^4 - 19x + x^2 + 31x + 6$ and then factor into linear factors.



Copyright 2022, Jennifer Hill, DivideandConquerMath.com

**Lesson: The Fundamental Theorem of Algebra and the Number of Zeros Theorem**

What does the Fundamental Theorem of Algebra state?

What is the number of zeros theorem?

**<u>Example</u>** What is the maximum number of zeros that each polynomial could possibly have?

a. $f(x) = x^2 - 3x + 1$

b. $f(x) = x^{17} - 3x + 1$

c. $f(x) = 9$



Copyright 2022, Jennifer Hill, DivideandConquerMath.com

**Example** Find a polynomial $f(x)$ that has zeros $-3, 3$, and $1$, where $f(2) = -10$

**Example** Find a polynomial $f(x)$ that has zeros $6, -3$, and $-2$, where $f(1) = 20$



Copyright 2022, Jennifer Hill, DivideandConquerMath.com

**Lesson: Conjugate Zeros Theorem**

Before we can discuss the theorem, let's review a few properties of conjugates.

What is the conjugate of the following:

a. $3 + 2i$ b. $5 - 3i$ c. $-7 + i$

What is another way that we denote conjugates? Summarize the explanation in the video. Give an example of how this notation works.

What are some properties of conjugates?



Copyright 2022, Jennifer Hill, DivideandConquerMath.com

What is the conjugate zeroes theorem?

**<u>Example</u>** Find a polynomial function of least degree with only real coefficients and zeros $2$ and $(3 - i)$.



Copyright 2022, Jennifer Hill, DivideandConquerMath.com

**Example** Suppose $k = -i$ is one zero of $f(x) = x^4 + 26x^2 + 25$. What are the other zeros?

**Example** Factor $f(x) = 2x^3 + (3 - 2i)x^2 + (-8 - 5i)x + (3 + 3i)$ into linear factors given $k = 1 + i$ is a factor.

Before you begin, what is unique about this problem?



Copyright 2022, Jennifer Hill, DivideandConquerMath.com

**Lesson: Finding Zeros of a Polynomial Function**

In previous videos we discussed:

- The factor theorem
- The rational zeros theorem
- The fundamental theorem of algebra
- The number of zeros theorem
- The conjugate zeros theorem

Using all of these theorems, we can combine them to find the zeros of *any* polynomial.

What can we say about a polynomial function of odd degree with real coefficients?

What can we say about a polynomial function of even degree with real coefficients?

What if a polynomial doesn't have only real coefficients?



Copyright 2022, Jennifer Hill, DivideandConquerMath.com

**Example** Find all zeroes of the following polynomials.

a. $f(x) = x^3 - 21x - 20$

b. $f(x) = 2x^4 - x^3 + 7x^2 - 4x - 4$



Copyright 2022, Jennifer Hill, DivideandConquerMath.com

**Examples: Finding Zeros of a Polynomial Function**

Find all the zeros of the polynomials.

a. $f(x) = x^4 + 13x^2 + 36$

b. $f(x) = 2x^4 - 11x^3 + 4x^2 + 29x + 12$



Copyright 2022, Jennifer Hill, DivideandConquerMath.com

c. $f(x) = x^4 - 7x^3 + 17x^2 - x - 26$



Copyright 2022, Jennifer Hill, DivideandConquerMath.com

**Lesson: Descartes' Rule of Signs**

Let $f(x)$ be a polynomial function with real coefficients and a nonzero constant term, with terms in descending powers of x. Explain how to use Descartes' Rule of Signs:

**<u>Example</u>** Determine the number of different possibilities for the number of positive, negative, and nonreal complex zeroes:

a. $f(x) = 3x^5 + 4x^4 - x^3 + 2x - 1$



Copyright 2022, Jennifer Hill, DivideandConquerMath.com

b. $f(x) = x^6 + x^5 - x^4 + x^3 + x^2 - x + 1$

c. $f(x) = 3x^5 - 7x^3 + 6x + 8$



Copyright 2022, Jennifer Hill, DivideandConquerMath.com

**Lesson: The Basic Graphs of Rational Functions**

A rational function is a function of the form:

$\frac{f(x)}{g(x)}, g(x) \neq 0$

Where $f(x)$ and $g(x)$ are polynomials.

There are 2 graphs that we view as the most basic version of rational functions.

Make a table and graph $f(x) = \frac{1}{x}$

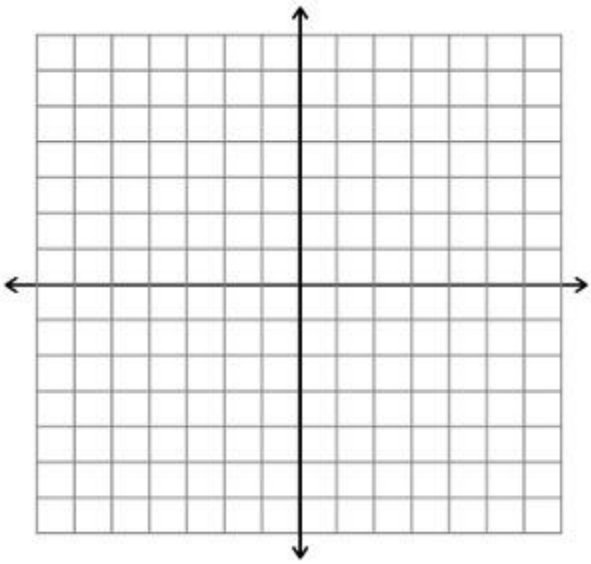

What is the domain and range?

Where does the graph not exist (ie where is it discontinuous)

What are the y-axis and x-axis for this graph?

What kind of symmetry does this graph have?



Copyright 2022, Jennifer Hill, DivideandConquerMath.com

Make a table and graph $f(x) = \frac{1}{x^2}$

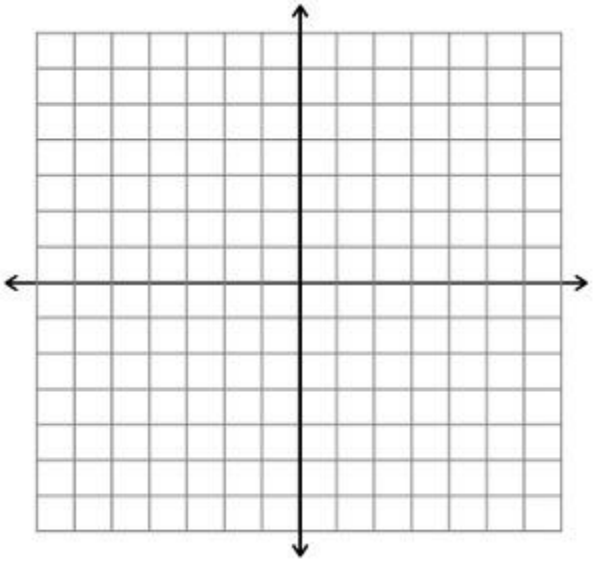

What is the domain and range?

Where does the graph not exist (ie where is it discontinuous)

What are the y-axis and x-axis for this graph?

What kind of symmetry does this graph have?



Copyright 2022, Jennifer Hill, DivideandConquerMath.com

**Example** Describe the translations for the following graphs, and then draw an approximate sketch of the graph.

a. $f(x) = \frac{1}{(x+1)^2} - 2$

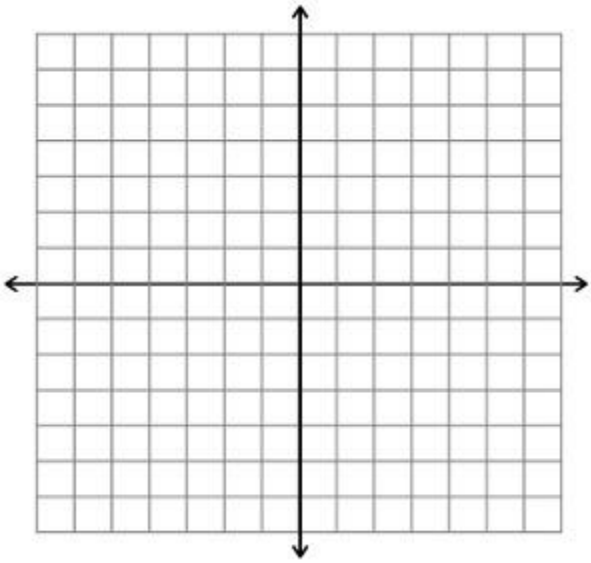

b. $g(x) = -\frac{2}{x} + 1$

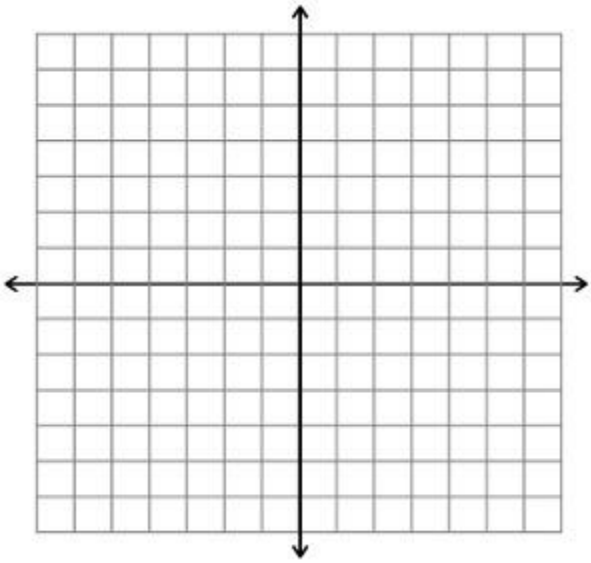



Copyright 2022, Jennifer Hill, DivideandConquerMath.com

Sketch what happens for odd powers of n for: $f(x) = \frac{1}{x^n}$, ie just draw a sketch of $y = \frac{1}{x^3}, y = \frac{1}{x^5}, y = \frac{1}{x^7}$

Sketch what happens for higher even powers of n for: $f(x) = \frac{1}{x^n}$, ie just draw a sketch of $y = \frac{1}{x^4}, y = \frac{1}{x^6}, y = \frac{1}{x^8}$



Copyright 2022, Jennifer Hill, DivideandConquerMath.com

**Lesson: Asymptotes of Rational Functions**

What is an informal definition of asymptotes?

Is it possible that a graph would graph an asymptote?

Here are the formal definitions of asymptotes:

A graph $f(x) = \frac{p(x)}{q(x)}$ $(q(x) \neq 0)$ has a

- **Vertical asymptote** if $|f(x)| \to \infty$ as $x \to a$. The asymptote is x=a.
- **Horizontal asymptote** if $f(x) \to b$ as $|x| \to \infty$. The asymptote is y=b.

What is super important about asymptote?

Where do you typically find vertical asymptotes?



Copyright 2022, Jennifer Hill, DivideandConquerMath.com

How can you determine horizontal asymptotes? Describe the two ways, and also explain how oblique asymptotes. (In other words, explain what we talked about in the video).



Copyright 2022, Jennifer Hill, DivideandConquerMath.com

**<u>Examples</u>** Find any vertical, horizontal, or oblique asymptotes.

a. $f(x) = \frac{x+2}{x^2+7x+12}$



Copyright 2022, Jennifer Hill, DivideandConquerMath.com

b. $f(x) = \frac{3x+1}{4x-2}$



Copyright 2022, Jennifer Hill, DivideandConquerMath.com

c. $f(x) = \frac{x^2+3x+2}{x^2-9}$



Copyright 2022, Jennifer Hill, DivideandConquerMath.com

d. $f(x) = \frac{x^2+x}{x+3}$



Copyright 2022, Jennifer Hill, DivideandConquerMath.com

**Examples: Finding Oblique Asymptotes**

Find all the asymptotes for the following functions.

a. $f(x) = \frac{x^2+2x}{2x+1}$

b. $f(x) = \frac{x^2+2}{x+1}$



Copyright 2022, Jennifer Hill, DivideandConquerMath.com

**Lesson: Graphing Rational Functions**

To learn how to graph rational functions, we will outline the steps and then graph. **Clearly write directions for each step as we go through this process!!!**

Graph $f(x) = \frac{x+3}{x^2+7x+10}$. Outline all the relevant steps discussed in the video.



Copyright 2022, Jennifer Hill, DivideandConquerMath.com

Graph $f(x) = \frac{x+1}{x-3}$. Outline all the relevant steps discussed in the video.



Copyright 2022, Jennifer Hill, DivideandConquerMath.com

Graph $f(x) = \frac{x^2+1}{x-3}$. Outline all the relevant steps discussed in the video.



Copyright 2022, Jennifer Hill, DivideandConquerMath.com

**Examples: Graphing Rational Functions**

Graph $f(x) = \frac{(x+2)^2}{(x-1)(x+3)}$. Outline all the relevant steps discussed in the video.



Copyright 2022, Jennifer Hill, DivideandConquerMath.com

Graph $f(x) = \frac{2x^2-3x+1}{x-2}$. Outline all the relevant steps discussed in the video.



Copyright 2022, Jennifer Hill, DivideandConquerMath.com

**Examples: Equations of Rational Functions**

Copy the graphs from the video and then describe how to find the equations of those graphs.



Copyright 2022, Jennifer Hill, DivideandConquerMath.com

**Variation**
**Video Notes**

The term "variation" refers to a particular way of describing how certain things relate to one another.

There are three types of variation we will look at. Write down the definitions for each, you will remember it better!

1. Direct Variation:

2. Inverse Variation

3. Joint Variation

It's also possible to combine different types of variation.



Copyright 2020, Jennifer Hill, DivideandConquerMath.com

The first thing we have to do is learn how to interpret and write variation equations.

**Examples** Write the variation equation:

a. P varies directly with Q

b. J varies inversely with L

c. H varies jointly with A and B

d. Z varies inversely with the square of R

e. M varies directly as the square root of N

f. Y varies jointly with the cube of M and the square root of L

g. M varies directly as L and inversely as N



Copyright 2020, Jennifer Hill, DivideandConquerMath.com

Now we can take a look at how to solve general variation equations.

**Example** Write down the detailed steps / directions for this example.

J varies directly with L. If J = 12 when L = 4, find J when L = 7.

Step 1:

Step 2:

Step 3:

Step 4:

Step 5:



Copyright 2020, Jennifer Hill, DivideandConquerMath.com

**Examples** Using the steps outlined from the previous example, try the following:

a. M varies inversely as the square of L. If M = 12 when L = 2, find M when L = 4.

b. A varies jointly with B and C. If A = 30 when B = 2 and C = 5, find A when B = 3 and C = 4.

c. L varies directly as M and inversely as N. If L = 15 when M = 5 and N = 2, find L when M = 7 and N = 3.



Copyright 2020, Jennifer Hill, DivideandConquerMath.com

**Example** Jada's weekly income varies directly with the amount of hours that she works. Last week, she earned $570 for working 38 hours. This week she worked 36 hours, how much will she earn?



Copyright 2020, Jennifer Hill, DivideandConquerMath.com

**Lesson: A Review of Variation**

Describe the 3 types of variation and outline any patterns that might help you remember.

Direct Variation

Inverse Variation

Joint Variation

Combined Variation



Copyright 2022, Jennifer Hill, DivideandConquerMath.com

**Example** If y varies directly with x, and y=15 when x=3, find y when x=6

**Example** If a varies jointly with b and c, and a=40 when b=2 and c=5, find a when b=3 and c=2.

**Example** If p varies inversely with m and directly with the square of t, and p=32 when t=2 and m=4, find p when t=3 and m=9



Copyright 2022, Jennifer Hill, DivideandConquerMath.com

**Example** Rewrite the following situations as variation.

a. $C = 2\pi r$, when C is the circumference of a circle and r is the radius.

b. $r = \frac{d}{t}$, where r is the speed when traveling d miles over t hours.

c. $f = \frac{mv^2}{r}$, where f is the centripetal force of an object of mass ma moving along a circle with radius r at velocity v.



Copyright 2022, Jennifer Hill, DivideandConquerMath.com

**Examples: Applications of Variation**

The circumference of a circle varies directly as the radius. A circle of radius 8in has a circumference of 50.27in. Find the circumference of the circle if the radius is 5in.

The current in a simple electrical circuit varies inversely as the resistance. If the current is 30 amps when the resistance is 10ohms, find the current if the resistance if 5ohms.

The volume of a gas varies inversely as the pressure and directly as the temperature. If a gas occupies a 2.6L volume at 600 kelvins (kelvin is a temperature unit) and a pressure of 24 newtons, find the volume at 240 kelvins and a pressure of 32 newtons.



Copyright 2022, Jennifer Hill, DivideandConquerMath.com

**Lesson: Exponential Functions**

An exponential function is a function of the form _____ where $a > 0, a \neq 1$.

**<u>Examples</u>** Graph the following functions, then determine their domain and range.

a. $f(x) = 2^x$

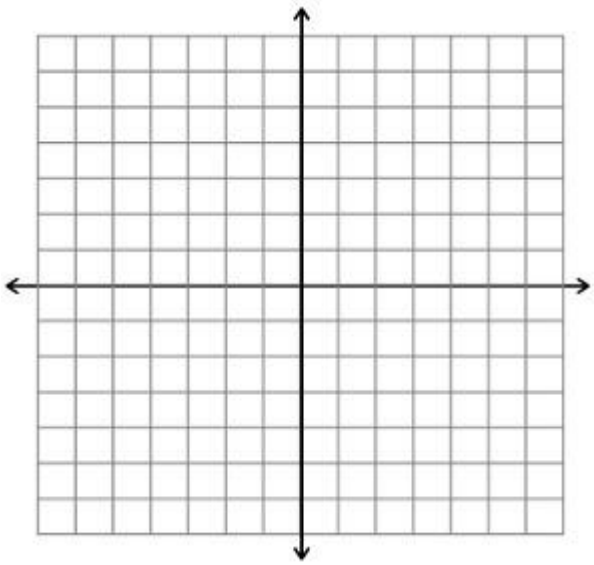

b. $g(x) = \left(\frac{1}{2}\right)^x$

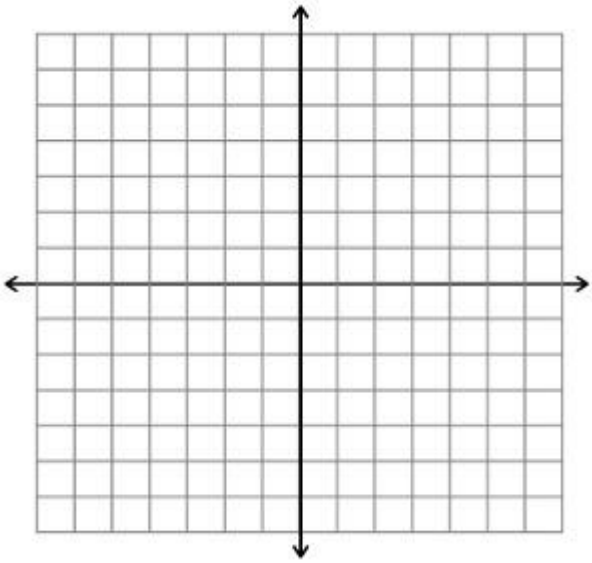

Using the graphs above, summarize some of the characteristics of these graphs:

The number e is an irrational number that is frequently used in math. What is an approximation of e?



Copyright 2020, Jennifer Hill, DivideandConquerMath.com

**<u>Example</u>** Graph $f(x) = 2^x, g(x) = e^x, h(x) = 3^x$ all on the same graph below for comparison:

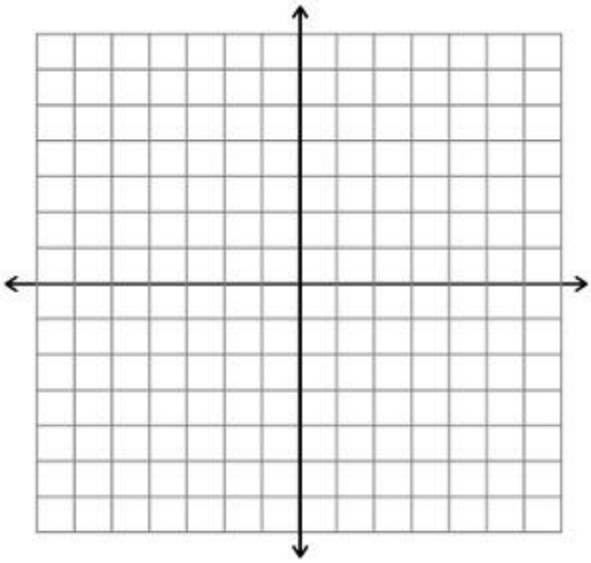

Translations work similarly to other graphs we have discussed. Using the graph of $f(x) = 2^x$ as a "base graph", draw the following graphs together on the same graph: $f(x) = 2^x, g(x) = 2^x + 3, h(x) = 2^{x-1}$

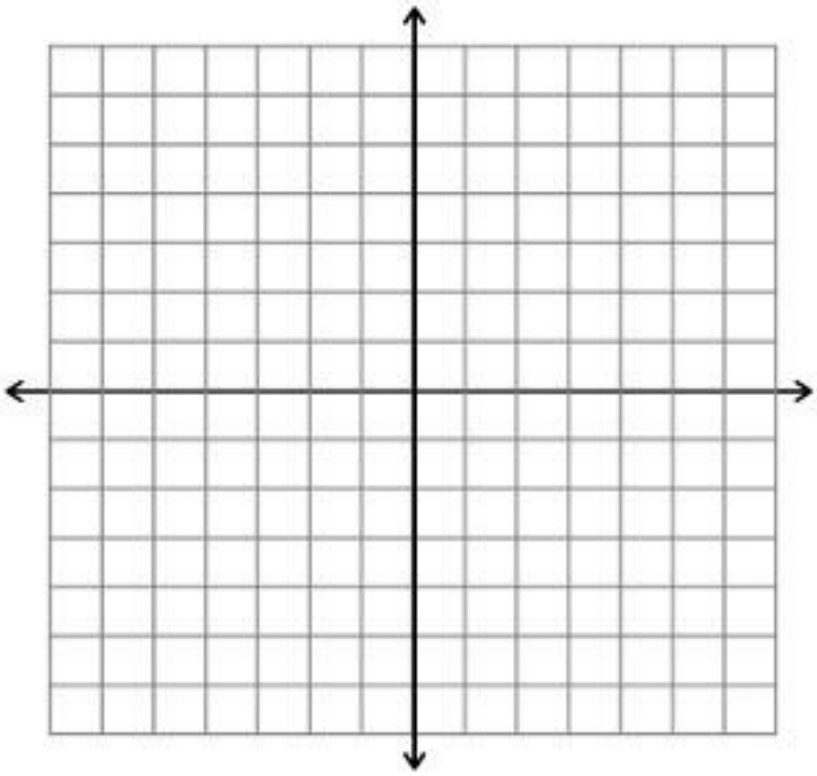



Copyright 2020, Jennifer Hill, DivideandConquerMath.com

**Lesson: Solving Exponential Equations**

In this lesson, we will solve equations that look like this:

$$3^x = 27 \qquad \text{or} \qquad 4^{x+3} = 8^{x-2}$$

To do this, we will write directions around the following example: $2^{3x} = 8^{x+1}$

**<u>Examples</u>** Solve:

a. $49^{x-3} = 7^{2x}$

b. $9^{4x} = 27^{x+4}$



Copyright 2020, Jennifer Hill, DivideandConquerMath.com

**<u>Examples</u>** Solve:

a. $5^{x-2} = \frac{1}{25}$

b. $\left(\frac{3}{5}\right)^{2x} = \left(\frac{27}{125}\right)^{x+2}$

c. $27^{3x+1} = 9^{4x+2}$



Copyright 2020, Jennifer Hill, DivideandConquerMath.com

**Lesson: A Review of Exponential Functions and their Graphs**

What is the form of a general exponential equation?

**<u>Example</u>** Let $f(x) = 3^x$ and $g(x) = \left(\frac{1}{2}\right)^x$. Find the following.

a. $f(-2)$

b. $f\left(\frac{3}{2}\right)$

c. $g(-3)$

d. $g(3.2)$



Copyright 2022, Jennifer Hill, DivideandConquerMath.com

Sketch the graph of $f(x) = 2^x$ and create a table to go with it.

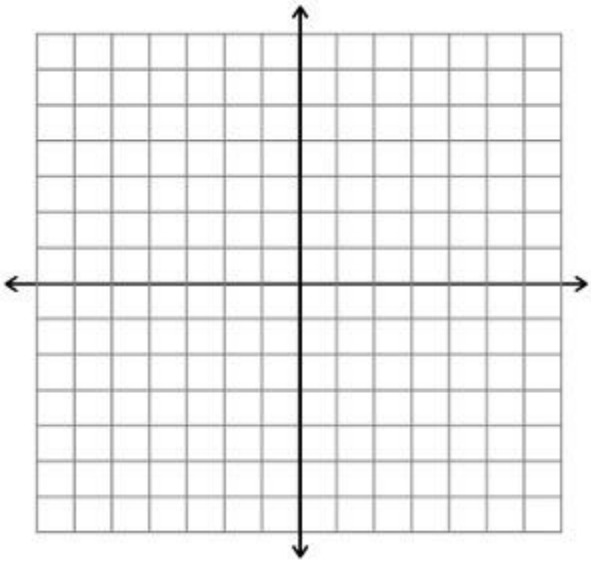

When will an exponential function $f(x) = a^x$ take this shape?

What is the x-axis for this graph?

What are 3 standard points to note here?

What is the domain and range?



Copyright 2022, Jennifer Hill, DivideandConquerMath.com

Sketch the graph of $f(x) = \left(\frac{1}{2}\right)^x$ and create a table to go with it.

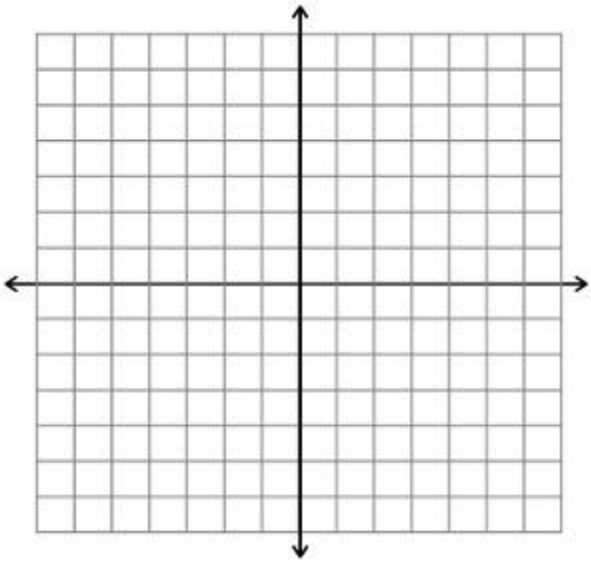

When will an exponential function $f(x) = a^x$ take this shape?

What is the x-axis for this graph?

What are 3 standard points to note here?

What is the domain and range?



Copyright 2022, Jennifer Hill, DivideandConquerMath.com

**Examples** Describe the translations and sketch the following graphs.

a. $f(x) = -3^x + 1$

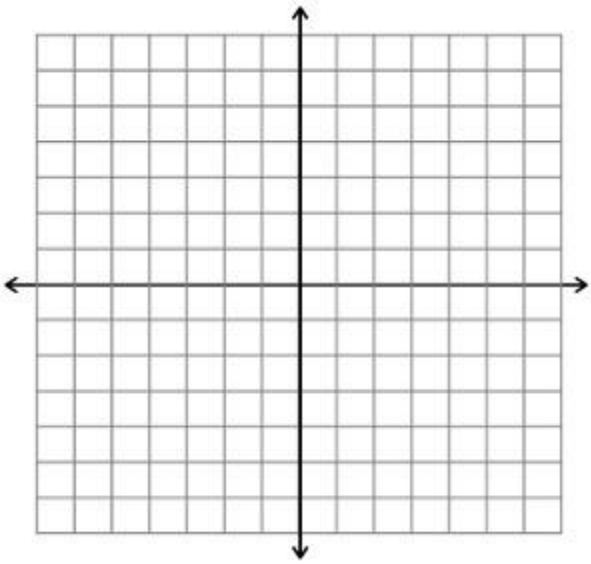

b. $f(x) = \left(\frac{1}{2}\right)^{x+1} - 2$

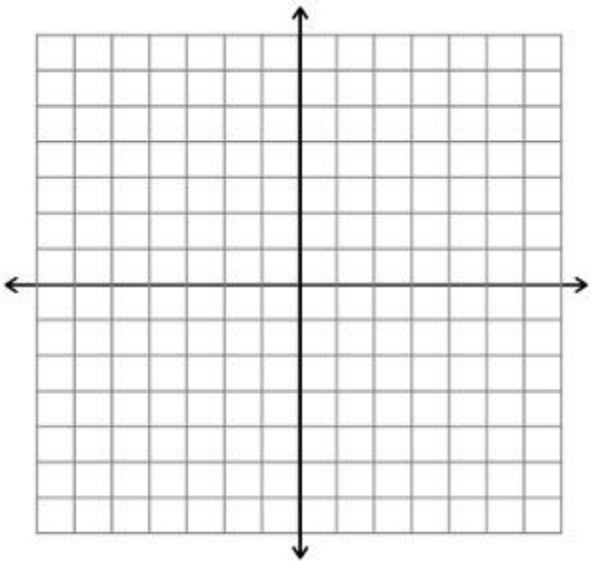



Copyright 2022, Jennifer Hill, DivideandConquerMath.com

**Lesson: Solving Basic Exponential Equations**

Outline the general steps to solve $3^{x+1} = 81$.

Outline the general steps to solve $4^{x-2} = 8^{x+1}$.



Copyright 2022, Jennifer Hill, DivideandConquerMath.com

**<u>Examples</u>** Solve the following.

a. $27^{2x} = 9^{x-1}$

b. $e^{3-x} = (e^2)^{-x}$

c. $\left(\sqrt{3}\right)^{x+3} = 9^x$



Copyright 2022, Jennifer Hill, DivideandConquerMath.com

**Examples** Solve the following.

a. $x^{\frac{3}{2}} = 8$

b. $x^{\frac{5}{2}} = 4$

c. $x^{-4} = \frac{1}{16}$



Copyright 2022, Jennifer Hill, DivideandConquerMath.com

**Lesson: Compound Interest**

What is the formula for compound interest and what does it mean?

**<u>Example</u>** Suppose $2000 is invested into an account paying 2.5% interest per year compounded monthly. How much is in the account after 10 years, and how much interest is earned in that time?

What else do we call the A from the compound interest formula?

What else do we call the P from the compound interest formula?



Copyright 2022, Jennifer Hill, DivideandConquerMath.com

**Example** In 5 years, you want to have $8000 in cash to buy a car (including taxes). Let's use savings to help us reach this goal.

a. You find an account with a 3.25% interest rate compounded biannually (2x a year). What amount would you have to deposit today to ensure you have $8000 in 5 years?

b. Let's pretend that as of today, you have $5000. What interested rate would you need to ensure that this will grow to $8000 in 5 years?



Copyright 2022, Jennifer Hill, DivideandConquerMath.com

What is the number e?

What is the formula for continuous compounding?

**<u>Example</u>** Suppose $2000 is invested into an account paying 2.5% interest per year compounded continuously. How much is in the account after 10 years, and how much interest is earned in that time?



Copyright 2022, Jennifer Hill, DivideandConquerMath.com

**Lesson: Intro to Logarithmic Functions**

First, we want to review how to function inverses of functions. Find the inverse of: $f(x) = 2x + 8$

Graph the exponential function $f(x) = 3^x$ below:

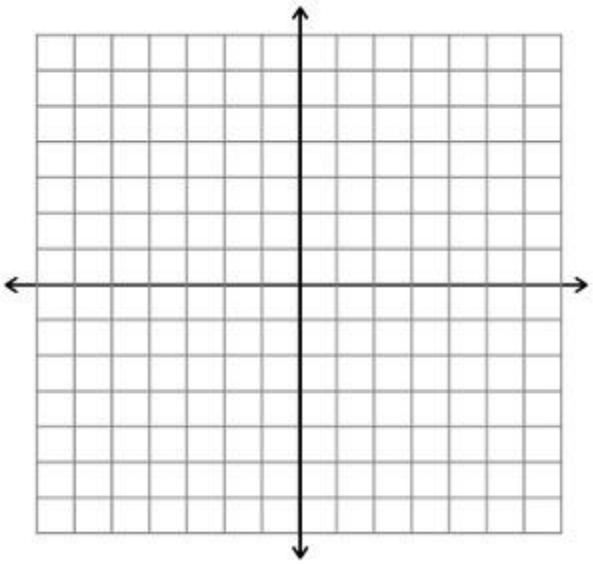

Recall the exponential functions are one-to-one, which means that they have inverses. Attempt to find the inverse of $f(x) = 3^x$ below:



Copyright 2020, Jennifer Hill, DivideandConquerMath.com

As we can see, there is an issue with finding the inverse – we have no way to solve for y! As such, we need new mathematics to help solve this.

Write down the definition of a logarithm:

**Examples** Write the following in exponential form:

a. $\log_3 81 = 4$

b. $\log_2 \frac{1}{8} = -3$

c. $\log_5 125 = 3$

d. $\log_9 9 = 1$

**Examples** Write the following in logarithmic form:

a. $2^4 = 16$

b. $3^0 = 1$

c. $6^{-2} = \frac{1}{36}$

d. $8^{\frac{1}{3}} = 2$



Copyright 2020, Jennifer Hill, DivideandConquerMath.com

Now we can finally determine what is the inverse of $f(x) = 3^x$:

There are a few common logarithms:

- $\log x$ means:

- $\ln x$ means:

There are also 2 key properties of logarithms:

1. $\log_a a = 1$: explain why this makes sense

2. $\log_a 1 = 0$: explain why this makes sense:



Copyright 2020, Jennifer Hill, DivideandConquerMath.com

**Lesson: Basics of Solving Logarithmic Equations and Evaluating Logarithms**

We want to solve equations that look like:

$$\log_3 x = 4 \qquad \text{or} \qquad \log_x 36 = 2$$

Before you begin, you should already be able to do the following:

a. Put $3^5$ in logarithmic form:

b. Put $\log_5 5 = 1$ in exponential form:

Now we can explain how to solve logarithmic equations using the example $\log_3(2x + 1) = 3$

**<u>Example</u>** Solve: $\log_x 16 = 4$



Copyright 2020, Jennifer Hill, DivideandConquerMath.com

**Example** Solve:

a. $\log_9 x = 2$

b. $\log_6(2x + 4) = 2$

Now we can also discuss how to evaluate logarithms. Explain how to evaluate: $\log_3 27$:

**Examples** Evaluate:

a. $\log_5 \frac{1}{25}$

b. $\log 100$



Copyright 2020, Jennifer Hill, DivideandConquerMath.com

**Examples** Evaluate:

a. $\ln e$

b. $\log_3 27$

c. $\log_{25} 5$

d. $\log \frac{1}{10}$



Copyright 2020, Jennifer Hill, DivideandConquerMath.com

**Lesson: How to Graph a Logarithm**

Before we begin, you should be able to do the following:

a. Convert to logarithmic form: $25 = 5^2$

b. Convert to exponential form: $\log_2 8 = 3$

c. Find the inverse of $y = 2^{\mathrm{x}}$

Now we can explain how to graph $y = \log_3 x$

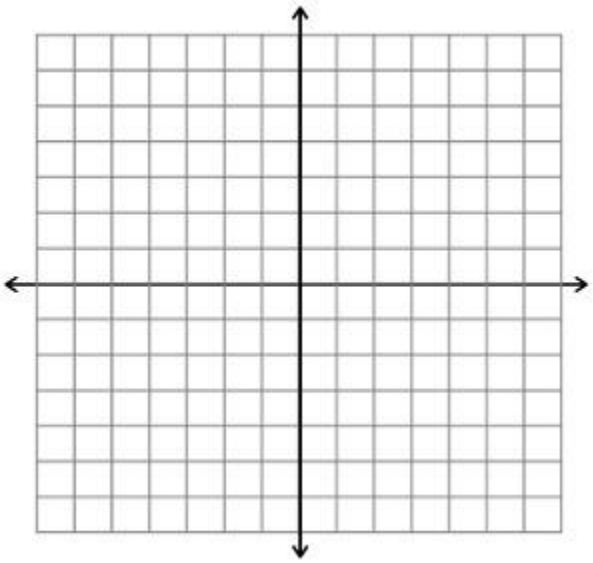

For comparison, also graph $f(x) = 3^x$ on the same graph above.



Copyright 2020, Jennifer Hill, DivideandConquerMath.com

**<u>Example</u>** Graph $y = \log_{\frac{1}{2}} x$ below:

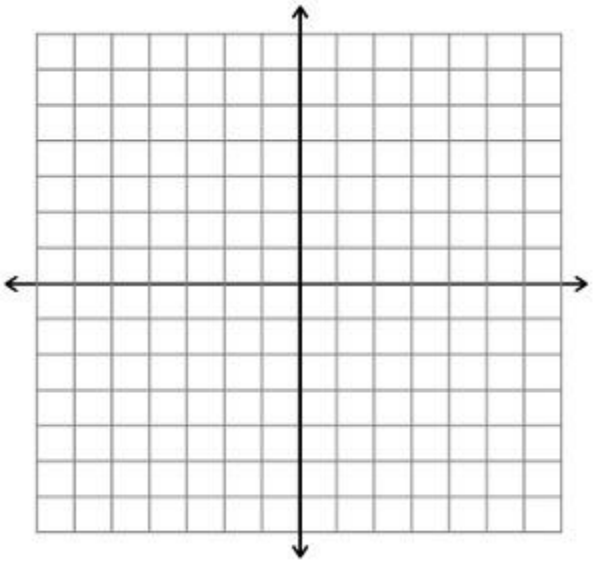



Copyright 2020, Jennifer Hill, DivideandConquerMath.com

**Lesson: Review of the Basics of Logarithmic Functions**

Explain how to find the inverse of $f(x) = 3^x$, and explain how this relates to logarithms.

Define a logarithm:

**<u>Example</u>** Write the following in logarithmic form.

a. $3^2 = 9$ b. $5^0 = 1$ c. $4^{-2} = \frac{1}{16}$

**<u>Example</u>** Write the following in exponential form.

a. $\log_3 1 = 0$ b. $\log_5 125 = 3$ c. $\log_3 81 = 4$



Copyright 2022, Jennifer Hill, DivideandConquerMath.com

**<u>Example</u>** Show how to solve the following basic logarithmic equations.

a. $\log_x 8 = 3$

b. $\log_3 x = -2$

c. $\log_{49} 7 = x$



Copyright 2022, Jennifer Hill, DivideandConquerMath.com

Create a table and show how to graph $f(x) = \log_2 x$

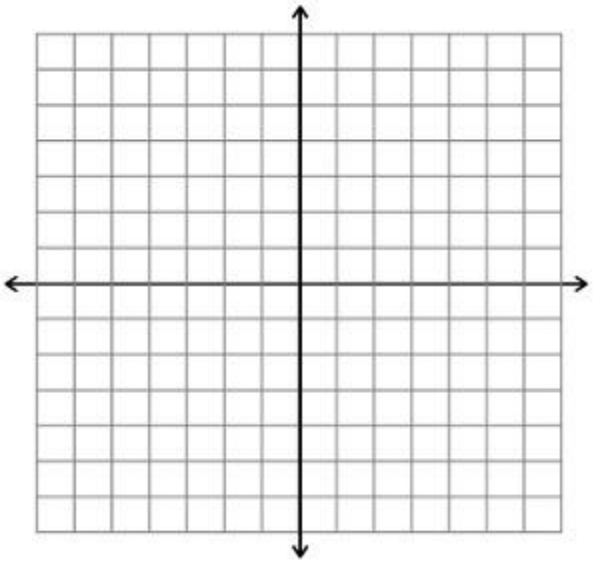

What 3 points can you easily find on the graph?

When does the graph take a shape like this for $f(x) = \log_a x$?

What is the y-axis for this graph?

What are the domain and range?



Copyright 2022, Jennifer Hill, DivideandConquerMath.com

Create a table and show how to graph $f(x) = \log_{\frac{1}{2}} x$

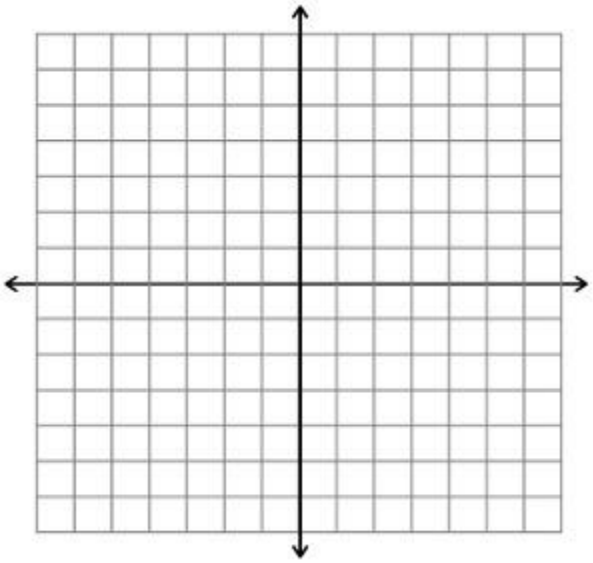

What 3 points can you easily find on the graph?

When does the graph take a shape like this for $f(x) = \log_a x$?

What is the y-axis for this graph?

What are the domain and range?



Copyright 2022, Jennifer Hill, DivideandConquerMath.com

**<u>Examples</u>** Graph the following: $g(x) = \log_2(x-1) + 1$

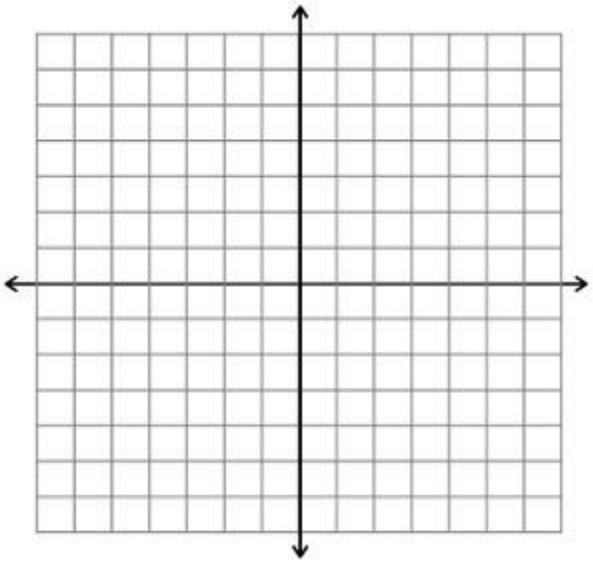



Copyright 2022, Jennifer Hill, DivideandConquerMath.com

**Lesson: Review of the Basics of Properties of Logarithsm**

List the major properties of logarithms.

Explain what the common logarithms mean:

$\log x =$

$\ln x =$



Copyright 2022, Jennifer Hill, DivideandConquerMath.com

**Examples** Expand the following as much as possible.

a. $\log_3\left(\frac{3x^3y^7}{\sqrt{z}}\right)$

b. $\ln\left(\sqrt[3]{x^2y}\right)$

c. $\log_3\sqrt{6}$

d. $\log_5\frac{25x^3y^2}{p^7r^3}$



Copyright 2022, Jennifer Hill, DivideandConquerMath.com

**Example** Write as a single logarithm.

a. $\log(x+2)+\log(x-2)-\log(x+3)$

b. $3\log_2 3+2\log_2 y-5\log_2 x$

c. $\frac{1}{2}\log_5 16+3\log_5 y^2-\log_5 x^7-\log_5 y$

d. $4\ln 2+\ln x^6-2\ln y^3-3\ln x^2$



Copyright 2022, Jennifer Hill, DivideandConquerMath.com

**Lesson: Change of Base Theorem**

State the change of base theorem:

**<u>Example</u>** Show how to evaluate the following:

a. $\log_5 17$

b. $\log_2 3$

c. $\log_{\frac{1}{2}} 5$



Copyright 2022, Jennifer Hill, DivideandConquerMath.com

**Lesson: Solving Exponential Equations**

Outline the steps to solve: $2^{x+3} = 7^{3x}$

**<u>Examples</u>** Solve the following.

a. $e^{x^2} = 100$

b. $e^{2x-3} * e^{3x} = 5e$



Copyright 2022, Jennifer Hill, DivideandConquerMath.com

**Examples** Solve.

a. $3(2)^{x+2} + 6 = 105$

b. $e^{2x} + 8e^{x} + 15 = 0$

c. $3^{2x} + 2(3^{x}) = 24$



Copyright 2022, Jennifer Hill, DivideandConquerMath.com

**Lesson: Solving Logarithmic Equations**

Outline the steps to solve: $\log(3 - x) = 0.75$

Compare these steps to: $\log(x + 20) = \log(x + 10) + \log(6)$. How are these problems different?



Copyright 2022, Jennifer Hill, DivideandConquerMath.com

**Examples** Solve the following.

a. $\log_4(x^3 + 37) = 3$

b. $\log x + \log x^3 = 4$



Copyright 2022, Jennifer Hill, DivideandConquerMath.com

**<u>Examples</u>** Solve the following.

a. $\log(x^2 - 4) - \log(x - 2) = \log(8)$

b. $\log(5 + 4x) - \log(3 + x) = \log 3$



Copyright 2022, Jennifer Hill, DivideandConquerMath.com

**Lesson: Solving Exponential and Logarithmic Formulas**

**<u>Examples</u>** Solve for the desired variable.

a. for b: $p = a + \frac{c}{\ln b}$

b. for n: $A = \frac{Pr}{1-(1+r)^{-n}}$



Copyright 2022, Jennifer Hill, DivideandConquerMath.com

c. for A: $\log A = \log B - C \log D$

d. for x: $D = 100 + 5 \log x$



Copyright 2022, Jennifer Hill, DivideandConquerMath.com

**Lesson: Models of Exponential Growth and Decay**

Explain the equation for the general model:

Some examples of growth can come from populations or investments. Some examples of decay can come from half-life/radioactive decay, or carbon dating.

Define the following:

Doubling time:

Half-life:

What is the formula for continuous compounding?



Copyright 2022, Jennifer Hill, DivideandConquerMath.com

**Example** A sample of 400g of radioactive lead decays to polonium according to the function: $A(t) = 400e^{-0.03t}$.

a. Find the amount of lead remaining after 5 years.

b. Find the half-life.

**Example** The amount of carbon-14 present in a paint after t years if given by $y = y_0 e^{-0.0002t}$. The paint contains 37% of its carbon-14. How old are the paintings?



Copyright 2022, Jennifer Hill, DivideandConquerMath.com

**Example** Find the doubling time of an investment earning 5% interest if interest is compounded continuously.

**Example** During an epidemic, the number of people who have never had a particular virus and are not immune decreases exponential, where this decline is modeled by the function: $f(x) = 20{,}000e^{-0.025t}$, where t is time in days.

a. How many people were susceptible at the beginning of the epidemic?

b. How many people are susceptible after 2 weeks?



Copyright 2022, Jennifer Hill, DivideandConquerMath.com

**Lesson: A Quick Review of the Basics of Solving Systems of Linear Equations**

Systems of equations are 2 or more equations in 2 or more variables. They can look like:

$\begin{cases} 2x + 3y = 6 \\ x - 3y = 3 \end{cases}$ or $\begin{cases} 2x - y + z = 8 \\ 5x + 2y - z = 9 \\ x - 4y + z = 10 \end{cases}$ or $\begin{cases} 3x + 2y - z = 7 \\ x - 4y + 2z = 8 \end{cases}$

A solution of a system is an ordered pair that is true in each equation of the system. Some systems have no solutions, and some systems have infinite solutions.

In this lesson, we will briefly review the main techniques to solve systems. We will focus on systems that have a solution.

**<u>Example</u>** Use the substitution method to solve: $\begin{cases} 3x - y = -4 \\ x + 3y = 12 \end{cases}$

**<u>Example</u>** Use the elimination method to solve: $\begin{cases} 3x - y = -4 \\ x + 3y = 12 \end{cases}$



Copyright 2022, Jennifer Hill, DivideandConquerMath.com

**<u>Example</u>** Solve: $\begin{cases} \frac{1}{2}x + \frac{1}{3}y = 4 \\ \frac{3x}{2} + \frac{3y}{2} = 15 \end{cases}$



Copyright 2022, Jennifer Hill, DivideandConquerMath.com

**<u>Example</u>** Solve: $\begin{cases} 2x + y + z = 9 \\ -x - y + z = 1 \\ 3x - y + z = 9 \end{cases}$



Copyright 2022, Jennifer Hill, DivideandConquerMath.com

**Examples: Systems of 3 Linear Equations with 3 Variables**

Solve: $\begin{cases} x + y + z = 2 \\ 2x + y - z = 5 \\ x - y + z = -2 \end{cases}$



Copyright 2022, Jennifer Hill, DivideandConquerMath.com

Solve: $\begin{cases} x + 2y + 3z = -11 \\ 3x - y + z = 0 \\ -2x + 3y - z = 4 \end{cases}$



Copyright 2022, Jennifer Hill, DivideandConquerMath.com

**Lesson: Systems with No Solutions or Infinite Solutions**

**<u>Example</u>** Solve: $\begin{cases} x + 4y - 3z = 2 \\ 2x - 5y + 2z = -8 \\ -3x - 12y + 9z = 7 \end{cases}$

**<u>Example</u>** Solve: $\begin{cases} 7x + 2y = 6 \\ 14x + 4y = 12 \end{cases}$



Copyright 2022, Jennifer Hill, DivideandConquerMath.com

**<u>Example</u>** Solve: $\begin{cases} 5x - 4y + z = 9 \\ y + z = 15 \end{cases}$

**<u>Example</u>** $\begin{cases} 3x - 2y + z = 15 \\ x + 4y - z = 11 \end{cases}$



Copyright 2022, Jennifer Hill, DivideandConquerMath.com

**<u>Example</u>** Solve: $\begin{cases} 2x + y - 3z = 0 \\ 4x + 2y - 6z = 0 \\ x - y + z = 0 \end{cases}$



Copyright 2022, Jennifer Hill, DivideandConquerMath.com

**Lesson: Solving Systems of Equations by Graphing**

We will now turn our attention to systems of equations.

## System of Equations

A system of equations refers to 2 or more equations that share 2 or more variables.

## Solution of a System of Equations

A solution of a system of equations is an ordered pair that is true in all equations.

Determine if the following pairs are solutions to the systems.

a. $(1,3)$
$x - 2y = -5$
$2x - 3y = -4$

b. $(-4, 3)$
$x + 3y = 5$
$2x + 3y = 1$

There are several ways to solve systems. The first method we will focus on is how to solve by graphing.

## Solving by Graphing

In this method, we graph both lines and determine the point of intersection if possible. We will examine all the possibilities.

## Example

Graph each line and determine the point of intersection to find the solution.

$y = 2x + 3$
$y = -\frac{1}{2}x - 2$

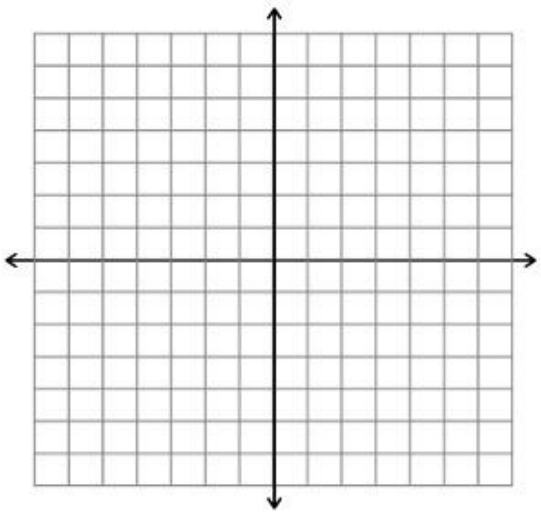



Copyright 2020, Jennifer Hill, DivideandConquerMath.com

**Example**

a. $y = -3x + 1$
$y = 2x - 4$

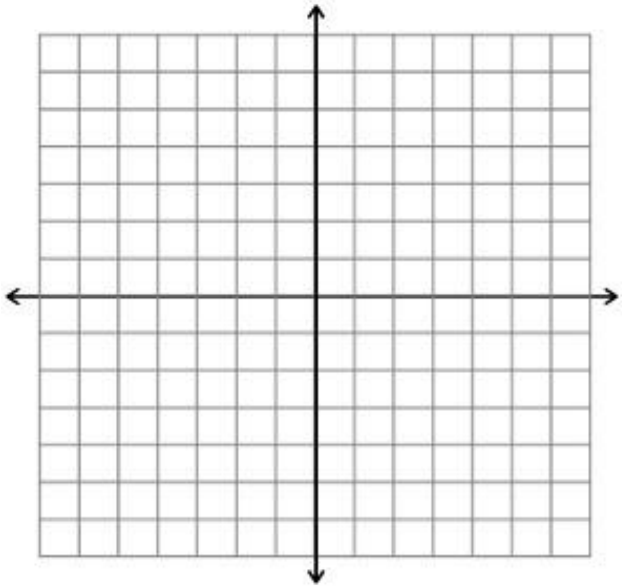

b. $y - \frac{1}{2}x = -4$
$y + 2x = 1$

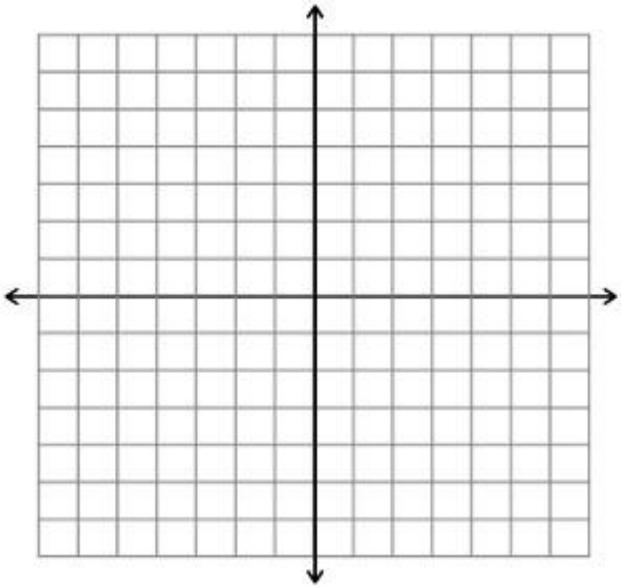



Copyright 2020, Jennifer Hill, DivideandConquerMath.com

There are two special situations that can occur with graphing.

**Example**

a. $y = -3x + 2$
$9x + 3y = 6$

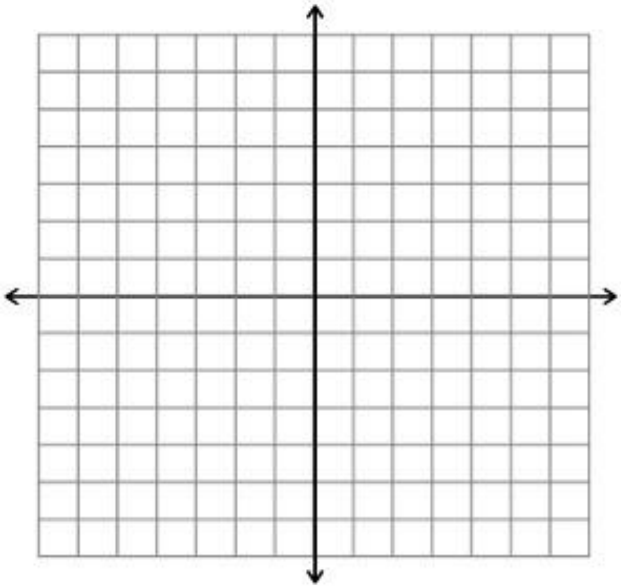

b. $y = -\frac{1}{2}x + 4$
$2x + 4y = 12$

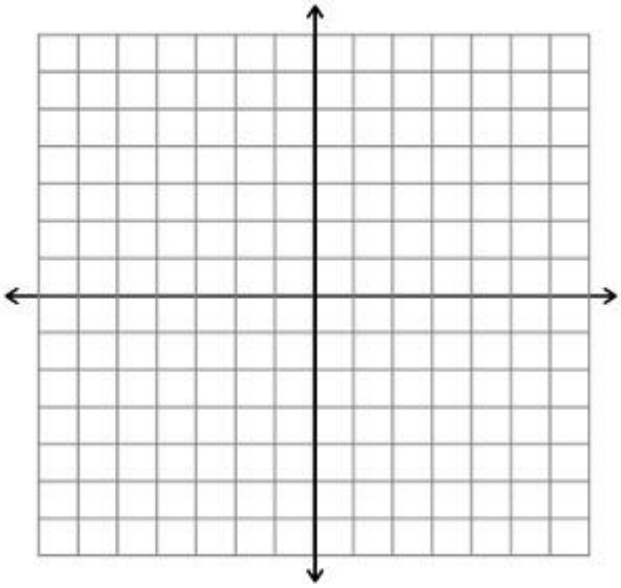



Copyright 2020, Jennifer Hill, DivideandConquerMath.com

**Lesson: Solving Systems of Equations by Substitution**

In this lesson, we will focus on the second method for solving systems: substitution.

Show how to use substitution with this example:

$2x + y = 6$

$3x + 5y = 9$

**<u>Example</u>** Solve the system using substitution

$x - 2y = 10$

$5x - 7y = 20$



Copyright 2020, Jennifer Hill, DivideandConquerMath.com

Below are 2 more complicated problems using substitution. Outline the steps shown in the video:

$-2x + 4y = 4$

$-2x + 6y = 6$

$2x - 5y = -4$

$8x - 9y = 6$



Copyright 2020, Jennifer Hill, DivideandConquerMath.com

Now let's see what happens when we get a problem with no solution or infinite solutions.

a. $9y - 18x = 5$

$2x - y = 3$

b. $x + 2y = -3$

$4x + 12 = -8y$



Copyright 2020, Jennifer Hill, DivideandConquerMath.com

**Lesson: Solving Systems of Equations by Elimination**

In this lesson, we will focus on the third method for solving systems: elimination.

Show how to use elimination with this example:
$3x - y = 8$

$2x + y = -3$

**<u>Example</u>** Use elimination to solve the system.

$4x + 2y = -6$
$3x - 2y = 6$



Copyright 2020, Jennifer Hill, DivideandConquerMath.com

Now let's examine a more complicated case of elimination. Write down how to approach these problems:

a. $3x - 6y = 12$

$5x - 2y = -4$

b. $5x - 10y = 5$
$2x - 3y = 6$



Copyright 2020, Jennifer Hill, DivideandConquerMath.com

Now let's investigate what happens in the situation where there is no solution or infinite solutions.

a. $5x - 2y = 1$
$-10x + 4y = 3$

b. $3x + y = 5$
$-9x - 3y = -15$



Copyright 2020, Jennifer Hill, DivideandConquerMath.com

**Lesson: Solving Systems of Equations that Require Clearing of Fractions**

**<u>Examples</u>**

a. $\frac{1}{6}x - \frac{1}{3}y = \frac{1}{2}$
$\frac{2}{5}x - \frac{3}{5}y = -\frac{6}{5}$

b. $-\frac{1}{2}x - \frac{3}{4}y = 1$
$\frac{1}{3}x + \frac{3}{2}y = -\frac{2}{3}$



Copyright 2020, Jennifer Hill, DivideandConquerMath.com

c. $\frac{1}{2}x + \frac{3}{5}y = 6$

$\frac{1}{4}x - \frac{1}{2}y = -9$



Copyright 2020, Jennifer Hill, DivideandConquerMath.com

**Lesson: Solving Systems of Equations that Require Clearing of Decimals**

**<u>Examples</u>**

a. $0.02x + 0.1y = 0.05$
$4x + 20y = 10$

b. $0.1x - 0.05y = 0.2$
$0.3x - 0.25y = 0.2$

c. $-0.4x + 1.3y = 1.$
$1.6x - 0.9y = 6.9$



Copyright 2020, Jennifer Hill, DivideandConquerMath.com

**Lesson: Applications of Systems**

The top of a rectangular desk is twice as long as it is wide. The perimeter of the desk is 180 inches. What are the dimensions of the desk?

Sarah bought 3 shirts and a scarf for $53. Marie bought 2 shirts and 3 scarves for $54. Find the cost of each item.

How many milliliters of a 5% acid solution and how many milliliters of a 17% acid solution must be mixed to obtain a 60 mL solution that is 15% acid?



Copyright 2020, Jennifer Hill, DivideandConquerMath.com

**Lesson: Systems of Equations with 3 Equations**

Show how to solve the system:

$x + 2y + 3z = -11$

$3x - y + z = 0$

$-2x + 3y - z = 4$



Copyright 2020, Jennifer Hill, DivideandConquerMath.com

Sometimes you will have missing variables. Show how to solve the following system that is missing some variables:

$x - 2y = -3$

$x + 6z = 3$

$2y - 4z = 6$



Copyright 2020, Jennifer Hill, DivideandConquerMath.com

Now let's look at an example where there is no solution versus infinite solutions:

$8x + 20y - 4z = 16$

$-2x - 5y + z = -4$

$10x + 25y - 5z = 20$

$x + 4y - 3z = 2$

$2x - 3y + 2z = -5$

$3x + 12y - 9z = 2$



Copyright 2020, Jennifer Hill, DivideandConquerMath.com

**Examples: More Examples of Systems of 3 Equations**

**<u>Example</u>** Solve the system:

$x + 3y - z = -2$

$-x + 3y - 2z = 5$

$2x + 4y + 2z = 4$



Copyright 2020, Jennifer Hill, DivideandConquerMath.com

**<u>Example</u>** Solve the following system:

$x - 2z = 2$

$-4y + 2z = -2$

$-x + 3y = -3$



Copyright 2020, Jennifer Hill, DivideandConquerMath.com

**<u>Example</u>** Solve the following system:

$x - 4y + 2z = -7$

$3x - 8y + z = 7$

$6x - 12y + 3z = 12$



Copyright 2020, Jennifer Hill, DivideandConquerMath.com

**Lesson: Using Matrices to Solve Systems of Linear Equations**

What is a matrix?

Show how to setup the associated **augmented matrix** for the system: $\begin{cases} 3x + 4y = 4 \\ x - y = 13 \end{cases}$

What are the dimensions of this matrix?

In general, how do we state dimensions of a matrix (circle): rows x columns columns x rows

**<u>Example</u>** What is the dimension of

a.

$$\begin{bmatrix} 3 & 2 & 4 & 1 \\ 7 & 8 & 1 & 2 \\ 9 & 5 & -2 & -3 \end{bmatrix}$$

b.

$$\begin{bmatrix} 2 & 4 \\ 5 & 3 \\ 8 & 3 \\ -1 & -4 \end{bmatrix}$$



Copyright 2022, Jennifer Hill, DivideandConquerMath.com

With matrices, there are 3 **row transformations** that we can make. We are not allowed to do anything else to a matrix. Write down these 3 transformations.

Now, recall, our goal in this lesson is to use a matrix to solve systems of linear equations. What do we call this specific solving process?

What do we call the “ideal form” of a matrix in its solved form?



Copyright 2022, Jennifer Hill, DivideandConquerMath.com

The Gauss-Jordan method has a goal of transforming a matrix into reduced-row echelon form or diagonal form. Draw a few examples of how the FINAL matrix should look after we transform it:

When we use the Gauss-Jordan method, which direction do we want to work on the matrix?

What is the general strategy to remember with this method?



Copyright 2022, Jennifer Hill, DivideandConquerMath.com

**Example** Outline the steps for the Gauss-Jordan method for the system: $\begin{cases} -2x + 4y = -4 \\ x - y = 4 \end{cases}$

**Example** Use Gauss-Jordan method for the system: $\begin{cases} 3x + 4y = 4 \\ x - y = 13 \end{cases}$



Copyright 2022, Jennifer Hill, DivideandConquerMath.com

**Lesson: Using The Gauss-Jordan Method for a System with 3 Equations**

**<u>Example</u>** Use the Gauss-Jordan method for the system: $\begin{cases} x + y + z = 2 \\ 2x + y - z = 5 \\ x - y + z = -2 \end{cases}$



Copyright 2022, Jennifer Hill, DivideandConquerMath.com

Another page for you to show your work …



Copyright 2022, Jennifer Hill, DivideandConquerMath.com

**Lesson: Using Matrices to Solve Systems of Linear Equations when There is No Solution or Infinite Solutions**

**<u>Example</u>** Use the Gauss-Jordan method to solve: $\begin{cases} 3x + 5y - z = -2 \\ 4x - y + 2z = 1 \\ -6x - 10y + 2z = 0 \end{cases}$

**<u>Example</u>** Use the Gauss-Jordan method to solve: $\begin{cases} 3x + 5y = -2 \\ 9x + 15y = -6 \end{cases}$



Copyright 2022, Jennifer Hill, DivideandConquerMath.com

**<u>Example</u>** Use the Gauss-Jordan method to solve: $\begin{cases} x - 2y + 3z = 6 \\ 2x - y + 2z = 5 \end{cases}$



Copyright 2022, Jennifer Hill, DivideandConquerMath.com

**<u>Example</u>** Use the Gauss-Jordan method to solve: $\begin{cases} 5x - 4y + z = 0 \\ x + y = 0 \\ -10x + 8y - 2z = 0 \end{cases}$



Copyright 2022, Jennifer Hill, DivideandConquerMath.com

**Examples: Using Matrices to Solve Systems of Linear Equations (any type of solutions)**

Use the Gauss-Jordan method to solve the following.

a. $\begin{cases} x + 4y - z = 6 \\ 2x - y + z = 3 \\ 3x + 2y + 3z = 9 \end{cases}$



Copyright 2022, Jennifer Hill, DivideandConquerMath.com

b. $\begin{cases} 2x + y - 3z = 0 \\ 4x + 2y - 6z = 0 \\ x - y + z = 0 \end{cases}$



Copyright 2022, Jennifer Hill, DivideandConquerMath.com

c. $\begin{cases} 3x - 2y + z = 15 \\ x + 4y - z = 11 \end{cases}$



Copyright 2022, Jennifer Hill, DivideandConquerMath.com

**Lesson: Nonlinear Systems of Equations**

Nonlinear systems of equations involve at least one equation that is not linear. Some examples look like this:

$\begin{cases} x^2 - y = 8 \\ x + y = -4 \end{cases}$ or $\begin{cases} x^2 + y^2 = 4 \\ |x| + y = 2 \end{cases}$

Similar to systems of linear equations, we can still use substitution or elimination to solve the system. However, the best method to use tends to depend on the type of system you are trying to solve. Additionally, you might have to use both methods.

What is one potential issue that can happen with solving systems of nonlinear equations and what should you do about this?

**When one equation is linear and the other is not, it is usually best to use the substitution method.**

**<u>Example</u>** Solve the system: $\begin{cases} x^2 + y = 8 \\ x - y = -2 \end{cases}$



Copyright 2022, Jennifer Hill, DivideandConquerMath.com

**When both variables in both equations are squared, it's usually best to use elimination.**

**<u>Example</u>** Solve the system: $\begin{cases} x^2 + y^2 = 25 \\ x^2 + 2y^2 = 9 \end{cases}$

**Sometimes you will have to use both the substitution and elimination methods.**

**<u>Example</u>** Solve the system: $\begin{cases} x^2 - xy + y^2 = 5 \\ 2x^2 + xy - y^2 = 10 \end{cases}$



Copyright 2022, Jennifer Hill, DivideandConquerMath.com

Now let's look at a few other examples to get a sense of how to use these methods!

**<u>Example</u>** Solve the system: $\begin{cases} x^2 + y^2 = 9 \\ -|x| + y = 0 \end{cases}$

**<u>Example</u>** Solve the system: $\begin{cases} 3x^2 + y^2 = 3 \\ 4x^2 + 5y^2 = 26 \end{cases}$



Copyright 2022, Jennifer Hill, DivideandConquerMath.com

**Lesson: Properties of Matrices: Equality, Addition, Subtraction, and Scalar Multiplication**

When are 2 matrices equal?

**<u>Example</u>** What values of x, y, z, and w will make the matrices equal?

$$\begin{bmatrix} 2+x & 3-w \\ 7 & 3 \end{bmatrix} = \begin{bmatrix} 5 & 4 \\ 2-y & 2+z \end{bmatrix}$$

When can you add 2 matrices?



Copyright 2022, Jennifer Hill, DivideandConquerMath.com

What is the definition of matrix subtraction?

What is scalar multiplication with a matrix?

List the properties of scalar multiplication for matrices:



Copyright 2022, Jennifer Hill, DivideandConquerMath.com

**<u>Example</u>** Let $A = \begin{bmatrix} 3 & 2 \\ 1 & 8 \end{bmatrix}, B = \begin{bmatrix} 7 & 2 & 1 \\ 0 & 4 & 1 \end{bmatrix}, C = \begin{bmatrix} 0 & 7 \\ 1 & 3 \end{bmatrix}, D = \begin{bmatrix} 2 & 3 \\ 1 & 2 \\ 1 & 0 \end{bmatrix}, E = \begin{bmatrix} 7 & 2 & 1 \\ 1 & 0 & 0 \end{bmatrix}$. Complete the following operations, if possible.

a. $A + C$

b. $B - D$

c. $B - E$

d. $2B + E$

e. $2A - 3C$



Copyright 2022, Jennifer Hill, DivideandConquerMath.com

**Lesson: Matrix Multiplication**

First, let's review dimension. What is the dimension of the following matrices?

$A = \begin{bmatrix} 3 & 2 \\ 1 & 8 \end{bmatrix}$

$B = \begin{bmatrix} 7 & 2 & 1 \\ 0 & 4 & 1 \end{bmatrix}$

$D = \begin{bmatrix} 2 & 3 \\ 1 & 2 \\ 1 & 0 \end{bmatrix}$

To understand how to multiply matrices, let's use the following 2 examples:

a. $\begin{bmatrix} 2 & 7 \\ -4 & 3 \end{bmatrix} \begin{bmatrix} 5 & -1 \\ 3 & 2 \end{bmatrix}$

b. $\begin{bmatrix} 1 & 2 & 3 \\ 0 & 1 & 2 \end{bmatrix} \begin{bmatrix} 1 & -2 \\ 1 & 0 \\ 7 & 2 \end{bmatrix}$



Copyright 2022, Jennifer Hill, DivideandConquerMath.com

**<u>Example</u>** Let $A = \begin{bmatrix} 3 & 2 \\ 1 & 8 \end{bmatrix}, B = \begin{bmatrix} 7 & 2 & 1 \\ 0 & 4 & 1 \end{bmatrix}, C = \begin{bmatrix} 0 & 7 \\ 1 & 3 \end{bmatrix}, D = \begin{bmatrix} 2 & 3 \\ 1 & 2 \\ 1 & 0 \end{bmatrix}, E = \begin{bmatrix} 7 & 2 & 1 \\ 1 & 0 & 0 \end{bmatrix}$. Complete the following operations, if possible.

a. $AC$

b. $CA$

Using the above example, what can we say about matrix multiplication and commutativity?



Copyright 2022, Jennifer Hill, DivideandConquerMath.com

List the properties of matrix multiplication:

**<u>Example</u>** Let $A = \begin{bmatrix} 3 & 2 \\ 1 & 8 \end{bmatrix}, B = \begin{bmatrix} 7 & 2 & 1 \\ 0 & 4 & 1 \end{bmatrix}, C = \begin{bmatrix} 0 & 7 \\ 1 & 3 \end{bmatrix}, D = \begin{bmatrix} 2 & 3 \\ 1 & 2 \\ 1 & 0 \end{bmatrix}, E = \begin{bmatrix} 7 & 2 & 1 \\ 1 & 0 & 0 \end{bmatrix}$. Complete the following operations, if possible.

a. $BC$

b. $ED$

c. $CB$



Copyright 2022, Jennifer Hill, DivideandConquerMath.com

**Lesson: Inverse Matrices**

What is the 2x2 identity matrix?

What is the 3x3 identity matrix?

How do we describe the general nxn identity matrix?



Copyright 2022, Jennifer Hill, DivideandConquerMath.com

**<u>Example</u>** Multiply $A = \begin{bmatrix} 3 & 2 & 1 \\ 8 & 1 & 7 \\ 3 & 1 & 0 \end{bmatrix}$ by the identity matrix as follows:

a. $AI$

b. $IA$

What can we generalize about the identity matrix?



Copyright 2022, Jennifer Hill, DivideandConquerMath.com

How do we describe a multiplicative inverse of a real number?

Some matrices have inverses. For a matrix A, what notation denotes its inverse?

What is the property of inverse matrices?

What are the steps for finding an inverse matrix?



Copyright 2022, Jennifer Hill, DivideandConquerMath.com

**<u>Example</u>** Find the inverses of the following matrices. Prove your answer by checking it: $\begin{bmatrix} 6 & -2 \\ 2 & 4 \end{bmatrix}$



Copyright 2022, Jennifer Hill, DivideandConquerMath.com

**<u>Example</u>** Find the inverses of the following matrices. Prove your answer by checking it: $\begin{bmatrix} 3 & 1 & 2 \\ 1 & -1 & 1 \\ 2 & 1 & -1 \end{bmatrix}$



Copyright 2022, Jennifer Hill, DivideandConquerMath.com

**<u>Example</u>** Find the inverses of the following matrices. Prove your answer by checking it: $\begin{bmatrix} 3 & 2 \\ 6 & 4 \end{bmatrix}$



Copyright 2022, Jennifer Hill, DivideandConquerMath.com

**Lesson: Using Inverse Matrices to Solve Systems**

We've previously talked about using matrices to solve systems. We will look at another way to do that in this lesson. Show another way to set up the system using matrices (as well as the relevant notation):

$$\begin{cases} x + y + z = 6 \\ 2x + 3y - z = 7 \\ 3x - y - z = 6 \end{cases}$$

Now, using our setup above, explain the reasoning for how inverse can help solve a system:



Copyright 2022, Jennifer Hill, DivideandConquerMath.com

**<u>Example</u>** Use inverse matrices to solve: $\begin{cases} -x + y = 1 \\ 2x - y = 1 \end{cases}$



Copyright 2022, Jennifer Hill, DivideandConquerMath.com

**<u>Example</u>** Solve the system: $\begin{cases} x + y + z = 6 \\ 2x + 3y - z = 7 \\ 3x - y - z = 6 \end{cases}$ using inverse matrices.



Copyright 2022, Jennifer Hill, DivideandConquerMath.com

**Lesson: How to Calculate the Determinate of a Matrix**

Every n x n matrix has a real number associated with it called the **determinant.** What is the notation to represent this?

**<u>Example</u>** Show, in detail, how to calculate the determinants of the following matrices.

a. $A = \begin{bmatrix} 2 & 4 \\ -5 & 7 \end{bmatrix}$

b. $B = \begin{bmatrix} -5 & 1 \\ -3 & 4 \end{bmatrix}$



Copyright 2022, Jennifer Hill, DivideandConquerMath.com

**<u>Example</u>** Show, with illustrations, how to calculate the determinant of $A = \begin{bmatrix} 1 & 2 & 3 \\ -2 & 1 & -3 \\ 3 & 4 & -2 \end{bmatrix}$

The 2x2 "sub" matrices that we calculate are called minors. The symbol $M_{ij}$ represents the minor that results when row i and column j are eliminated. Using the matrix above, describe the following minors.

$M_{11} =$

$M_{32} =$



Copyright 2022, Jennifer Hill, DivideandConquerMath.com

The number that we multiply the minor against is called the **cofactor.** Draw an illustration to show whether a cofactor will be positive or negative:

**<u>Example</u>** Using the matrix below, describe the minor associated with each cofactor AND determine whether the cofactor is positive or negative. You do not need to calculate the determinant.

$$A = \begin{bmatrix} 2 & 4 & 6 \\ 1 & 3 & 5 \\ -3 & -5 & -1 \end{bmatrix}$$

a. 2

b. 3

c. -3



Copyright 2022, Jennifer Hill, DivideandConquerMath.com

**<u>Example</u>** Show how to efficiently calculate the determinants of the following matrices. EXPLAIN YOUR REASONING FOR WHY YOU DID IT THE WAY THAT YOU DID.

a. $A = \begin{bmatrix} 2 & 7 & 8 \\ -1 & 0 & 1 \\ 3 & 5 & 1 \end{bmatrix}$

b. $B = \begin{bmatrix} 9 & -3 & 1 \\ 2 & 3 & 0 \\ 5 & 2 & 0 \end{bmatrix}$



Copyright 2022, Jennifer Hill, DivideandConquerMath.com

**Lesson: Determinant Theorems**

**Theorem 1:** If every element (or column) of a matrix is 0, then the determinant will be 0.

**<u>Example</u>**: find the determinant of $A = \begin{bmatrix} 0 & 0 & 0 & 0 \\ 4 & 2 & 8 & 9 \\ 3 & 2 & 8 & 4 \\ 9 & 3 & 1 & 7 \end{bmatrix}$

**Theorem 2:** If the rows of a matrix A are the corresponding columns of a matrix B, then the determinants are equal.

**<u>Example:</u>** Calculate both determinants: $A = \begin{bmatrix} 1 & 0 & 3 \\ 0 & 1 & 1 \\ 3 & 2 & 0 \end{bmatrix}, B = \begin{bmatrix} 1 & 0 & 3 \\ 0 & 1 & 2 \\ 3 & 1 & 0 \end{bmatrix}$



Copyright 2022, Jennifer Hill, DivideandConquerMath.com

**Theorem 3:** If any 2 rows (or columns) of a matrix are interchanged, then the determinants are negatives of one another.

**<u>Example</u>** Find the determinants of: $A = \begin{bmatrix} 2 & 4 \\ 5 & 6 \end{bmatrix}$ and $B = \begin{bmatrix} 5 & 6 \\ 2 & 4 \end{bmatrix}$

**Theorem 4:** Suppose matrix B is formed by multiplying every element in a row or columns in a matrix A by a real number k. Then the determinant is $|B| = k|A|$.

**<u>Example:</u>** Find the determinants of: $A = \begin{bmatrix} 2 & 1 \\ 3 & 6 \end{bmatrix}$ and $B = \begin{bmatrix} 8 & 4 \\ 3 & 6 \end{bmatrix}$



Copyright 2022, Jennifer Hill, DivideandConquerMath.com

**Theorem 5:** If two rows (or columns) of a matrix are identical, then the determinant will be 0.

**<u>Example</u>** Find the determinant of: $A = \begin{bmatrix} 4 & 4 \\ 4 & 4 \end{bmatrix}$

**Theorem 6:** Changing a row (or column) or a matrix by adding it to a constant times another row (or column) does not change the determinant of the matrix.

**<u>Example</u>** Find the determinant of $A = \begin{bmatrix} 1 & 2 \\ 5 & 8 \end{bmatrix}$. Then create a matrix B by taking adding $3 *$ (row 3) to row 1. Find the new determinant.



Copyright 2022, Jennifer Hill, DivideandConquerMath.com

**Theorem 7:** If a matrix is in triangular form (all 0s either above or below the diagonal), then the determinant is found by multiplying the elements down the diagonal.

**<u>Example</u>**: Find the determinant of $A = \begin{bmatrix} 1 & 0 & 0 & 0 \\ 3 & 5 & 0 & 0 \\ 2 & 1 & 2 & 0 \\ 8 & 7 & 3 & 1 \end{bmatrix}$

**<u>Examples</u>** Use the determinant theorems to find the following determinants.

a. $\begin{vmatrix} -4 & 1 & 4 \\ 2 & 0 & 1 \\ 0 & 2 & 4 \end{vmatrix}$

b. $\begin{vmatrix} 1 & 0 & 8 \\ 4 & 0 & 2 \\ 0 & 0 & 8 \end{vmatrix}$



Copyright 2022, Jennifer Hill, DivideandConquerMath.com

**Lesson: Ellipses as Conic Sections**

Give the geometric definition of an ellipse. Draw an illustration to accompany this.



Copyright 2022, Jennifer Hill, DivideandConquerMath.com

What are the standard forms of an ellipse? Describe the parts and draw VERY CLEAR illustrations.

What is important to note with this equation?



Copyright 2022, Jennifer Hill, DivideandConquerMath.com

**Example** Graph each ellipse. Give the domain, range, center, vertices, endpoints of the minor axis, and focus.

a. $\frac{x^2}{9} + \frac{y^2}{25} = 1$

b. $9x^2 + y^2 = 81$



Copyright 2022, Jennifer Hill, DivideandConquerMath.com

**<u>Example</u>** Graph each ellipse. Give the domain, range, center, vertices, endpoints of the minor axis, and focus.

c. $\frac{(x-1)^2}{9} + \frac{(y+2)^2}{4} = 1$



Copyright 2022, Jennifer Hill, DivideandConquerMath.com

**Lesson: Writing Equations of Ellipses**

**Example** Write the equation of an ellipse with the following characteristics.

a. major axis 6, focus at (0,2) and (0, -2)

b. center at (-2, 7), major axis vertical with length 10, and c=2



Copyright 2022, Jennifer Hill, DivideandConquerMath.com

**Lesson: Eccentricity with Ellipses**

To discuss the concept of eccentricity, we need to discuss what the formal mathematical definition of conic sections is.

Define a conic:

The intuitive idea behind eccentricity can change slightly with each conic section, but it is generally a ratio of different measures within the conic section.

What does the eccentricity of an ellipse tell us?

How do we represent eccentricity?

How do you calculate the eccentricity of an ellipse?



Copyright 2022, Jennifer Hill, DivideandConquerMath.com

How does the eccentricity of a parabola compare to the eccentricity of an ellipse? Summarize the explanation from the video.

**<u>Examples</u>** Find the eccentricity of each ellipse.

a. $\frac{x^2}{9} + \frac{y^2}{4} = 1$

b. $x^2 + 25y^2 = 25$



Copyright 2022, Jennifer Hill, DivideandConquerMath.com

**<u>Example</u>** Find the equation of an ellipse with $e = \frac{3}{4}$ with foci at $(-2,0), (2,0)$



Copyright 2022, Jennifer Hill, DivideandConquerMath.com

**Examples: Using Complete the Square to Write an Ellipse Equation in Standard Form**

Rewrite the following equations in standard form.

a. $x^2 + 12y^2 - 14x - 48y = -85$

b. $9x^2 + 36x + 16y^2 - 160y + 292 = 0$



Copyright 2022, Jennifer Hill, DivideandConquerMath.com

**Lesson: Hyperbolas as Conic Sections**

What is the geometric definition of a hyperbola? Draw an illustration with your definition.



Copyright 2022, Jennifer Hill, DivideandConquerMath.com

State the equations for the standard form of the hyperbola. Draw illustrations with it.



Copyright 2022, Jennifer Hill, DivideandConquerMath.com

**<u>Examples</u>** Graph each hyperbola. Give the domain, range, center, vertices, foci, and equations of the asymptotes.

a. $\frac{x^2}{9} - \frac{y^2}{16} = 1$

b. $9x^2 - 25y^2 = 225$



Copyright 2022, Jennifer Hill, DivideandConquerMath.com

**<u>Examples</u>** Graph each hyperbola. Give the domain, range, center, vertices, foci, and equations of the asymptotes.

c. $\frac{(y-1)^2}{9} - \frac{(x+3)^2}{4} = 1$



Copyright 2022, Jennifer Hill, DivideandConquerMath.com

**Lesson: Writing Equations of Hyperbolas**

**<u>Examples</u>** Write the equation of the hyperbola with the following characteristics.

a. vertices at (0, 6) and (0, -6) with asymptotes $y = \pm\frac{1}{2}x$

b. foci at $\left(-3\sqrt{5}, 0\right), (3\sqrt{5}, 0)$ with asymptotes $y = \pm 2x$



Copyright 2022, Jennifer Hill, DivideandConquerMath.com

**Examples** Write the equation of the hyperbola with the following characteristics.

c. center at (1, -2) and focus at (-2, -2) and vertex at (-1, -2)



Copyright 2022, Jennifer Hill, DivideandConquerMath.com

**Lesson: Eccentricity of Hyperbolas**

How do you calculate the eccentricity of a hyperbola?

What can we say about the eccentricity of the hyperbola? What does it mean?

**<u>Example</u>** Find the eccentricity of the hyperbolas.

a. $\frac{x^2}{36} - \frac{y^2}{9} = 1$

b. $8y^2 - 16x^2 = 16$



Copyright 2022, Jennifer Hill, DivideandConquerMath.com

**<u>Example</u>** Find the equation of a hyperbola with $e = \frac{25}{9}$ and foci at (9, -1) and (-11, -1)



Copyright 2022, Jennifer Hill, DivideandConquerMath.com

**Examples: Writing the Standard Form of a Hyperbola**

Write each hyperbola in standard form.

a. $x^2 - 6x - y^2 + 4y = 1$

b. $y^2 - 14y - x^2 + 14x = 16$



Copyright 2022, Jennifer Hill, DivideandConquerMath.com

**Lesson: An Intro to Conic Sections**

What are the 4 conic sections we will discuss? Draw an illustration with it.



Copyright 2022, Jennifer Hill, DivideandConquerMath.com

**Lesson: Parabolas as Conic Sections**

What is the previous equation we used for parabolas opening upwards or downwards? Draw a illustration to go with this.

How can we represent parabolas in similar notation for parabolas that open sideways?



Copyright 2022, Jennifer Hill, DivideandConquerMath.com

**<u>Examples</u>** Give the domain and range of the following parabolas, then graph the parabola.

a. $x + 1 = (y + 1)^2$

b. $-x = 3y^2 + 6y + 2$



Copyright 2022, Jennifer Hill, DivideandConquerMath.com

When dealing with conic sections, we shift how we think about things.

What is the geometric definition of a parabola? Draw an illustration to accompany this definition.

What equations do we use that align with the geometric definition?



Copyright 2022, Jennifer Hill, DivideandConquerMath.com

**Examples** Give the focus, directrix, vertex, and axis of symmetry for each parabola. Then use this information to graph the parabola.

a. $x^2 = 4y$

b. $(y-2)^2 = 24(x-3)$



Copyright 2022, Jennifer Hill, DivideandConquerMath.com

**Lesson: Writing Equations of Parabolas**

**<u>Example</u>** Write the equation of a parabola with the following characteristics.

a. focus $\left(0, -\frac{1}{2}\right)$ with the vertex at the origin

b. vertex (4, 3) and focus is (4, 5)

c. vertex (1, 2), directrix x=4



Copyright 2022, Jennifer Hill, DivideandConquerMath.com

**Lesson: Sequences**

Define a sequence.

**<u>Examples</u>** Write the first five terms of each sequence.

a. $a_n = \frac{1}{n}$

b. $a_n = \frac{n\mp 1}{n+3}$

c. $a_n = (-1)^{n+1} * (2n + 1)$



Copyright 2022, Jennifer Hill, DivideandConquerMath.com

What does it mean for a sequence to converge?

What does it mean for a sequence to diverge?

What is a recursively defined sequence?



Copyright 2022, Jennifer Hill, DivideandConquerMath.com

**Examples** Find the first four terms in the sequence.

a. $a_1 = 3; a_n = 2a_{n-1} - 4$

b. $a_1 = 2; a_n = a_{n-1}^2 + n - 2$



Copyright 2022, Jennifer Hill, DivideandConquerMath.com

**Lesson: Series**

What is the summation sign and what does it mean? What do we called the “i” in this formula?

Define a finite series.

Define an infinite series.



Copyright 2022, Jennifer Hill, DivideandConquerMath.com

**<u>Examples</u>** Evaluate the following sums.

a. $\Sigma_{i=1}^{4}\left(3^i + 1\right)$

b. $\Sigma_{j=3}^{6} a_j$

c. $\Sigma_{k=1}^{4}(4x_k - 1)$ if $x_1 = 2, x_2 = 3, x_3 = 5, x_4 = 8$

d. $\Sigma_{i=1}^{3} f(x_i)\Delta x$, if $f(x) = 3x, x_1 = 1, x_2 = 4, x_3 = 7, \Delta x = 3$



Copyright 2022, Jennifer Hill, DivideandConquerMath.com

What are the summation properties?

What are the summation rules for summing up terms?



Copyright 2022, Jennifer Hill, DivideandConquerMath.com

**Examples** Use the summation properties and rules to evaluate each series.

a. $\Sigma_{i=1}^{50} 3$

b. $\Sigma_{k=1}^{25} 3k$

c. $\Sigma_{j=1}^{33} (4j^2 + 1)$



Copyright 2022, Jennifer Hill, DivideandConquerMath.com

**Lesson: Arithmetic Sequences**

What is an arithmetic sequence?

Give some examples of an arithmetic sequence.

**<u>Example</u>** Determine the common difference, d, for the arithmetic sequence:

$$-7, -5, -3, -1, \ldots$$



Copyright 2022, Jennifer Hill, DivideandConquerMath.com

**Example** Find the first five terms of each arithmetic sequence.

a. The first term is 3, and the common difference is -2.

b. $a_1 = -5, d = 7$

How do we define the general nth term of an arithmetic sequence?



Copyright 2022, Jennifer Hill, DivideandConquerMath.com

**Example** Determine $a_{11}$ and $a_n$ for the arithmetic sequence $-2, 2, 6, 10, \ldots$

**Example** Determine $a_n$ and $a_{20}$ for the arithmetic sequence having $a_3 = 9$, and $a_4 = 16$.

**Example** An arithmetic sequence has $a_7 = -15$ and $a_{14} = -35$. Determine $a_1$.



Copyright 2022, Jennifer Hill, DivideandConquerMath.com

**Lesson: Arithmetic Series**

When we sum up the terms of an arithmetic sequence, how can we define that sum? (sum of an arithmetic sequence)

**<u>Example</u>** Consider the arithmetic sequence $-7, -3, 1, 5, \ldots$

a. Evaluate $S_{10}$

b. Evaluate the sum of the first 50 positive integers.



Copyright 2022, Jennifer Hill, DivideandConquerMath.com

**Example** The sum of the first 15 terms of an arithmetic sequence is 345. If $a_{15} = 65$, find $a_1$ and d.

**Examples** Evaluate each sum.

a. $\Sigma_{i=1}^{19}(-3 - 5i)$

b. $\Sigma_{k=4}^{15}(2 + 4k)$



Copyright 2022, Jennifer Hill, DivideandConquerMath.com

**Lesson: Geometric Sequences and Series**

Define a geometric sequence:

**<u>Example</u>** Determine $a_6$ and $a_n$ for the geometric sequence 4, 12, 36, 108, ….

**<u>Example</u>** Determine r and $a_1$ for the geometric sequence with $a_2 = -18$ and $a_5 = 486$



Copyright 2022, Jennifer Hill, DivideandConquerMath.com

How do we define the sum of the first n terms of a geometric sequence?

**<u>Example</u>** Evaluate: $\Sigma_{i=1}^{8} 3 * 2^i$

If we start with 2 and use a common ratio of $\frac{1}{2}$, what eventually happens as the series continues infinitely? Summarize the explanation below.



Copyright 2022, Jennifer Hill, DivideandConquerMath.com

**Examples** Evaluate the following infinite sums.

a. The first term is 1 and the common ratio is $\frac{1}{3}$

b. $\Sigma_{i=1}^{\infty}\left(-\frac{1}{2}\right)\left(-\frac{3}{4}\right)^{i-1}$

c. $\Sigma_{i=1}^{\infty}\left(\frac{3}{7}\right)^{i}$



Copyright 2022, Jennifer Hill, DivideandConquerMath.com

**Lesson: The Binomial Theorem**

Below we can observe the pattern for binomial expansion:

$(x+y)^0 = 1$

$(x+y)^1 = x+y$

$(x+y)^2 = x^2 + 2xy + y^2$

$(x+y)^3 = x^3 + 3x^2y + 3xy^2 + y^3$

$(x+y)^4 = x^4 + 4x^3y + 6x^2y^2 + 4xy^3 + y^4$

$(x+y)^5 = x^5 + 5x^4y + 10x^3y^2 + 10x^2y^3 + 5xy^4 + y^5$

Focusing on the VARIABLES x and y only, how can we generalize the exponents for the variables?

Pascal's Triangle can explain how to find the coefficient. Draw out Pascal's triangle below.



Copyright 2022, Jennifer Hill, DivideandConquerMath.com

Having to draw out this pattern would be very difficult for larger expansions, so we will explore a few ways to simplify how to expand this pattern.

First, we need to understand factorials.

**n-factorial:** for any positive integer n,

$$n! = n(n-1)(n-2)\dots(3)(2)(1)$$

By definition: $0! = 1$

**<u>Examples</u>** Evaluate:

a. $5!$

b. $8!$

Now that we understand factorials, we can discuss the formula to find binomial coefficients.

For nonnegative integers $n$ and $r$, $r \leq n$, the binomial coefficient is defined as follows:

**<u>Examples</u>** Evaluate each binomial coefficient:

a. $\binom{5}{2}$

b. $\binom{6}{0}$



Copyright 2022, Jennifer Hill, DivideandConquerMath.com

We can summarize how to expand $(x+y)^n$ as follows:

1. There are n+1 terms in the expansion

2. The first and last terms are $x^n$ and $y^n$ respectively

3. In each succeeding term, the exponent on x decreases by 1 and the exponent on y increase by 1

4. The sum of the exponents on x and y in any term is n.

5. The coefficient of the term with $x^r y^{n-r}$ or $x^{n-r} y^r$ is $\binom{n}{r}$

These observations are captured in the binomial theorem.

State **The Binomial Theorem:**

**<u>Example</u>** Find the first, last, and seventh term of the binomial expansion: $(3x+2y)^{10}$



Copyright 2022, Jennifer Hill, DivideandConquerMath.com

**<u>Example</u>** Use the binomial theorem to expand: $(a-b)^5$



Copyright 2022, Jennifer Hill, DivideandConquerMath.com

## Not included (no notes file):

004 (Examples of the Greatest Common Factor)

005 (Examples of Factoring Basic Trinomials via Trial and Error)

006 (Examples of Grouping)

007 (Examples of the Sum and Difference of Cubes)

008 (Examples of Factoring Harder Trinomials)

013 (Examples of Simplifying Rational Expressions)

014 (Examples of How to Use the Multiplicative Property of -1 to Simplify Rational Expressions)

015 (Examples of Finding Domains of Rational Expressions)

018 (Examples of Multiplying and Dividing Rational Expressions)

022 (Examples of Finding Common Denominators for Rational Expressions)

037 (Examples of Solving Absolute Value Equations)

042 (Examples on Absolute Value Inequalities)

878 (Examples: Putting Everything Together and Another Explanation of Special Cases, Slower-Paced)